Finding Value with Place Value Block Name:

Count the total number of small blocks.

1) 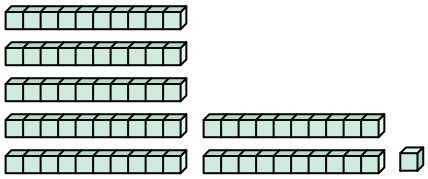

2) 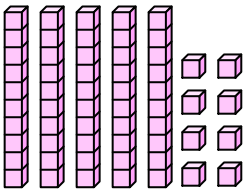

3) 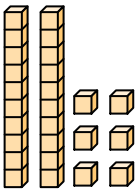

4) 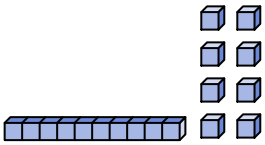

5) 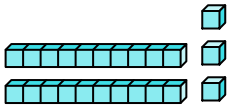

6) 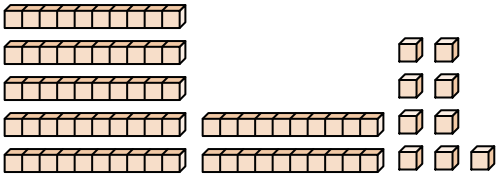

7) 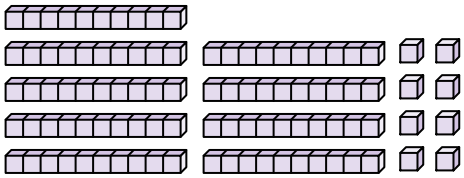

8) 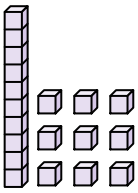

9) 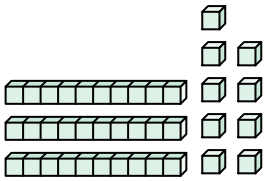

10) 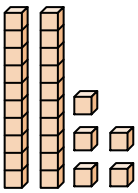

11) 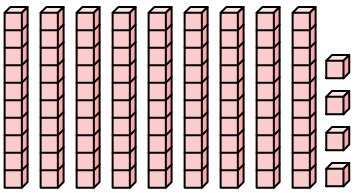

12) 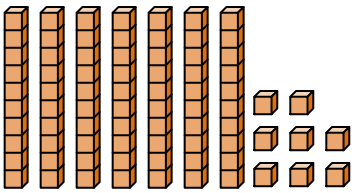

Answers

1. _____
2. _____
3. _____
4. _____
5. _____
6. _____
7. _____
8. _____
9. _____
10. _____
11. _____
12. _____

1-10	92	83	75	67	58	50	42	33	25	17
11-12	8	0								

Finding Value with Place Value Block

Name: **Answer Key**

Count the total number of small blocks.

1) 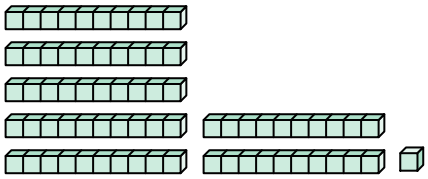

2) 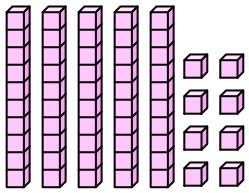

3) 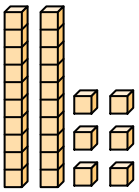

4) 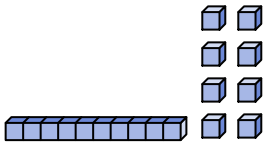

5) 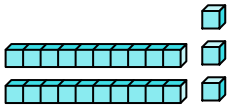

6) 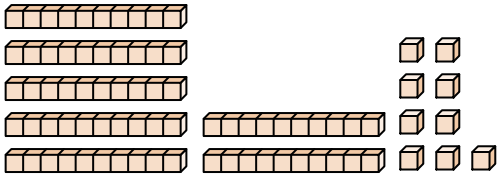

7) 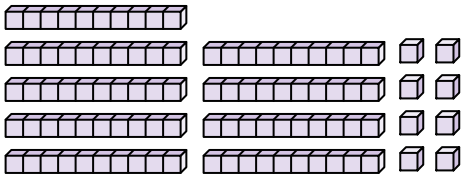

8) 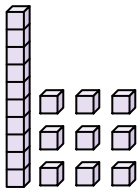

9) 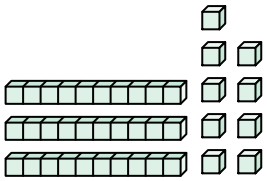

10) 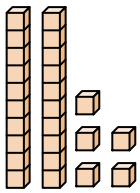

11) 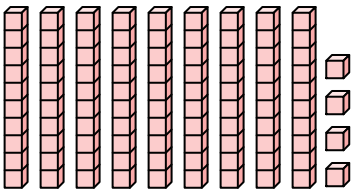

12) 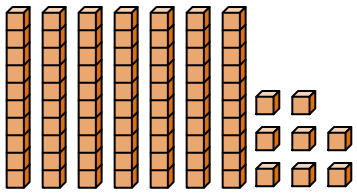

Answers

1. 71
2. 58
3. 26
4. 18
5. 23
6. 79
7. 98
8. 19
9. 39
10. 25
11. 94
12. 78

1-10	92	83	75	67	58	50	42	33	25	17
11-12	8	0								

Finding Value with Place Value Block Name:

Count the total number of small blocks.

19	26	79	58	23
98	39	25	71	18

1)

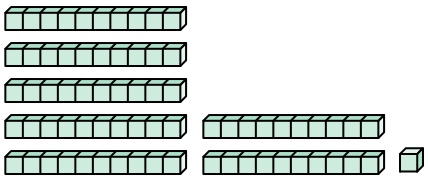

2)

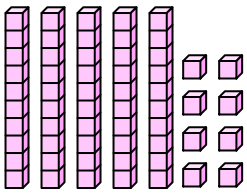

3)

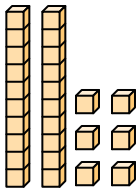

4)

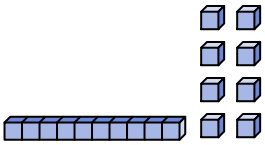

5)

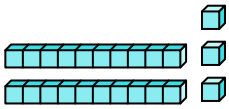

6)

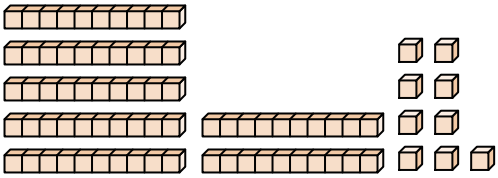

7)

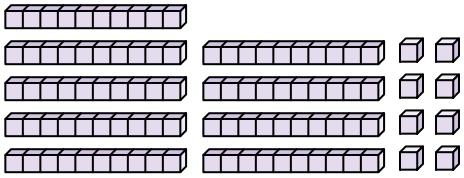

8)

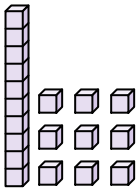

9)

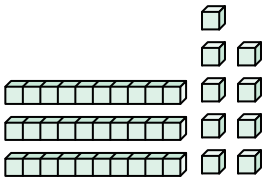

10)

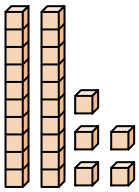

Answers

1. _____
2. _____
3. _____
4. _____
5. _____
6. _____
7. _____
8. _____
9. _____
10. _____