Reading An Analog Clock

Name:

**Determine the time shown on the clock.**

1) 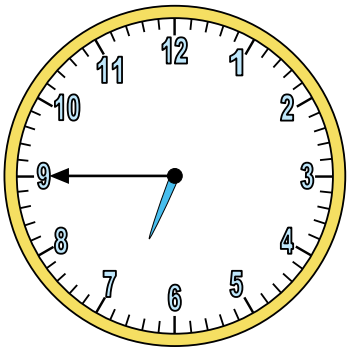

2) 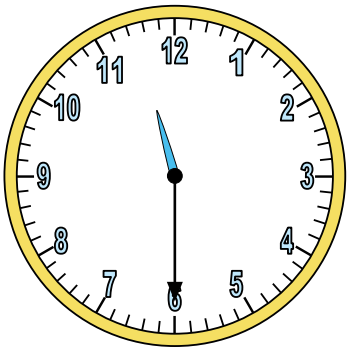

3) 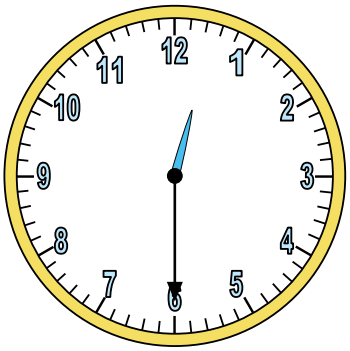

4) 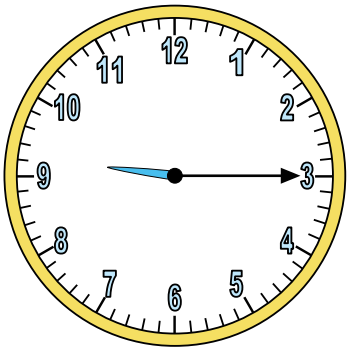

5) 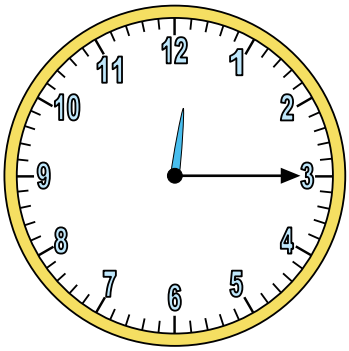

6) 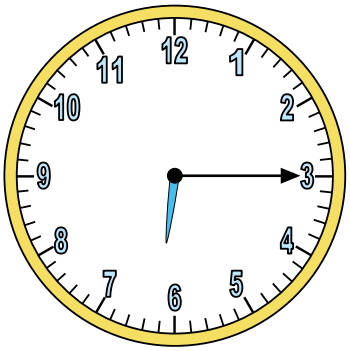

7) 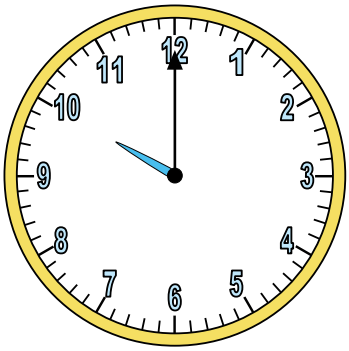

8) 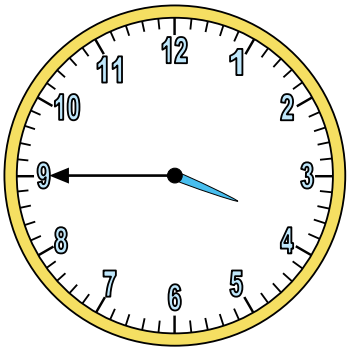

9) 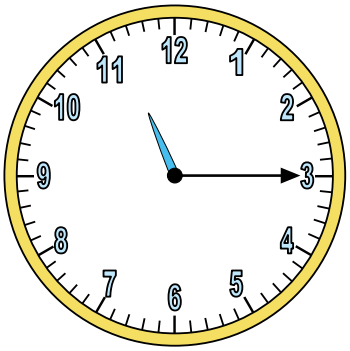

10) 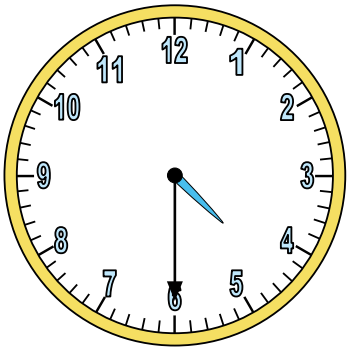

11) 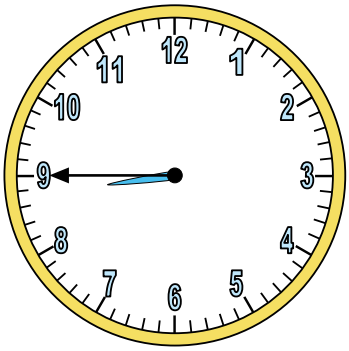

12) 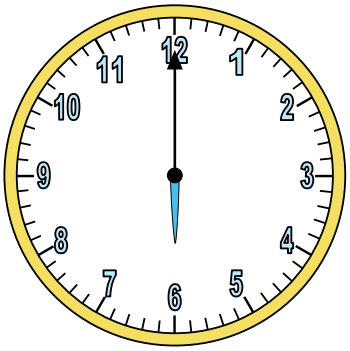

**Answers**

1. _____
2. _____
3. _____
4. _____
5. _____
6. _____
7. _____
8. _____
9. _____
10. _____
11. _____
12. _____



| | | | | | | | | | | |
|---|---|---|---|---|---|---|---|---|---|---|
| 1-10 | 92 | 83 | 75 | 67 | 58 | 50 | 42 | 33 | 25 | 17 |
| 11-12 | 8 | 0 | | | | | | | | |

Reading An Analog Clock

Name: **Answer Key**

**Determine the time shown on the clock.**

1) 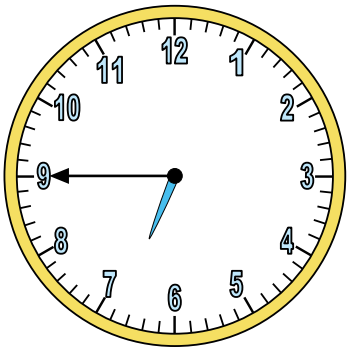

2) 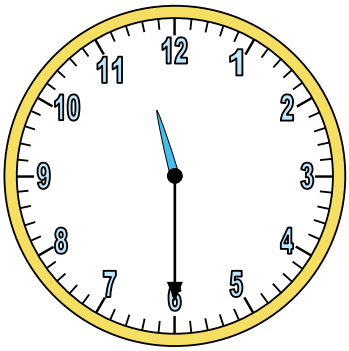

3) 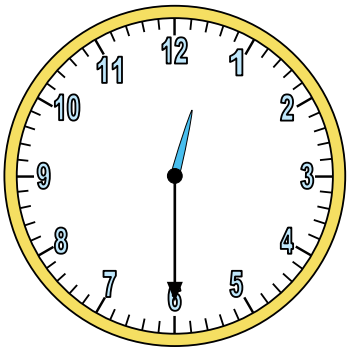

4) 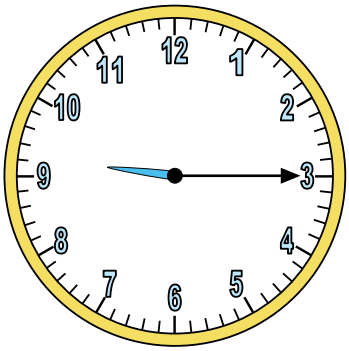

5) 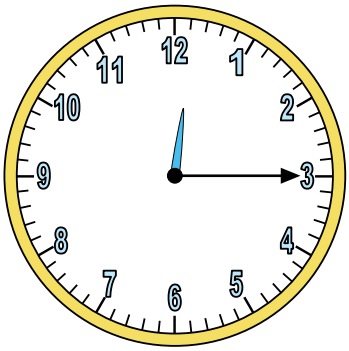

6) 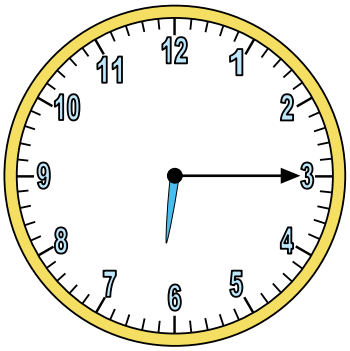

7) 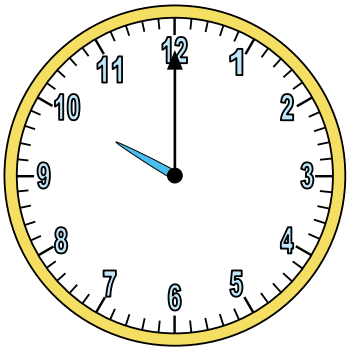

8) 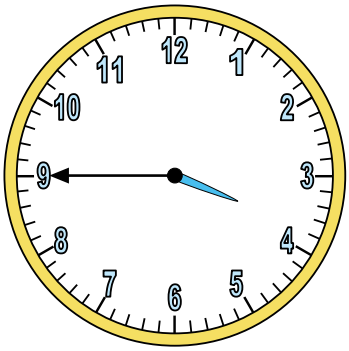

9) 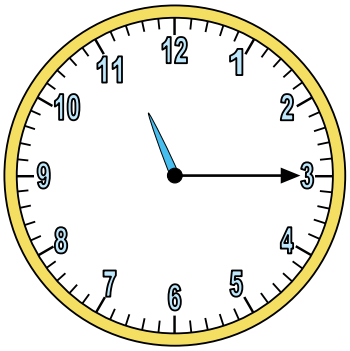

10) 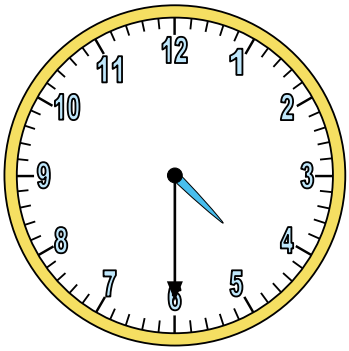

11) 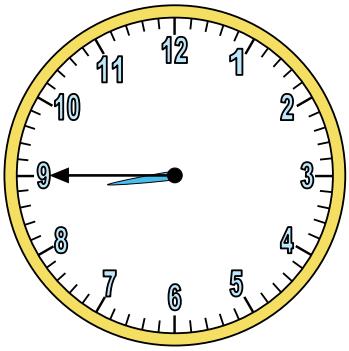

12) 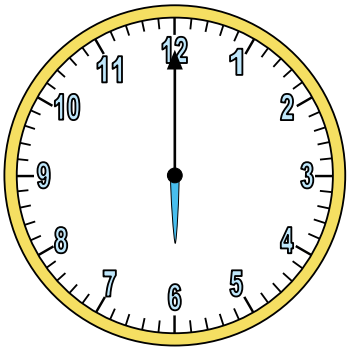

**Answers**

1. 6:45
2. 11:30
3. 12:30
4. 9:15
5. 12:15
6. 6:15
7. 10:00
8. 3:45
9. 11:15
10. 4:30
11. 8:45
12. 6:00



| | | | | | | | | | | |
|---|---|---|---|---|---|---|---|---|---|---|
| 1-10 | 92 | 83 | 75 | 67 | 58 | 50 | 42 | 33 | 25 | 17 |
| 11-12 | 8 | 0 | | | | | | | | |