Finding Ending Time with a Numberline

Name:

Solve each problem.

1) Start: 2:15
Elapsed: 1 hr & 40 mins
End: _____

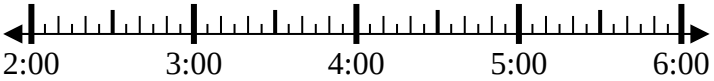

2) Start: 2:10
Elapsed: 2 hrs & 45 mins
End: _____

3) Start: 2:45
Elapsed: 2 hrs & 10 mins
End: _____

4) Start: 2:20
Elapsed: 1 hr & 20 mins
End: _____

5) Start: 11:05
Elapsed: 2 hrs & 25 mins
End: _____

6) Start: 11:05
Elapsed: 2 hrs & 20 mins
End: _____

7) Start: 3:45
Elapsed: 2 hrs & 20 mins
End: _____

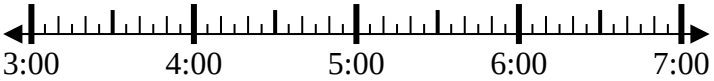

8) Start: 6:20
Elapsed: 1 hr & 30 mins
End: _____

Answers

1. _____
2. _____
3. _____
4. _____
5. _____
6. _____
7. _____
8. _____

1-8	88	75	63	50	38	25	13	0

Finding Ending Time with a Numberline

Name: **Answer Key**

Solve each problem.

1) Start: 2:15
Elapsed: 1 hr & 40 mins
End: 3:55

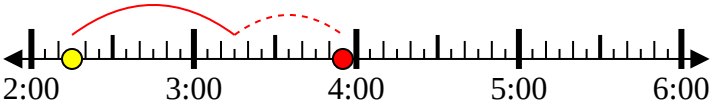

2) Start: 2:10
Elapsed: 2 hrs & 45 mins
End: 4:55

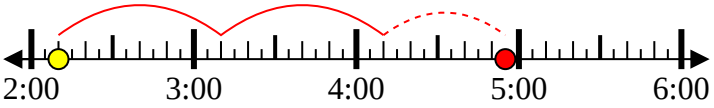

3) Start: 2:45
Elapsed: 2 hrs & 10 mins
End: 4:55

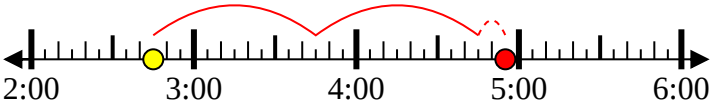

4) Start: 2:20
Elapsed: 1 hr & 20 mins
End: 3:40

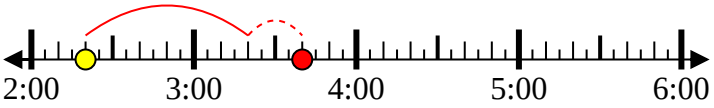

5) Start: 11:05
Elapsed: 2 hrs & 25 mins
End: 1:30

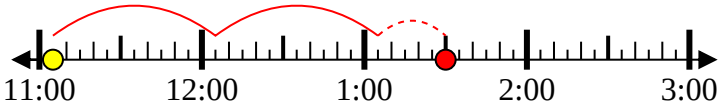

6) Start: 11:05
Elapsed: 2 hrs & 20 mins
End: 1:25

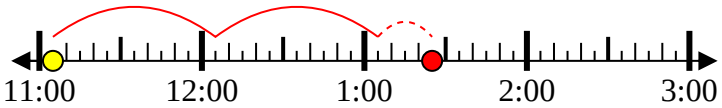

7) Start: 3:45
Elapsed: 2 hrs & 20 mins
End: 6:05

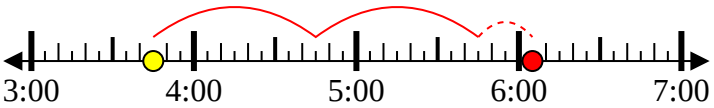

8) Start: 6:20
Elapsed: 1 hr & 30 mins
End: 7:50

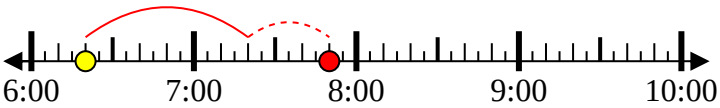

Answers

1. 3:55
2. 4:55
3. 4:55
4. 3:40
5. 1:30
6. 1:25
7. 6:05
8. 7:50

1-8	88	75	63	50	38	25	13	0