Identifying Quadrilaterals

Name:

**Determine if the shape shown is a quadrilateral (yes) or not (no).**

**1)** 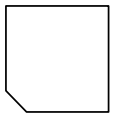

**2)**

**3)** 

**4)** 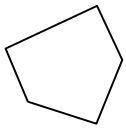

**5)**

**6)**

**7)**

**8)** 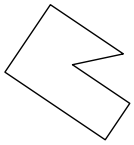

**9)**

**10)** 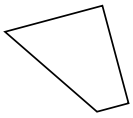

**11)** 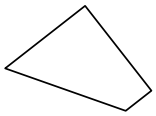

**12)** 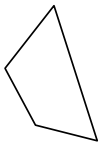

**13)** 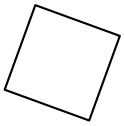

**14)**

**15)** 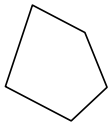

**16)** 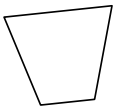

**17)** 

**18)** 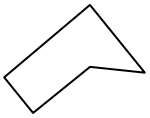

**19)** 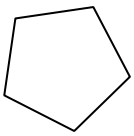

**20)** 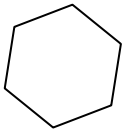

**Answers**

1. _____
2. _____
3. _____
4. _____
5. _____
6. _____
7. _____
8. _____
9. _____
10. _____
11. _____
12. _____
13. _____
14. _____
15. _____
16. _____
17. _____
18. _____
19. _____
20. _____



| | | | | | | | | | | |
|---|---|---|---|---|---|---|---|---|---|---|
| 1-10 | 95 | 90 | 85 | 80 | 75 | 70 | 65 | 60 | 55 | 50 |
| 11-20 | 45 | 40 | 35 | 30 | 25 | 20 | 15 | 10 | 5 | 0 |

Identifying Quadrilaterals

Name: **Answer Key**

**Determine if the shape shown is a quadrilateral (yes) or not (no).**

**1)** 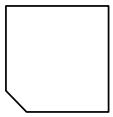

**2)**

**3)** 

**4)** 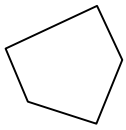

**5)**

**6)**

**7)**

**8)** 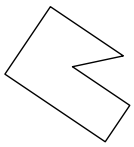

**9)**

**10)** 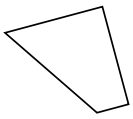

**11)** 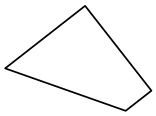

**12)** 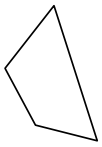

**13)** 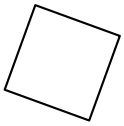

**14)**

**15)** 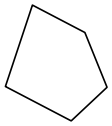

**16)** 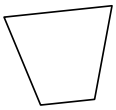

**17)** 

**18)** 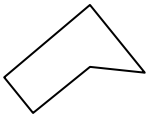

**19)** 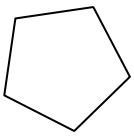

**20)** 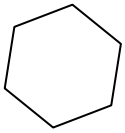

**Answers**

1. no
2. no
3. yes
4. no
5. yes
6. no
7. yes
8. no
9. yes
10. yes
11. yes
12. yes
13. yes
14. no
15. no
16. yes
17. yes
18. no
19. no
20. no



| | | | | | | | | | | |
|---|---|---|---|---|---|---|---|---|---|---|
| 1-10 | 95 | 90 | 85 | 80 | 75 | 70 | 65 | 60 | 55 | 50 |
| 11-20 | 45 | 40 | 35 | 30 | 25 | 20 | 15 | 10 | 5 | 0 |