Rounding to Ten (with Numberlines) Name:

Use the numberlines to round each number to the nearest 10.

Ex) 26

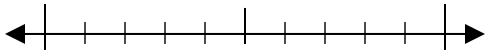

1) 99

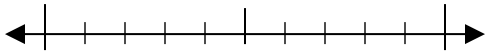

2) 50

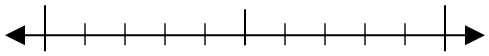

3) 94

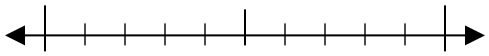

4) 481

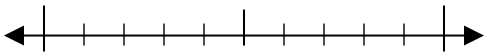

5) 461

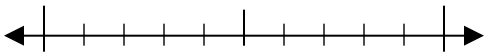

6) 576

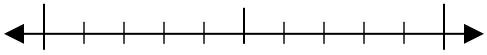

7) 598

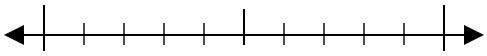

8) 1,791

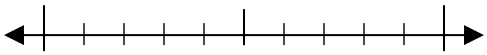

9) 4,128

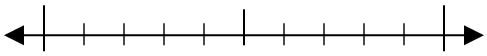

Answers

Ex. 30

1. _____
2. _____
3. _____
4. _____
5. _____
6. _____
7. _____
8. _____
9. _____

1-9	89	78	67	56	44	33	22	11	0

Rounding to Ten (with Numberlines) Name: **Answer Key**

Use the numberlines to round each number to the nearest 10.

Ex)

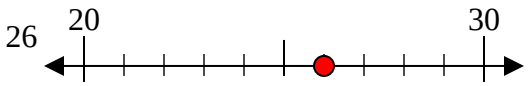

1)

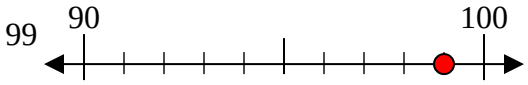

2)

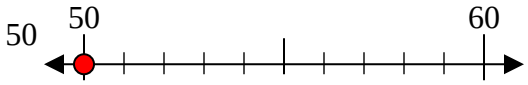

3)

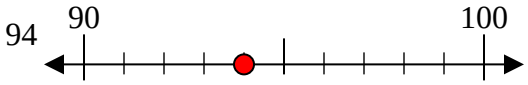

4)

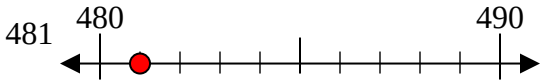

5)

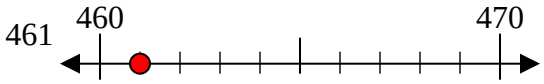

6)

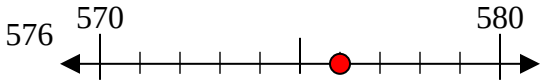

7)

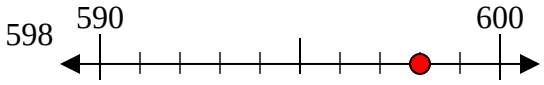

8)

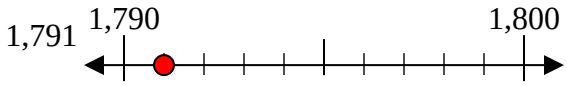

9)

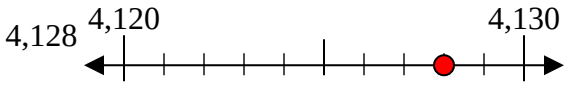

Answers

Ex.	30
1.	100
2.	50
3.	90
4.	480
5.	460
6.	580
7.	600
8.	1790
9.	4130

1-9	89	78	67	56	44	33	22	11	0