Function Machines (Add & Subtract) Name:

Determine the rule each function machine is using.

Ex)

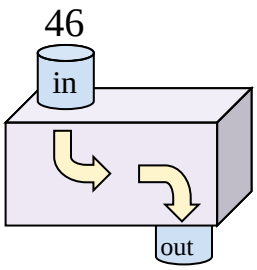

Subtract 24

1)

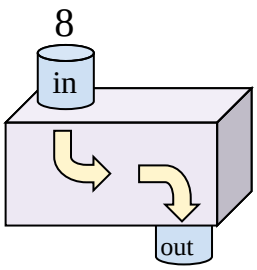

2)

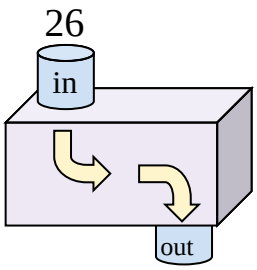

3)

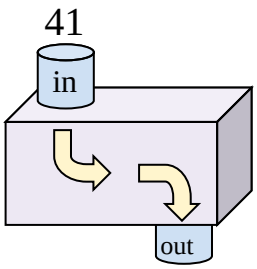

4)

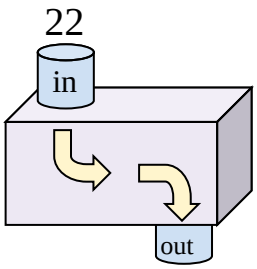

5)

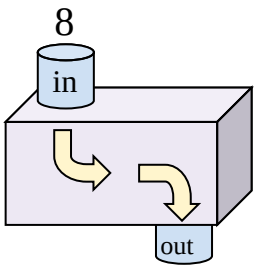

6)

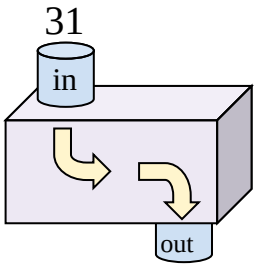

7)

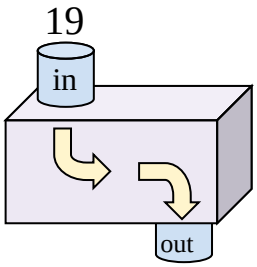

8)

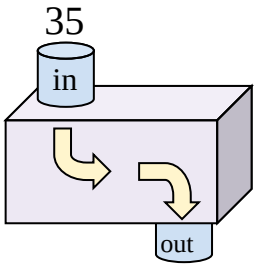

9)

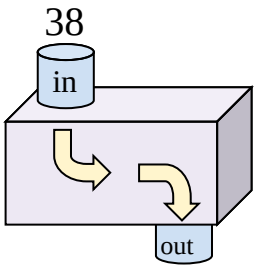

10)

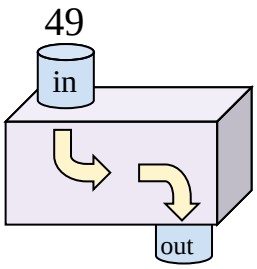

11)

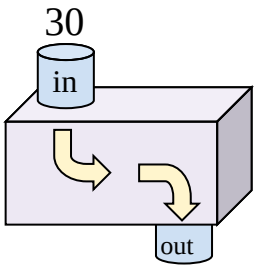

Answers

Ex. Subtract 24

1. _____
2. _____
3. _____
4. _____
5. _____
6. _____
7. _____
8. _____
9. _____
10. _____
11. _____

Function Machines (Add & Subtract) Name: **Answer Key**

Determine the rule each function machine is using.

Ex)

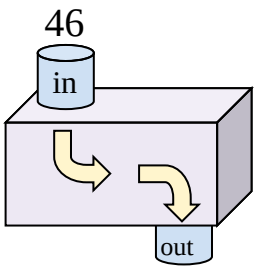

Subtract 24

1)

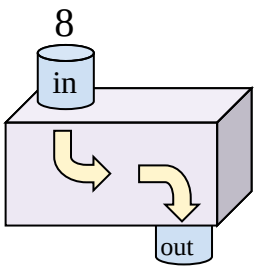

Add 36

2)

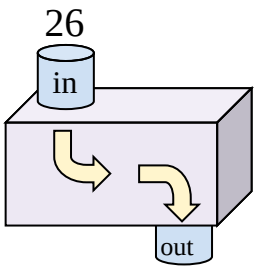

Add 10

3)

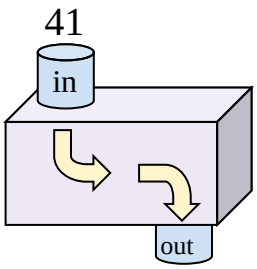

Subtract 28

4)

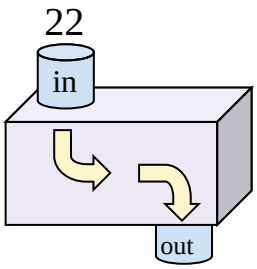

Add 26

5)

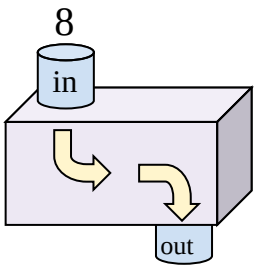

Add 11

6)

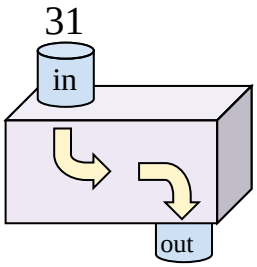

Subtract 14

7)

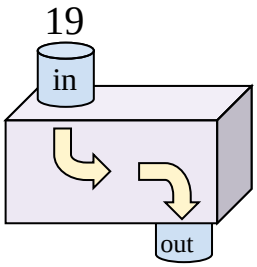

Add 31

8)

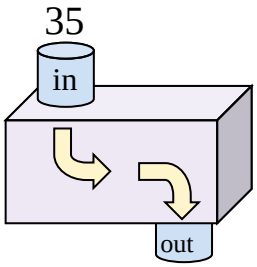

Subtract 14

9)

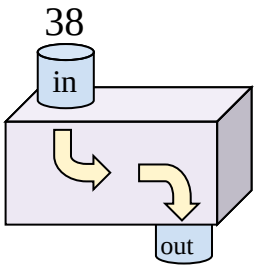

Subtract 23

10)

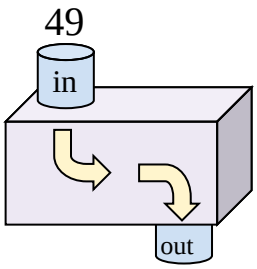

Subtract 43

11)

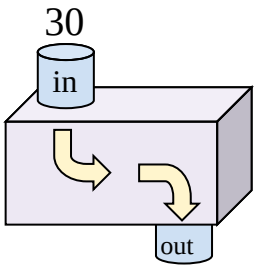

Add 16

Answers

Ex.	Subtract 24
1.	Add 36
2.	Add 10
3.	Subtract 28
4.	Add 26
5.	Add 11
6.	Subtract 14
7.	Add 31
8.	Subtract 14
9.	Subtract 23
10.	Subtract 43
11.	Add 16