Rewriting Multiplication Problems (visual)

Name:

Write each array as a multiplication problem and solve.

Ex) 

1) 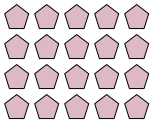

2) 

3) 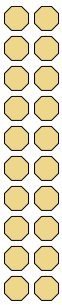

4) 

5) 

6)

7) 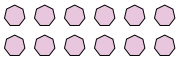

8)

9)

10) 

11) 

Answers

Ex. 7 × 4 = 28

1. _____
2. _____
3. _____
4. _____
5. _____
6. _____
7. _____
8. _____
9. _____
10. _____
11. _____

Rewriting Multiplication Problems (visual) Name: **Answer Key**

Write each array as a multiplication problem and solve.

Ex) 

1) 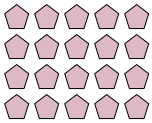

2) 

3) 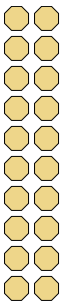

4) 

5) 

6)

7) 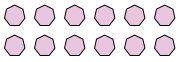

8)

9)

10) 

11) 

Answers

Ex. 7 × 4 = 28

1. 4 × 5 = 20

2. 6 × 9 = 54

3. 10 × 2 = 20

4. 10 × 5 = 50

5. 9 × 5 = 45

6. 2 × 8 = 16

7. 2 × 6 = 12

8. 2 × 5 = 10

9. 2 × 3 = 6

10. 7 × 7 = 49

11. 8 × 6 = 48

1-10	91	82	73	64	55	45	36	27	18	9
11	0									