Rectangular Arrays Name:

Write an equation to express the array and then find the number of shapes.

Ex) 

1) 

2) 

3)

4) 

5) 

6)

7) 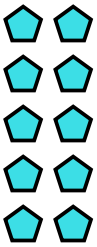

8) 

9) 

10) 

11)

12)

13)

14) 

Answers

Ex. 4 × 4 = 16

1. _____
2. _____
3. _____
4. _____
5. _____
6. _____
7. _____
8. _____
9. _____
10. _____
11. _____
12. _____
13. _____
14. _____

1-10	93	86	79	71	64	57	50	43	36	29
11-14	21	14	7	0						

Rectangular Arrays

Name: **Answer Key**

Write an equation to express the array and then find the number of shapes.

Ex) 

1) 

2) 

3)

4) 

5) 

6)

7) 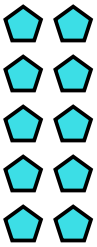

8) 

9) 

10) 

11)

12)

13)

14) 

Answers

Ex.	4 × 4 = 16
1.	5 × 4 = 20
2.	4 × 5 = 20
3.	2 × 3 = 6
4.	4 × 3 = 12
5.	5 × 5 = 25
6.	3 × 5 = 15
7.	5 × 2 = 10
8.	2 × 5 = 10
9.	3 × 3 = 9
10.	3 × 4 = 12
11.	4 × 2 = 8
12.	2 × 2 = 4
13.	3 × 2 = 6
14.	2 × 4 = 8

1-10	93	86	79	71	64	57	50	43	36	29
11-14	21	14	7	0						