Estimating Distance (Metric) Name:

Determine which letter best represents the length / height.

Millimeter (mm)	Centimeter (cm)	Meter (m)	Kilometer (km)
A millimeter is about the thickness of a credit card.	10 mm = 1 cm. The metal portion of a pencil is about 1 cm. A ruler is about 30 centimeters.	100 cm = 1 m From the floor to a door knob is about 1 meter.	1,000 m = 1 km Most major roads are at least a kilometer long.

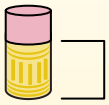
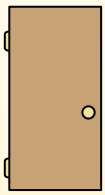

1)



Cooking Pot
A. 10 centimeters
B. 3 centimeters
C. 60 centimeters
D. 25 centimeters

2)



Hammer
A. 3 centimeters
B. 40 centimeters
C. 10 centimeters
D. 1 meter

3)

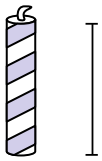

Candle
A. 20 centimeters
B. 30 centimeters
C. 5 centimeters
D. 2 kilometers

4)

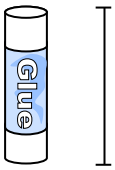

Glue Stick
A. 30 centimeters
B. 6 kilometers
C. 25 centimeters
D. 10 centimeters

5)

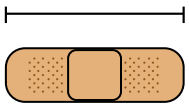

Bandage
A. 60 centimeters
B. 3 kilometers
C. 9 centimeters
D. 1 meter

6)

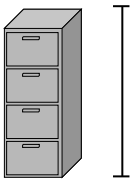

FileCabinet
A. 1.5 millimeters
B. 30 millimeters
C. 60 centimeters
D. 30 centimeters

7)

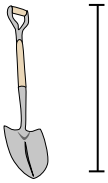

Shovel
A. 60 centimeters
B. 1 meter
C. 30 centimeters
D. 3 meters

8)



Tree Height
A. 2 kilometers
B. 100 centimeters
C. 5 meters
D. 30 centimeters

9)

Flash Drive
A. 60 centimeters
B. 30 centimeters
C. 15 centimeters
D. 6 centimeters

Answers

1. _____
2. _____
3. _____
4. _____
5. _____
6. _____
7. _____
8. _____
9. _____

1-9	89	78	67	56	44	33	22	11	0

Estimating Distance (Metric) Name: **Answer Key**

Determine which letter best represents the length / height.

Millimeter (mm)	Centimeter (cm)	Meter (m)	Kilometer (km)
A millimeter is about the thickness of a credit card.	10 mm = 1 cm. The metal portion of a pencil is about 1 cm. A ruler is about 30 centimeters.	100 cm = 1 m From the floor to a door knob is about 1 meter.	1,000 m = 1 km Most major roads are at least a kilometer long.

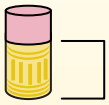
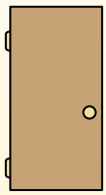

1)



Cooking Pot
A. 10 centimeters
B. 3 centimeters
C. 60 centimeters
D. 25 centimeters

2)



Hammer
A. 3 centimeters
B. 40 centimeters
C. 10 centimeters
D. 1 meter

3)

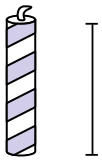

Candle
A. 20 centimeters
B. 30 centimeters
C. 5 centimeters
D. 2 kilometers

4)

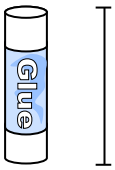

Glue Stick
A. 30 centimeters
B. 6 kilometers
C. 25 centimeters
D. 10 centimeters

5)

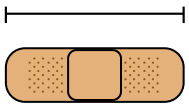

Bandage
A. 60 centimeters
B. 3 kilometers
C. 9 centimeters
D. 1 meter

6)

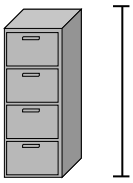

FileCabinet
A. 1.5 millimeters
B. 30 millimeters
C. 60 centimeters
D. 30 centimeters

7)

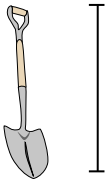

Shovel
A. 60 centimeters
B. 1 meter
C. 30 centimeters
D. 3 meters

8)



Tree Height
A. 2 kilometers
B. 100 centimeters
C. 5 meters
D. 30 centimeters

9)

Flash Drive
A. 60 centimeters
B. 30 centimeters
C. 15 centimeters
D. 6 centimeters

Answers

1. D
2. B
3. C
4. D
5. C
6. A
7. B
8. C
9. D

1-9	89	78	67	56	44	33	22	11	0