Comparing Two Measurements

Name:

Measure the width of each block in inches and in centimeters.

Ex)

1)

2)



3)

4)

5)

6)

7)



8)

9)

Answers

Ex.	3	7 - 8
1.		
2.		
3.		
4.		
5.		
6.		
7.		
8.		
9.		

1-9	89	78	67	56	44	33	22	11	0

Comparing Two Measurements

Name: **Answer Key**

Measure the width of each block in inches and in centimeters.

Ex)

1)

2)



3)

4)

5)

6)

7)



8)

9)

Answers

Ex.	3	7 - 8
1.	$1\frac{1}{2}$	3 - 4
2.	$0\frac{1}{2}$	1 - 2
3.	$5\frac{1}{2}$	13 - 14
4.	1	2 - 3
5.	$4\frac{1}{2}$	11 - 12
6.	4	10 - 11
7.	5	12 - 13
8.	2	5 - 6
9.	$2\frac{1}{2}$	6 - 7