Determine which fraction goes in the middle to make the comparison true.

1) $^{3}/_{8}$ < ? < $^{3}/_{4}$

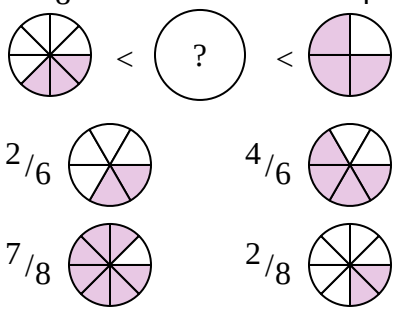

2) $^{2}/_{8}$ < ? < $^{4}/_{8}$

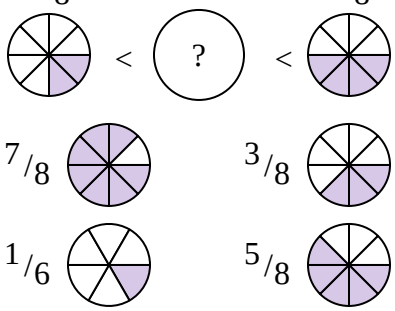

3) $^{1}/_{6}$ < ? < $^{3}/_{6}$

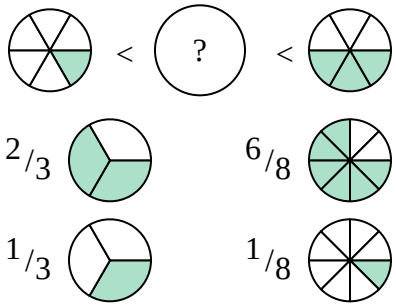

4) $^{2}/_{8}$ < ? < $^{3}/_{8}$

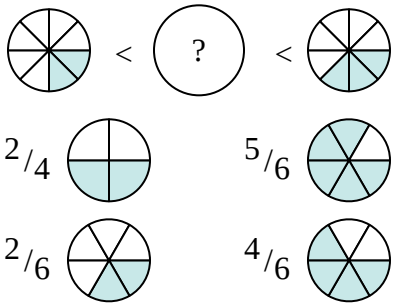

5) $^{3}/_{8}$ < ? < $^{6}/_{8}$

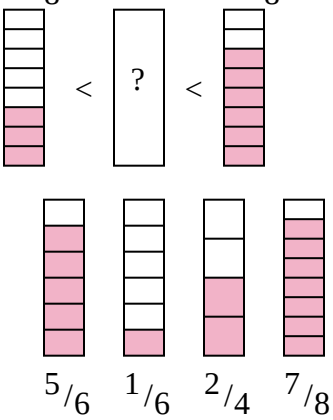

6) $^{2}/_{8}$ < ? < $^{3}/_{8}$

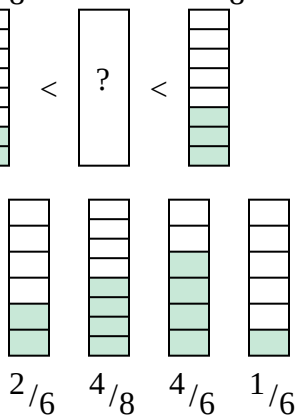

7) $^{1}/_{3}$ < ? < $^{5}/_{8}$

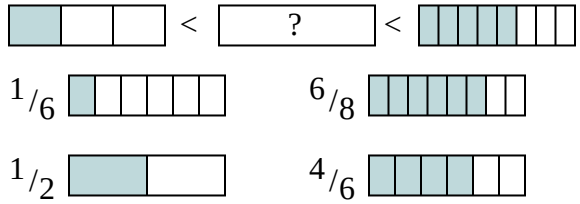

8) $^{3}/_{8}$ < ? < $^{2}/_{3}$

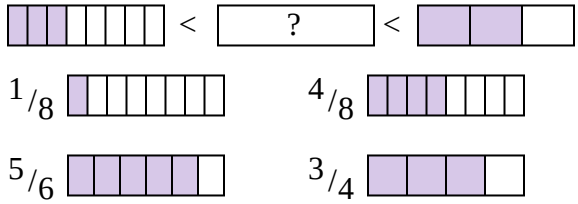

Answers

1. _____
2. _____
3. _____
4. _____
5. _____
6. _____
7. _____
8. _____

1-8	88	75	63	50	38	25	13	0

Comparing Fractions Name: **Answer Key**

Determine which fraction goes in the middle to make the comparison true.

1) $^{3}/_{8}$ < ? < $^{3}/_{4}$

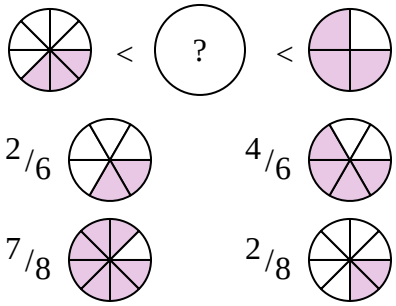

2) $^{2}/_{8}$ < ? < $^{4}/_{8}$

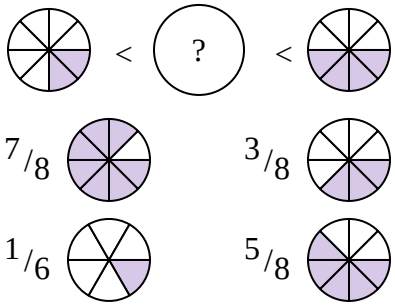

3) $^{1}/_{6}$ < ? < $^{3}/_{6}$

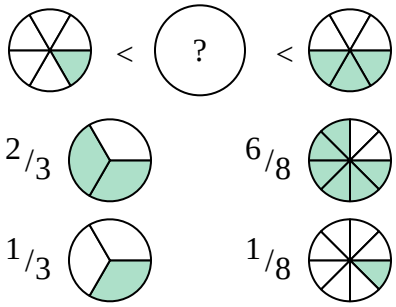

4) $^{2}/_{8}$ < ? < $^{3}/_{8}$

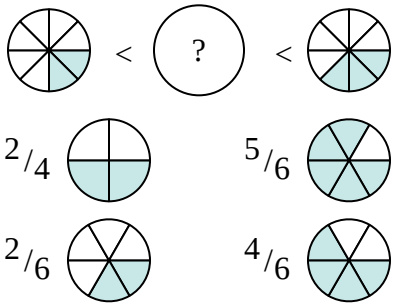

5) $^{3}/_{8}$ < ? < $^{6}/_{8}$

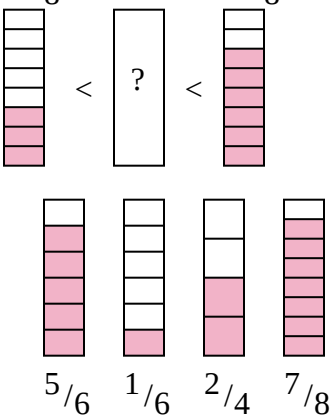

6) $^{2}/_{8}$ < ? < $^{3}/_{8}$

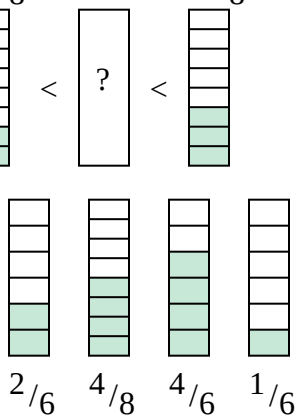

7) $^{1}/_{3}$ < ? < $^{5}/_{8}$

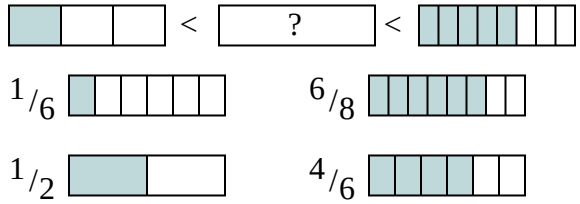

8) $^{3}/_{8}$ < ? < $^{2}/_{3}$

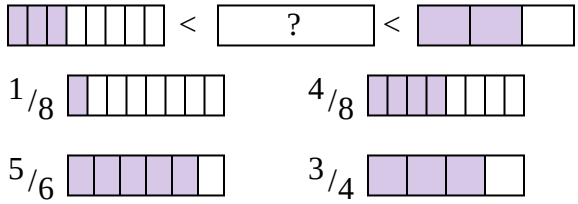

Answers

1. $^{4}/_{6}$
2. $^{3}/_{8}$
3. $^{1}/_{3}$
4. $^{2}/_{6}$
5. $^{2}/_{4}$
6. $^{2}/_{6}$
7. $^{1}/_{2}$
8. $^{4}/_{8}$

1-8	88	75	63	50	38	25	13	0