Multiplying Fractions & Whole Numbers

Name:

Use the visual models to solve.

1) $\frac{7}{8} \times 8 =$

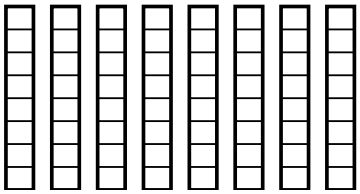

2) $\frac{1}{4} \times 6 =$

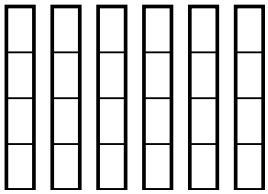

3) $\frac{1}{2} \times 5 =$

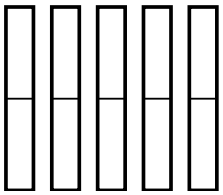

4) $\frac{3}{10} \times 5 =$

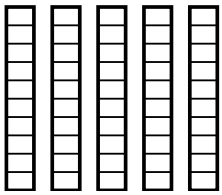

5) $\frac{1}{2} \times 3 =$

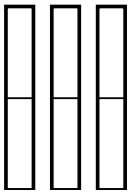

6) $\frac{3}{4} \times 4 =$

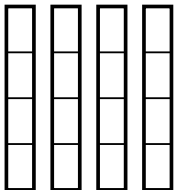

7) $\frac{1}{5} \times 2 =$

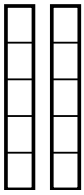

8) $\frac{2}{8} \times 6 =$

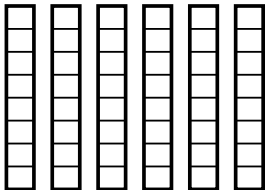

9) $\frac{2}{3} \times 7 =$

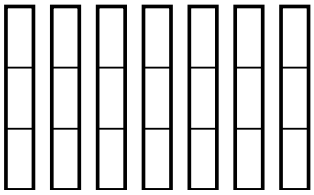

10) $\frac{1}{3} \times 8 =$

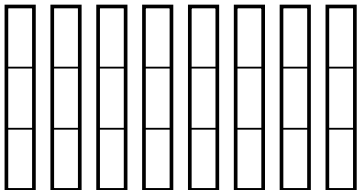

11) $\frac{2}{5} \times 2 =$

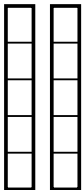

12) $\frac{5}{6} \times 5 =$

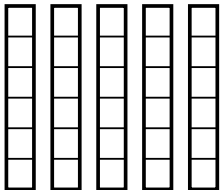

Answers

1. _____
2. _____
3. _____
4. _____
5. _____
6. _____
7. _____
8. _____
9. _____
10. _____
11. _____
12. _____

1-10	92	83	75	67	58	50	42	33	25	17
11-12	8	0								

Multiplying Fractions & Whole Numbers Name: **Answer Key**

Use the visual models to solve.

1) $\frac{7}{8} \times 8 =$

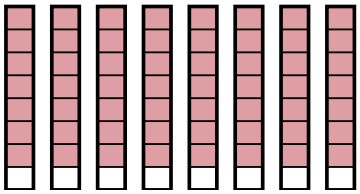

2) $\frac{1}{4} \times 6 =$

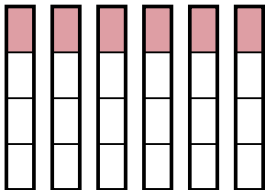

3) $\frac{1}{2} \times 5 =$

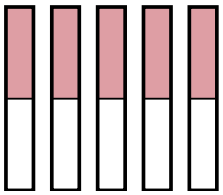

4) $\frac{3}{10} \times 5 =$

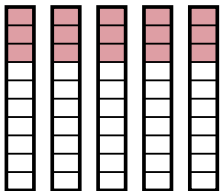

5) $\frac{1}{2} \times 3 =$

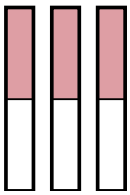

6) $\frac{3}{4} \times 4 =$

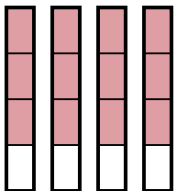

7) $\frac{1}{5} \times 2 =$

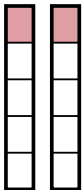

8) $\frac{2}{8} \times 6 =$

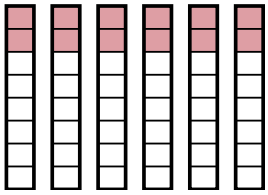

9) $\frac{2}{3} \times 7 =$

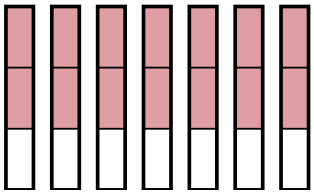

10) $\frac{1}{3} \times 8 =$



11) $\frac{2}{5} \times 2 =$

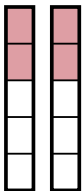

12) $\frac{5}{6} \times 5 =$

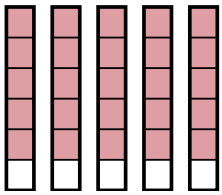

Answers

1. $\frac{56}{8}$
2. $\frac{6}{4}$
3. $\frac{5}{2}$
4. $\frac{15}{10}$
5. $\frac{3}{2}$
6. $\frac{12}{4}$
7. $\frac{2}{5}$
8. $\frac{12}{8}$
9. $\frac{14}{3}$
10. $\frac{8}{3}$
11. $\frac{4}{5}$
12. $\frac{25}{6}$

1-10	92	83	75	67	58	50	42	33	25	17
11-12	8	0								