Fraction Quantity Relative to Whole

Name:

Solve each problem.

Ex) Express the triangles as a fraction of the entire set.

1) Express the circles as a fraction of the entire set.

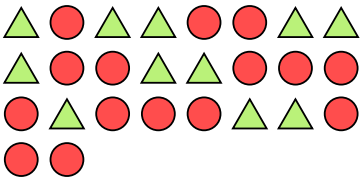

2) Express the pentagons as a fraction of the entire set.

3) Express the squares as a fraction of the entire set.

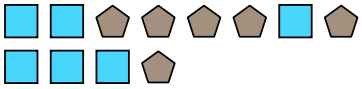

4) Express the moons as a fraction of the entire set.



5) Express the circles as a fraction of the entire set.

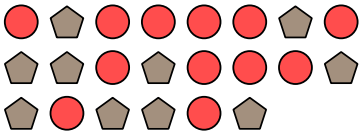

6) Express the triangles as a fraction of the entire set.

7) Express the hearts as a fraction of the entire set.



8) Express the hearts as a fraction of the entire set.



9) Express the hearts as a fraction of the entire set.



10) Express the squares as a fraction of the entire set.



11) Express the triangles as a fraction of the entire set.

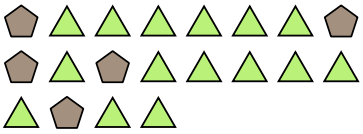

Answers

Ex. 3/12

1. _____
2. _____
3. _____
4. _____
5. _____
6. _____
7. _____
8. _____
9. _____
10. _____
11. _____

1-10	91	82	73	64	55	45	36	27	18	9
11	0									

Fraction Quantity Relative to Whole

Name: **Answer Key**

Solve each problem.

Ex) Express the triangles as a fraction of the entire set.

1) Express the circles as a fraction of the entire set.

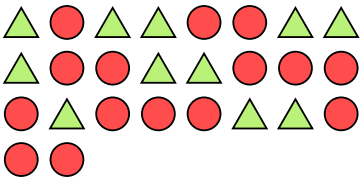

2) Express the pentagons as a fraction of the entire set.

3) Express the squares as a fraction of the entire set.

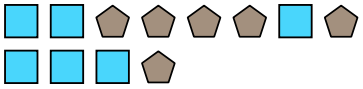

4) Express the moons as a fraction of the entire set.



5) Express the circles as a fraction of the entire set.

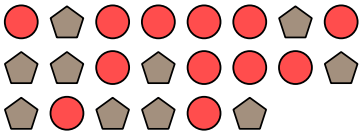

6) Express the triangles as a fraction of the entire set.

7) Express the hearts as a fraction of the entire set.



8) Express the hearts as a fraction of the entire set.



9) Express the hearts as a fraction of the entire set.



10) Express the squares as a fraction of the entire set.



11) Express the triangles as a fraction of the entire set.

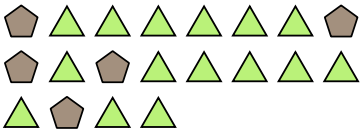

Answers

Ex.	3/12
1.	15/26
2.	4/15
3.	6/12
4.	8/22
5.	12/22
6.	6/10
7.	8/19
8.	15/23
9.	5/14
10.	6/19
11.	15/20

1-10	91	82	73	64	55	45	36	27	18	9
11	0									