Finding Decimals on a Numberline

Name:

Use the number lines to answer the questions.

1)

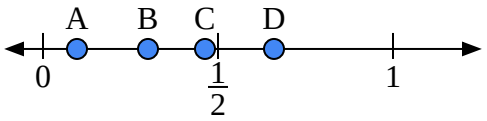

a) Which letter best represents the location of 0.3?

b) Which letter best represents the location of 0.66?

2)

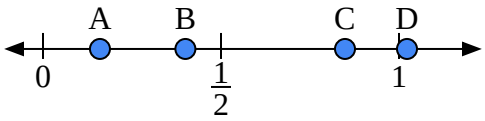

a) Which letter best represents the location of 0.4?

b) Which letter best represents the location of 0.16?

3)

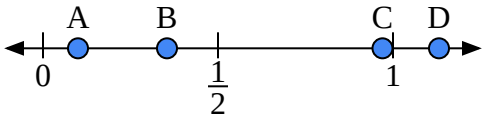

a) Which letter best represents the location of 0.10?

b) Which letter best represents the location of 0.97?

4)

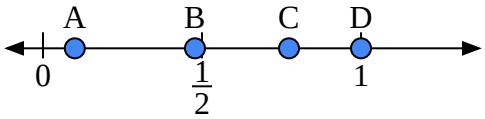

a) Which letter best represents the location of 1.0?

b) Which letter best represents the location of 0.10?

5)

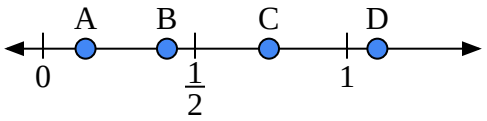

a) Which letter best represents the location of 1.10?

b) Which letter best represents the location of 0.14?

6)

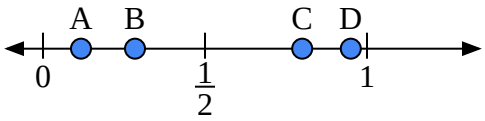

a) Which letter best represents the location of 0.80?

b) Which letter best represents the location of 0.95?

7)

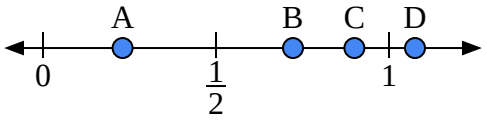

a) Which letter best represents the location of 0.9?

b) Which letter best represents the location of 0.23?

8)

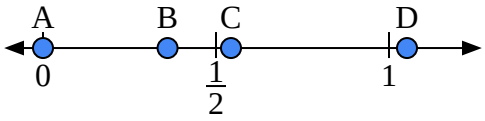

a) Which letter best represents the location of 0.00?

b) Which letter best represents the location of 0.36?

Answers

1. ____ ____
2. ____ ____
3. ____ ____
4. ____ ____
5. ____ ____
6. ____ ____
7. ____ ____
8. ____ ____

1-8	88	75	63	50	38	25	13	0

Finding Decimals on a Numberline Name: **Answer Key**

Use the number lines to answer the questions.

1)

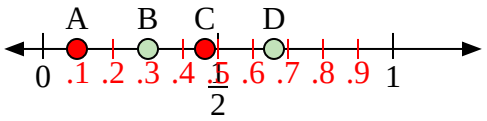

a) Which letter best represents the location of 0.3?

b) Which letter best represents the location of 0.66?

2)

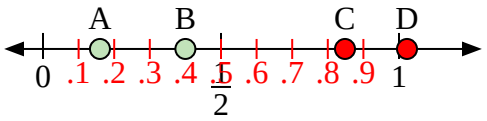

a) Which letter best represents the location of 0.4?

b) Which letter best represents the location of 0.16?

3)

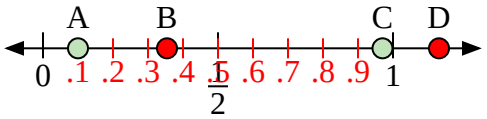

a) Which letter best represents the location of 0.10?

b) Which letter best represents the location of 0.97?

4)

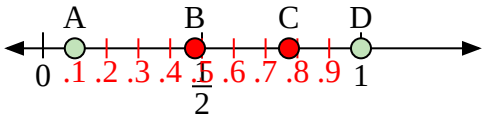

a) Which letter best represents the location of 1.0?

b) Which letter best represents the location of 0.10?

5)

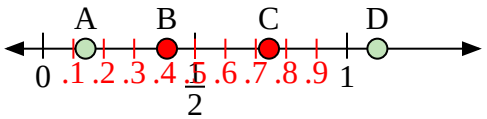

a) Which letter best represents the location of 1.10?

b) Which letter best represents the location of 0.14?

6)

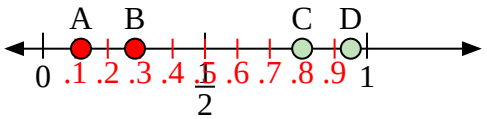

a) Which letter best represents the location of 0.80?

b) Which letter best represents the location of 0.95?

7)

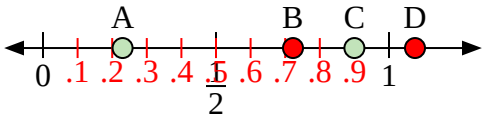

a) Which letter best represents the location of 0.9?

b) Which letter best represents the location of 0.23?

8)

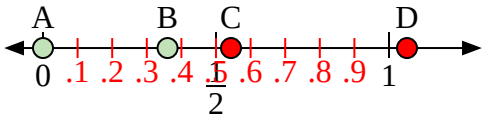

a) Which letter best represents the location of 0.00?

b) Which letter best represents the location of 0.36?

Answers

1. B D
2. B A
3. A C
4. D A
5. D A
6. C D
7. C A
8. A B

1-8	88	75	63	50	38	25	13	0