Counting Shapes

Name:

Count the number of shapes shown.

1) 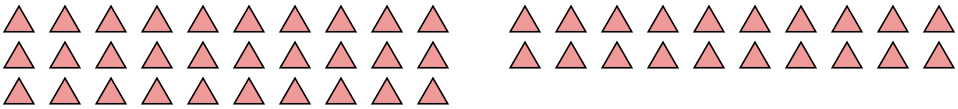

2) 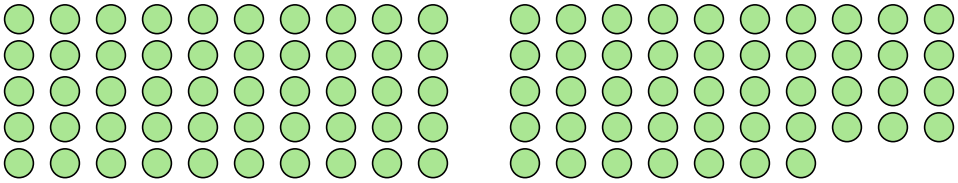

3)

4) 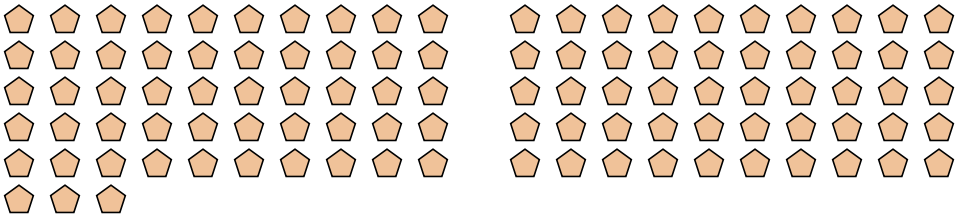

5)

Answers

1. _____

2. _____

3. _____

4. _____

5. _____

1-5	80	60	40	20	0

Counting Shapes

Name: **Answer Key**

Count the number of shapes shown.

1) 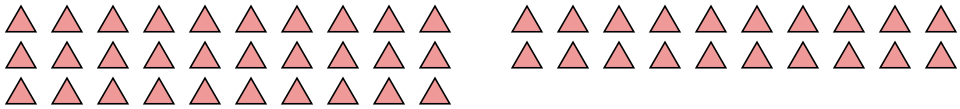

2) 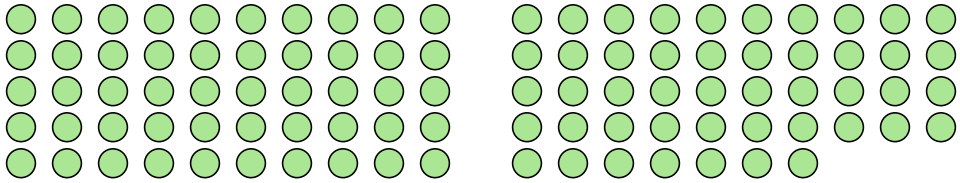

3)

4) 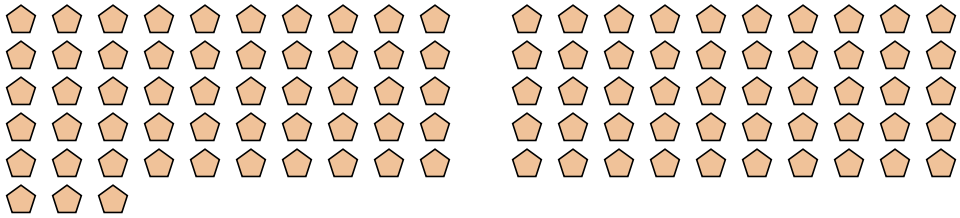

5)

Answers

1. **50**
2. **97**
3. **27**
4. **103**
5. **64**

1-5	80	60	40	20	0