Finding Area by Tiling

Name:

Find the area (in u) by tiling the rectangles shown. The first is tiled for you.

1)

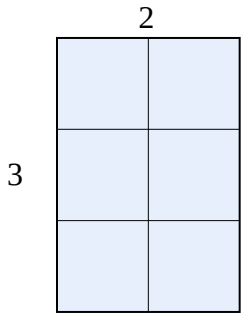

2)

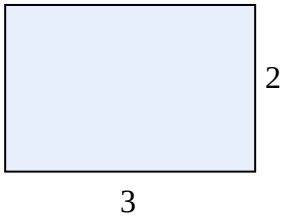

3)

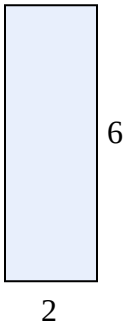

4)

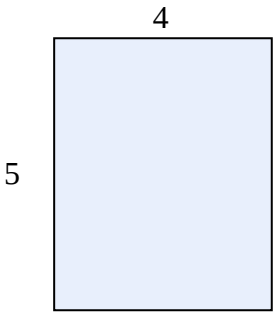

5)

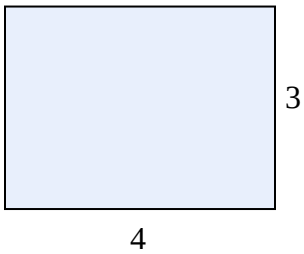

6)

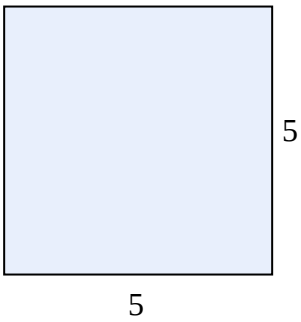

7)



8)

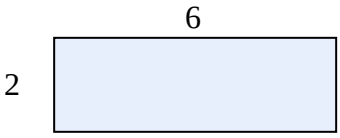

9)

10)

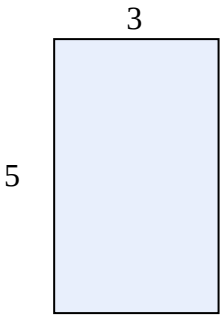

Answers

1. _____
2. _____
3. _____
4. _____
5. _____
6. _____
7. _____
8. _____
9. _____
10. _____

1-10	90	80	70	60	50	40	30	20	10	0

Finding Area by Tiling

Name: **Answer Key**

Find the area (in u) by tiling the rectangles shown. The first is tiled for you.

1)

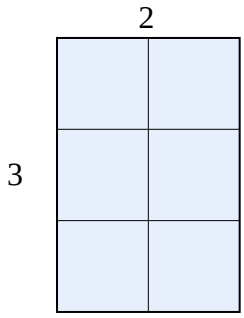

2)

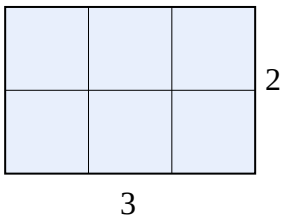

3)

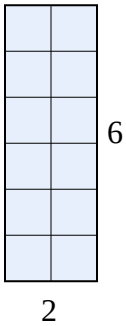

4)

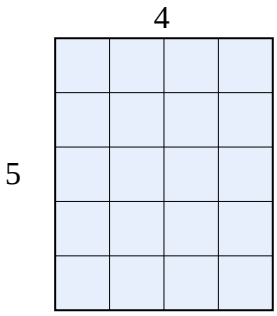

5)

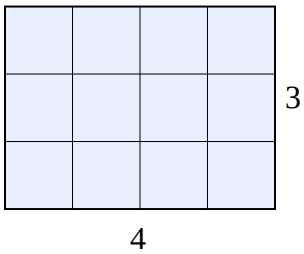

6)

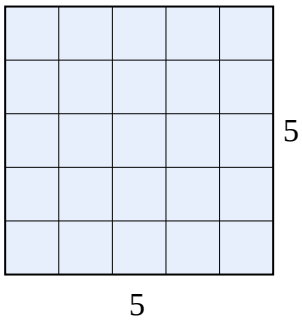

7)

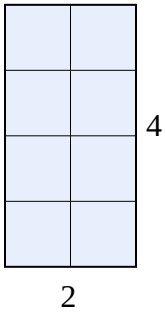

8)

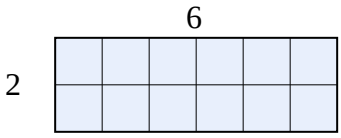

9)

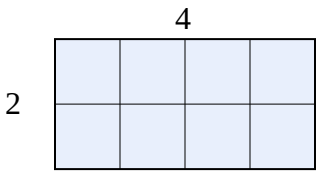

10)

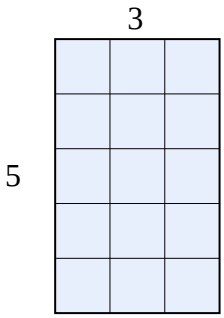

Answers

1. 6
2. 6
3. 12
4. 20
5. 12
6. 25
7. 8
8. 12
9. 8
10. 15

1-10	90	80	70	60	50	40	30	20	10	0