Finding Area

Name:

Find the area (in cm) of the rectangle shown.

1)

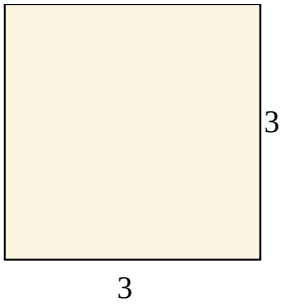

2)

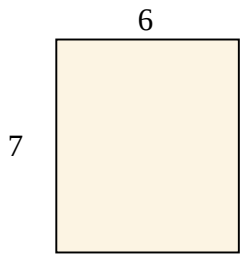

3)

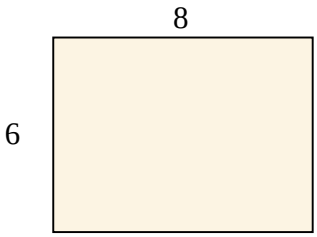

4)

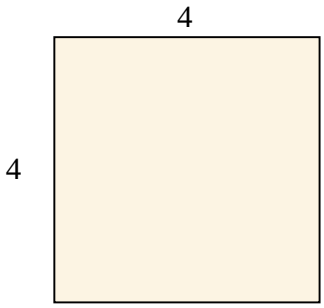

5)

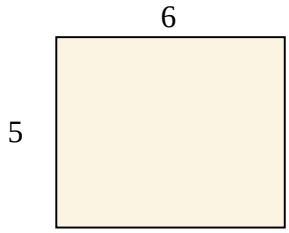

6)

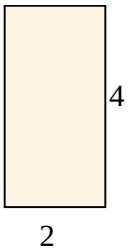

7)

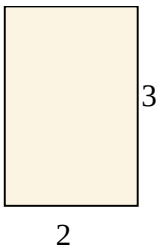

8)

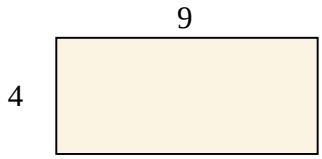

9)

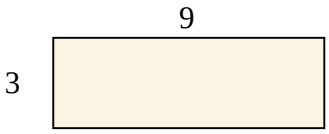

10)

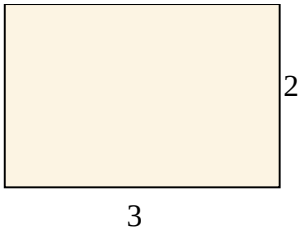

11)

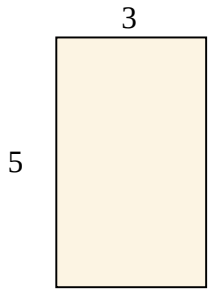

12)

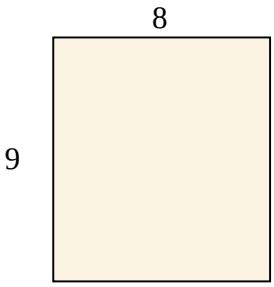

Answers

1. _____
2. _____
3. _____
4. _____
5. _____
6. _____
7. _____
8. _____
9. _____
10. _____
11. _____
12. _____

1-10	92	83	75	67	58	50	42	33	25	17
11-12	8	0								

Finding Area

Name: **Answer Key**

Find the area (in cm) of the rectangle shown.

1)

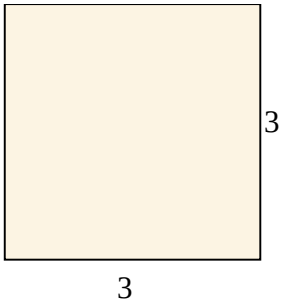

2)

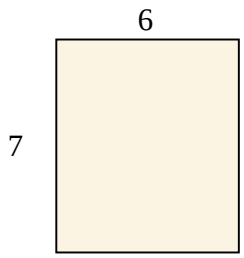

3)

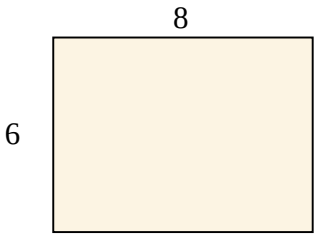

4)

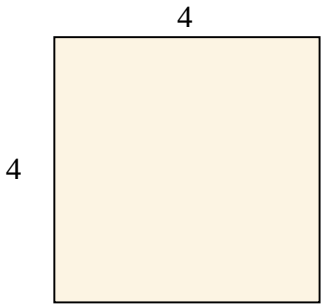

5)

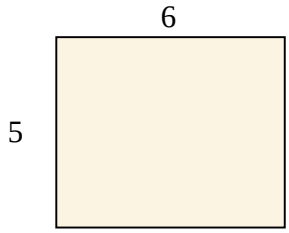

6)

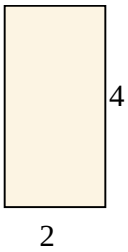

7)

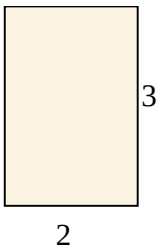

8)

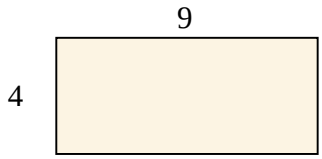

9)

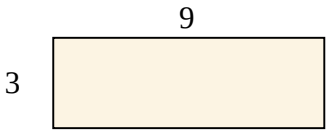

10)

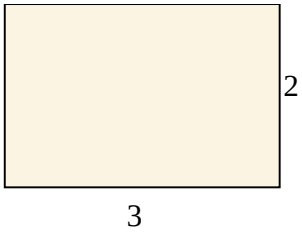

11)

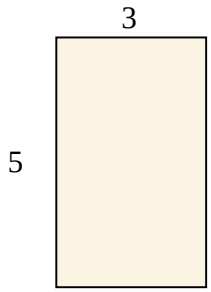

12)

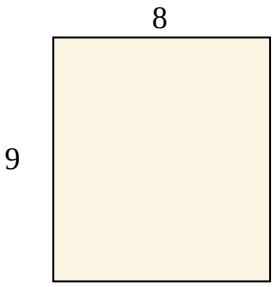

Answers

1. **9**
2. **42**
3. **48**
4. **16**
5. **30**
6. **8**
7. **6**
8. **36**
9. **27**
10. **6**
11. **15**
12. **72**

1-10	92	83	75	67	58	50	42	33	25	17
11-12	8	0								