# Determining Area with Square Units

Name:

**Determine the area. Each SVGREPLACE = 1 square unit ($u^2$).**

**1)** 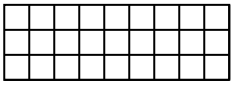

**2)** 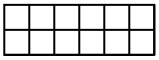

**3)** 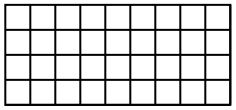

**4)** 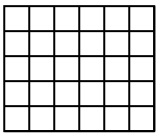

**5)** 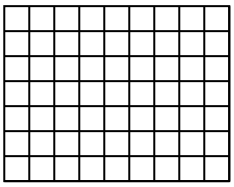

**6)** 

**7)** 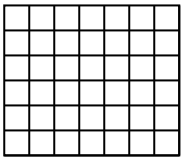

**8)** 

**9)** 

**10)**

**11)** 

**12)** 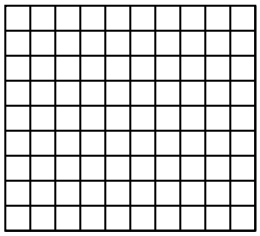

**13)** 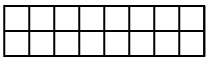

**14)** 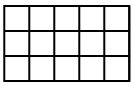

**15)** 

## Answers

1. _____
2. _____
3. _____
4. _____
5. _____
6. _____
7. _____
8. _____
9. _____
10. _____
11. _____
12. _____
13. _____
14. _____
15. _____



| | | | | | | | | | | |
|---|---|---|---|---|---|---|---|---|---|---|
| 1-10 | 93 | 87 | 80 | 73 | 67 | 60 | 53 | 47 | 40 | 33 |
| 11-15 | 27 | 20 | 13 | 7 | 0 | | | | | |

Determining Area with Square Units

Name: **Answer Key**

**Determine the area. Each SVGREPLACE = 1 square unit ($u^2$).**

**1)** 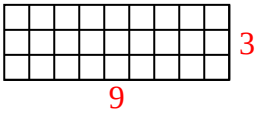


**2)** 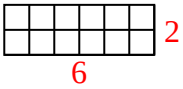


**3)** 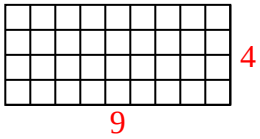


**4)** 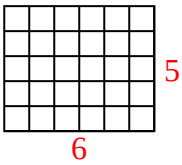


**5)** 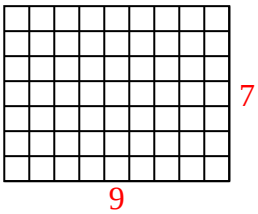


**6)** 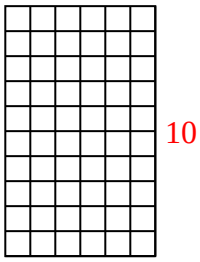


**7)** 


**8)** 


**9)** 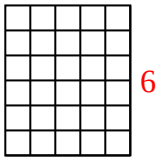


**10)**


**11)** 


**12)** 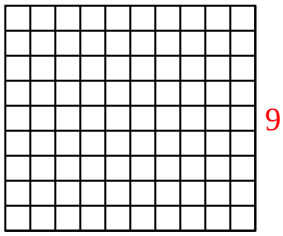


**13)** 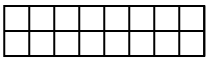


**14)** 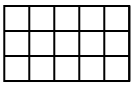


**15)** 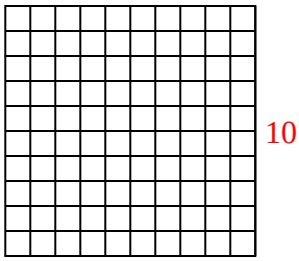


## Answers

1. **27 $u^2$**
2. **12 $u^2$**
3. **36 $u^2$**
4. **30 $u^2$**
5. **63 $u^2$**
6. **60 $u^2$**
7. **42 $u^2$**
8. **40 $u^2$**
9. **30 $u^2$**
10. **6 $u^2$**
11. **36 $u^2$**
12. **90 $u^2$**
13. **16 $u^2$**
14. **15 $u^2$**
15. **100 $u^2$**



| | | | | | | | | | | |
|---|---|---|---|---|---|---|---|---|---|---|
| 1-10 | 93 | 87 | 80 | 73 | 67 | 60 | 53 | 47 | 40 | 33 |
| 11-15 | 27 | 20 | 13 | 7 | 0 | | | | | |