Finding the Area and Circumference of a Circle Name:

Find the area and circumference of the circle. Circles are not to scale. Round to the nearest 10th.

1)

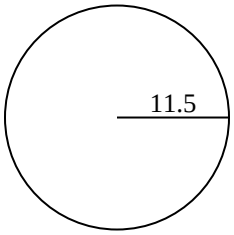

2)

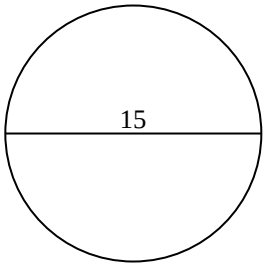

3)

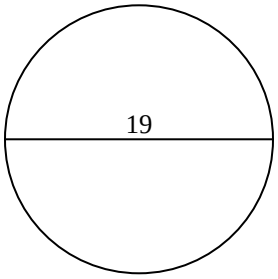

4)

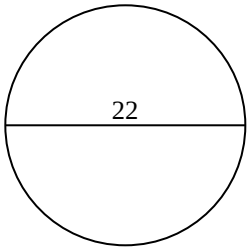

5)

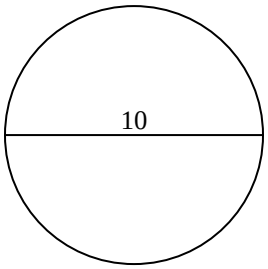

6)

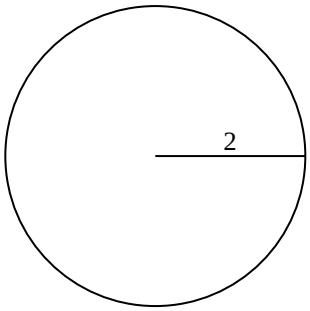

7)

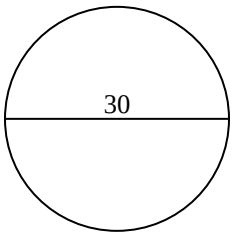

8)

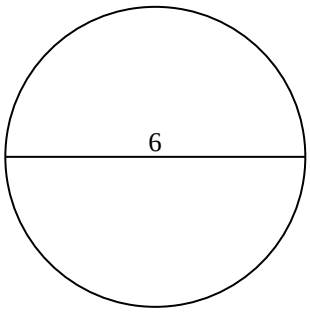

9)

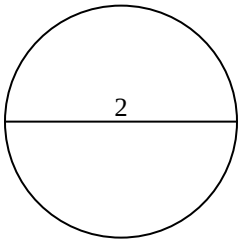

10)

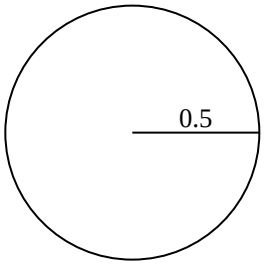

Answers

1. _____ _____
2. _____ _____
3. _____ _____
4. _____ _____
5. _____ _____
6. _____ _____
7. _____ _____
8. _____ _____
9. _____ _____
10. _____ _____

1-10	90	80	70	60	50	40	30	20	10	0

Find the area and circumference of the circle. Circles are not to scale. Round to the nearest 10th.

1)

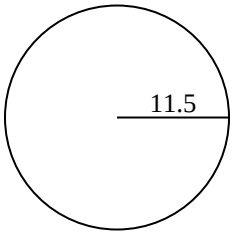

2)

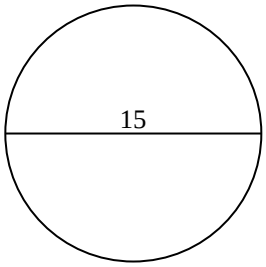

3)

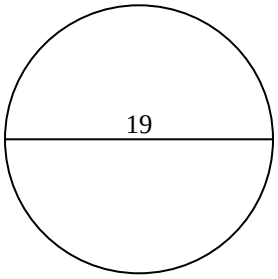

4)

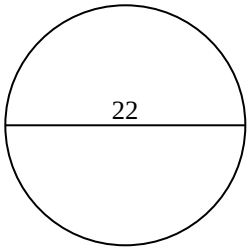

5)

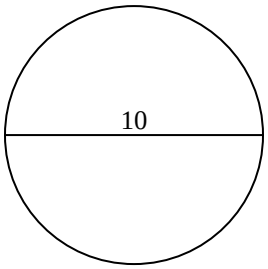

6)

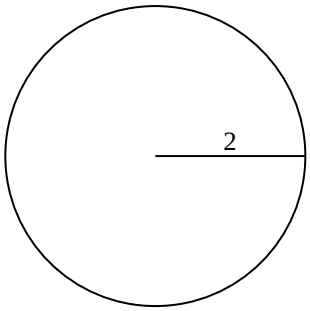

7)

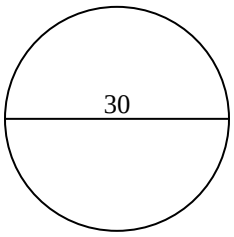

8)

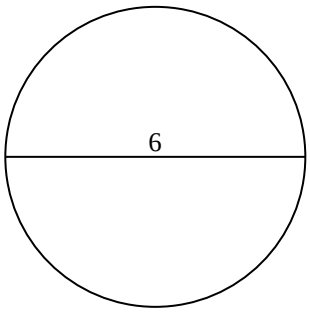

9)

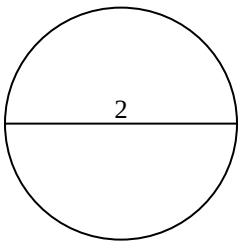

10)

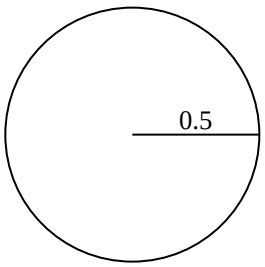

Answers

1.	415.5	72.3
2.	176.7	47.1
3.	283.5	59.7
4.	380.1	69.1
5.	78.5	31.4
6.	12.6	12.6
7.	706.9	94.2
8.	28.3	18.8
9.	3.1	6.3
10.	0.8	3.1

1-10	90	80	70	60	50	40	30	20	10	0

Finding the Area and Circumference of a Circle Name:

Find the area and circumference of the circle. Circles are not to scale. Round to the nearest 10th.

72.3	18.8	78.5	6.3	380.1
706.9	12.6	12.6	69.1	415.5
176.7	28.3	94.2	47.1	31.4
283.5	3.1	59.7		

1)

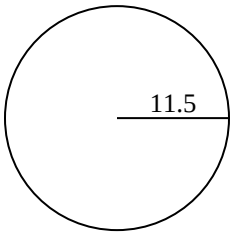

2)

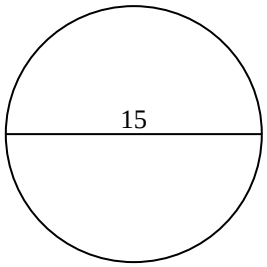

3)

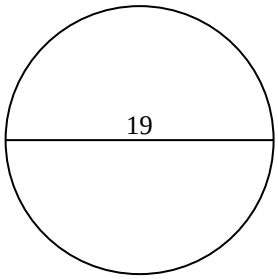

4)

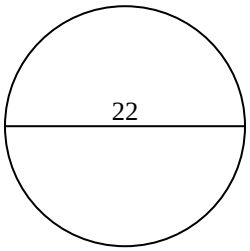

5)

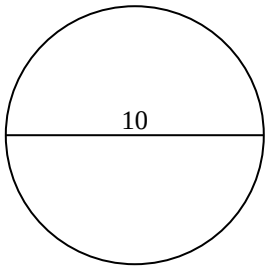

6)

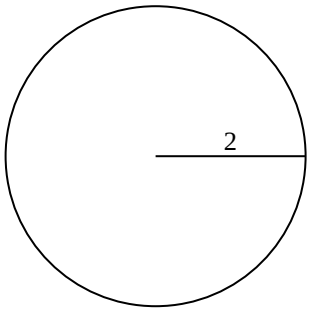

7)

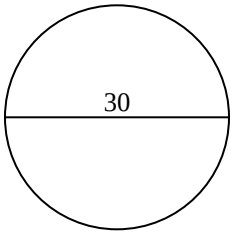

8)

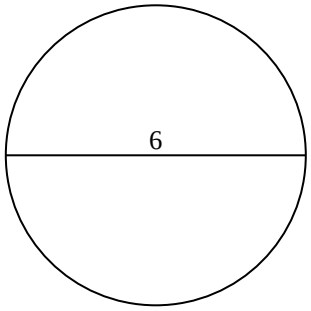

9)

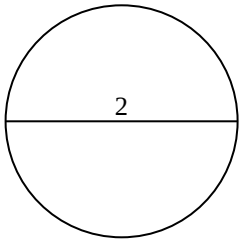

Answers

1. _____ _____
2. _____ _____
3. _____ _____
4. _____ _____
5. _____ _____
6. _____ _____
7. _____ _____
8. _____ _____
9. _____ _____

1-9	89	78	67	56	44	33	22	11	0