Finding Supplementary Angles Name:

Find the value of 'A' in the set of supplementary angles.

1)

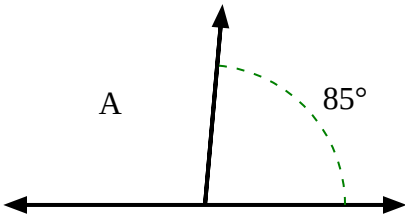

2)

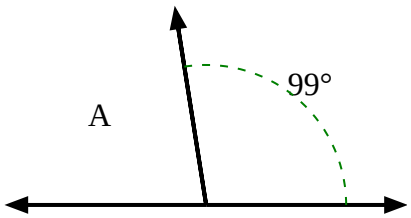

3)

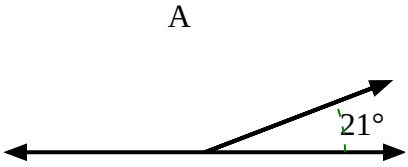

4)

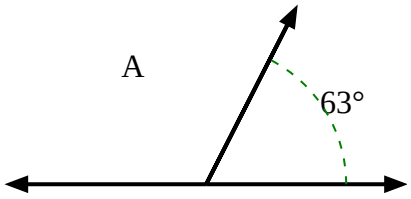

5)

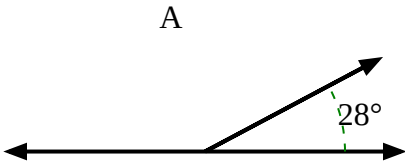

6)

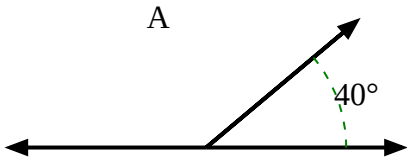

7)

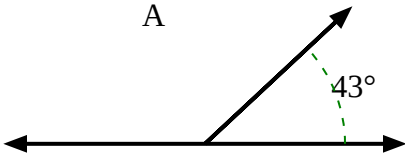

8)

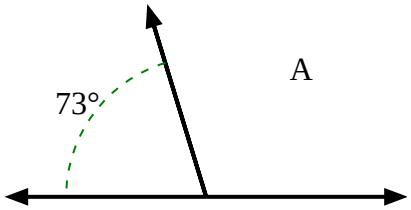

9)

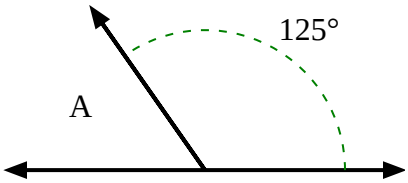

10)

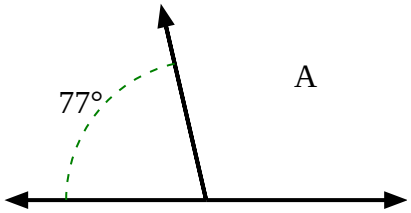

Answers

1. _____
2. _____
3. _____
4. _____
5. _____
6. _____
7. _____
8. _____
9. _____
10. _____

1-10	90	80	70	60	50	40	30	20	10	0

Finding Supplementary Angles

Name: **Answer Key**

Find the value of 'A' in the set of supplementary angles.

1)

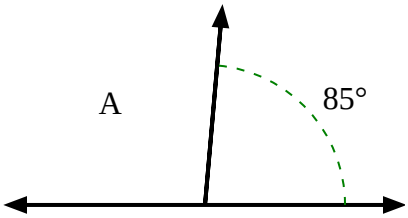

2)

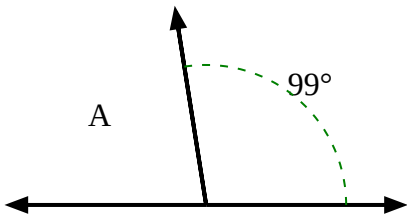

3)

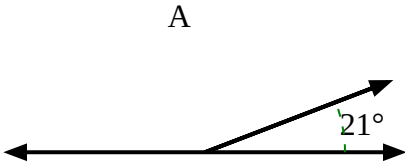

4)

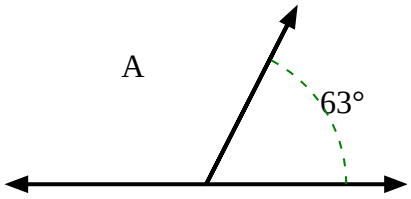

5)

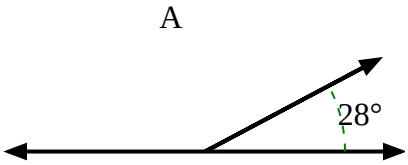

6)

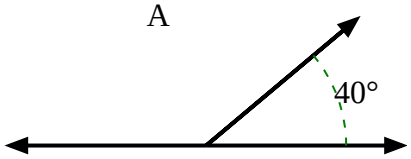

7)

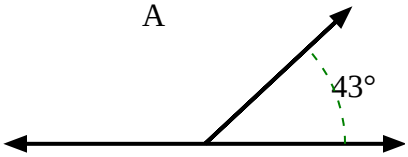

8)

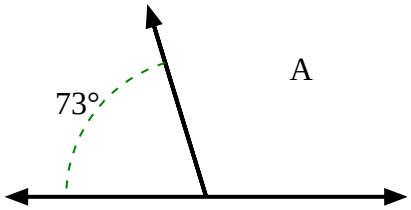

9)

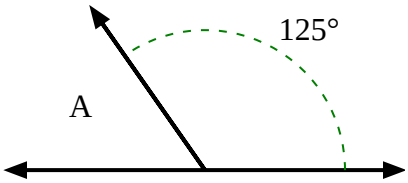

10)

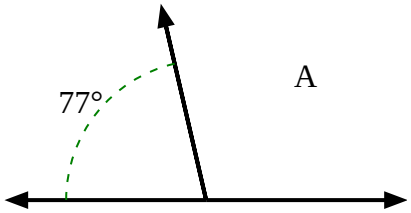

Answers

1. **95°**
2. **81°**
3. **159°**
4. **117°**
5. **152°**
6. **140°**
7. **137°**
8. **107°**
9. **55°**
10. **103°**

1-10	90	80	70	60	50	40	30	20	10	0