Finding Missing Side Length of Right Triangle (Area)

Name:

Find the value of X.

1) area = 7 u^2

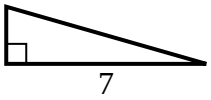

2) area = 12 u^2

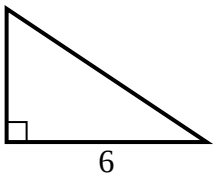

3) area = 10 u^2

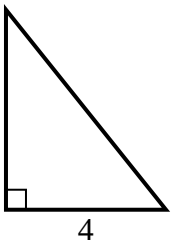

4) area = 16 u^2

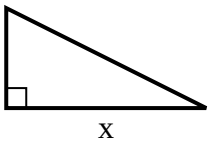

5) area = 18 u^2

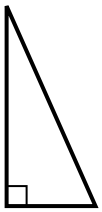

6) area = 10.5 u^2

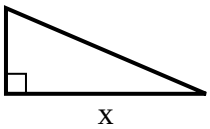

7) area = 22.5 u^2

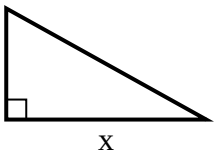

8) area = 20 u^2

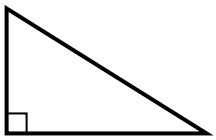

9) area = 5 u^2

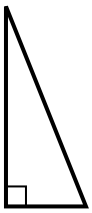

10) area = 17.5 u^2

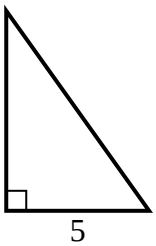

11) area = 7.5 u^2

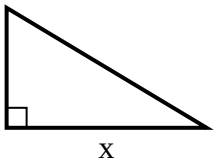

12) area = 12 u^2

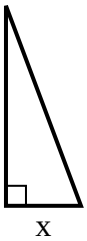

Answers

1. _____
2. _____
3. _____
4. _____
5. _____
6. _____
7. _____
8. _____
9. _____
10. _____
11. _____
12. _____

1-10	92	83	75	67	58	50	42	33	25	17
11-12	8	0								

Finding Missing Side Length of Right Triangle (Area) Name: **Answer Key**

Find the value of X.

1) area = 7 u^2

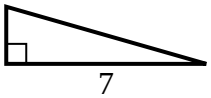

2) area = 12 u^2

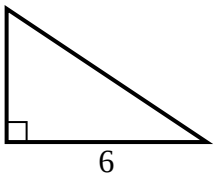

3) area = 10 u^2

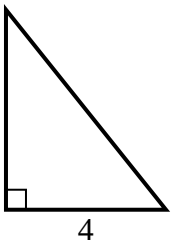

4) area = 16 u^2

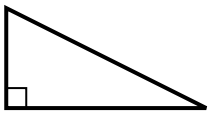

5) area = 18 u^2

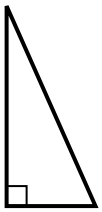

6) area = 10.5 u^2

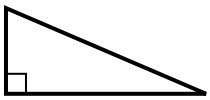

7) area = 22.5 u^2

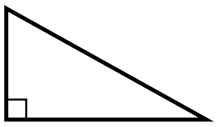

8) area = 20 u^2

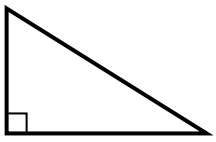

9) area = 5 u^2

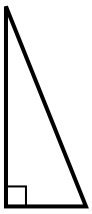

10) area = 17.5 u^2

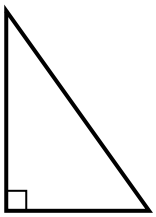

11) area = 7.5 u^2

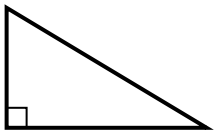

12) area = 12 u^2

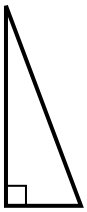

Answers

1. 2
2. 4
3. 5
4. 8
5. 4
6. 7
7. 9
8. 8
9. 2
10. 7
11. 5
12. 3

1-10	92	83	75	67	58	50	42	33	25	17
11-12	8	0								