Finding Complementary Angles

Name:

Find the value of 'A' in the set of complementary angles.

1)

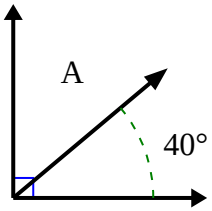

2)

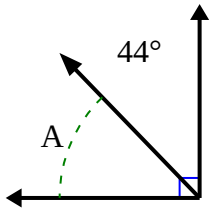

3)

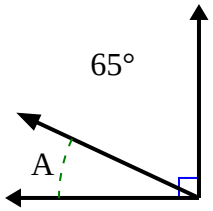

4)

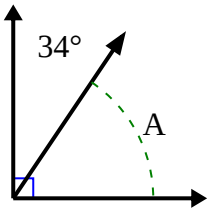

5)

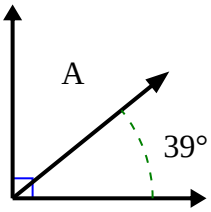

6)

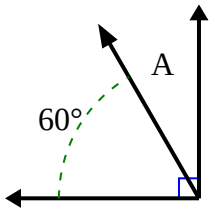

7)

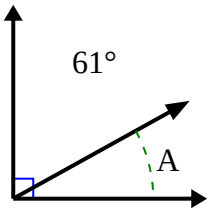

8)

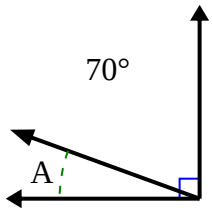

9)

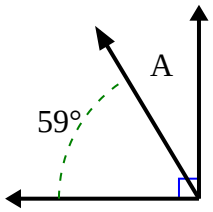

10)

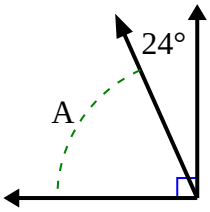

11)

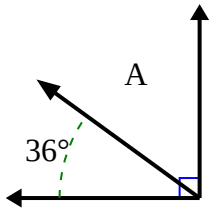

12)

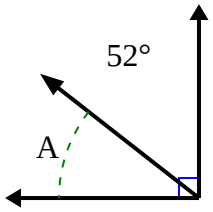

Answers

1. _____
2. _____
3. _____
4. _____
5. _____
6. _____
7. _____
8. _____
9. _____
10. _____
11. _____
12. _____

1-10	92	83	75	67	58	50	42	33	25	17
11-12	8	0								

Finding Complementary Angles

Name: **Answer Key**

Find the value of 'A' in the set of complementary angles.

1)

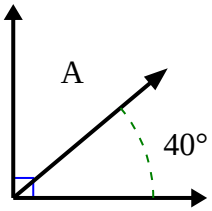

2)

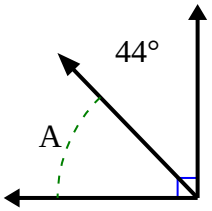

3)

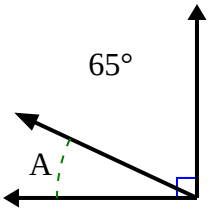

4)

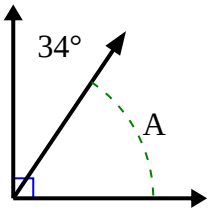

5)

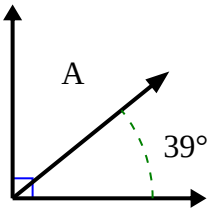

6)

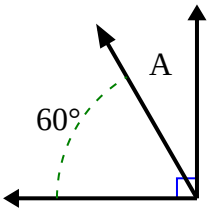

7)

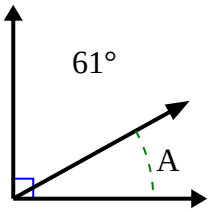

8)

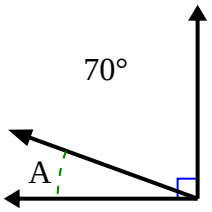

9)

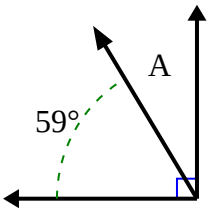

10)

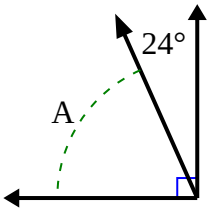

11)

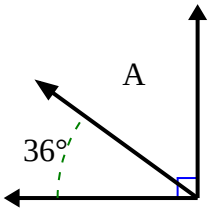

12)

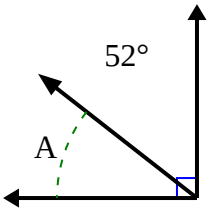

Answers

1. **50°**
2. **46°**
3. **25°**
4. **56°**
5. **51°**
6. **30°**
7. **29°**
8. **20°**
9. **31°**
10. **66°**
11. **54°**
12. **38°**

1-10	92	83	75	67	58	50	42	33	25	17
11-12	8	0								