Visual Place Value (Less than 20)

Name:

Fill in the blanks to find the amounts.

Ex)

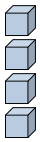

0 tens 4 ones

1)

_____ tens _____ ones

2)

_____ tens _____ ones

3)

_____ tens _____ ones

4)

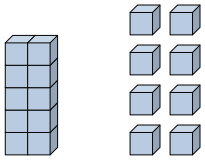

_____ tens _____ ones

5)

_____ tens _____ ones

6)

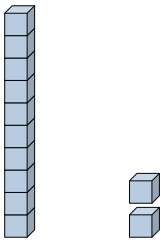

_____ tens _____ ones

7)

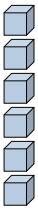

_____ tens _____ ones

8)

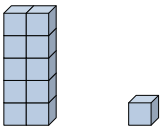

_____ tens _____ ones

9)

_____ tens _____ ones

10)

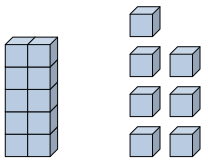

_____ tens _____ ones

11)

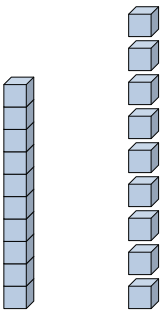

_____ tens _____ ones

Answers

Ex. 4

1. _____
2. _____
3. _____
4. _____
5. _____
6. _____
7. _____
8. _____
9. _____
10. _____
11. _____

Visual Place Value (Less than 20)

Name: **Answer Key**

Fill in the blanks to find the amounts.

Ex)

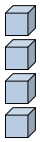

0 tens 4 ones

1)

0 tens 9 ones

2)

0 tens 3 ones

3)

0 tens 1 ones

4)

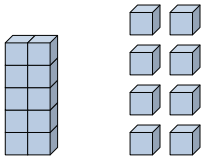

1 tens 8 ones

5)

0 tens 5 ones

6)

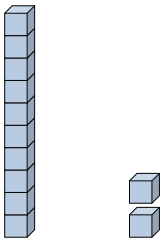

1 tens 2 ones

7)

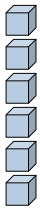

0 tens 6 ones

8)

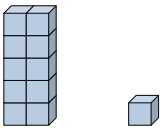

1 tens 1 ones

9)

0 tens 2 ones

10)

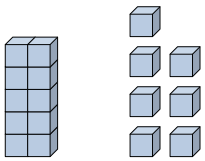

1 tens 7 ones

11)

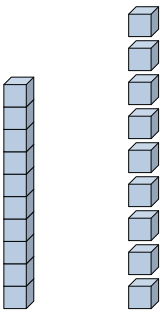

1 tens 9 ones

Answers

Ex.	4
1.	9
2.	3
3.	1
4.	18
5.	5
6.	12
7.	6
8.	11
9.	2
10.	17
11.	19