Reading Nontraditional Numberlines Name:

Find the value of R.

1)

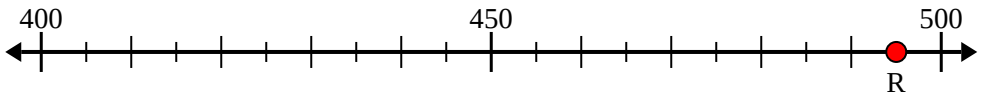

2)

3)

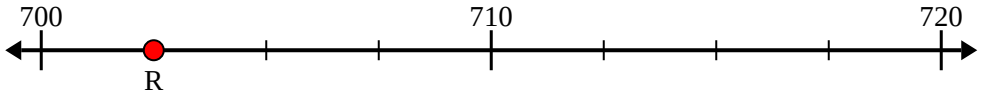

4)

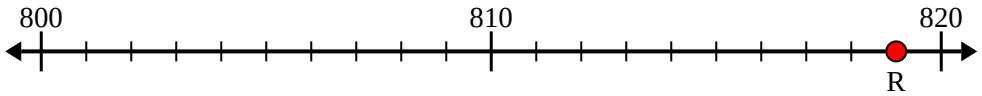

5)

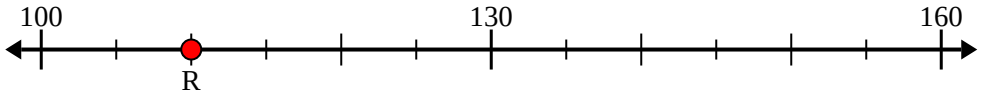

6)

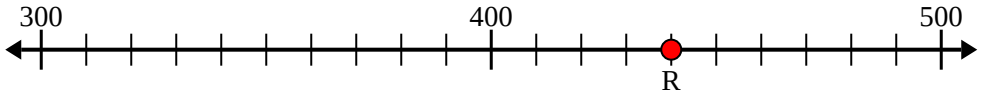

7)

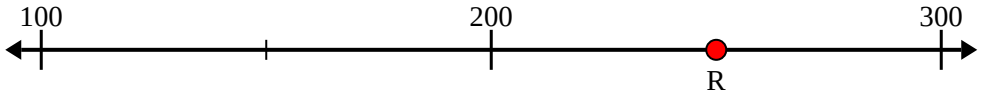

8)

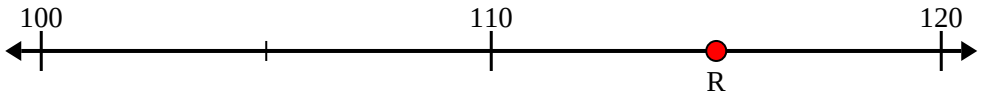

9)

10)

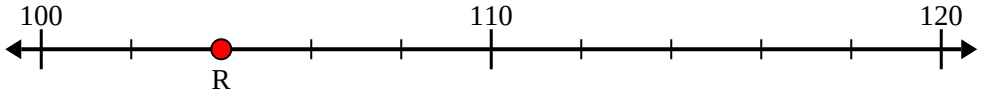

Answers

1. _____
2. _____
3. _____
4. _____
5. _____
6. _____
7. _____
8. _____
9. _____
10. _____

1-10	90	80	70	60	50	40	30	20	10	0

Reading Nontraditional Numberlines

Name: **Answer Key**

Find the value of R.

1)

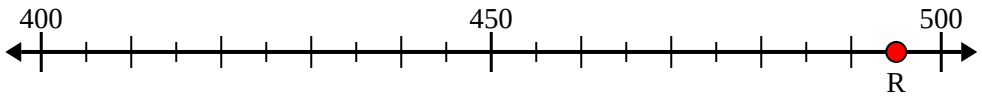

2)

3)

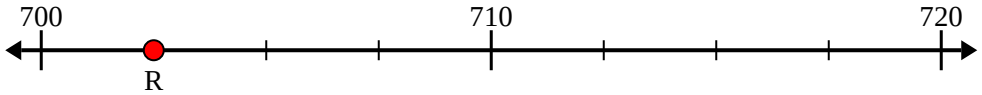

4)

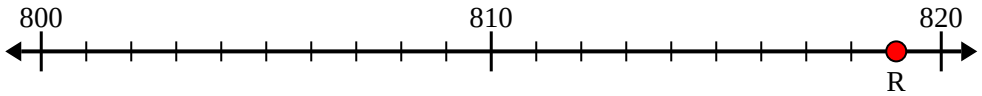

5)

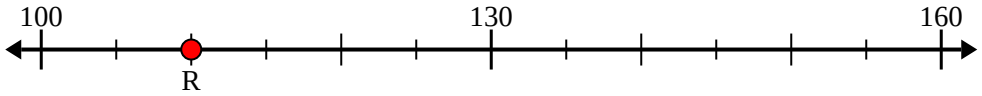

6)

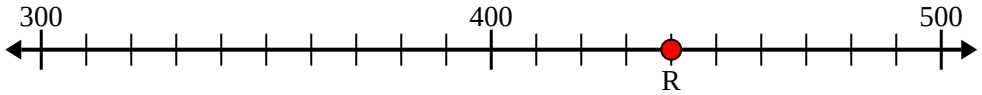

7)

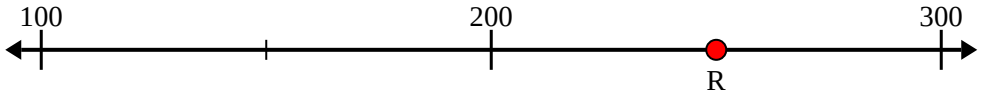

8)

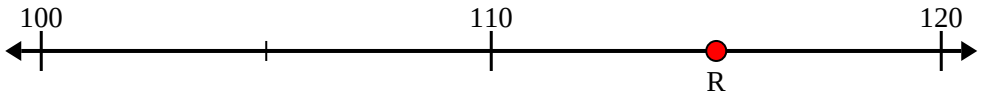

9)

10)

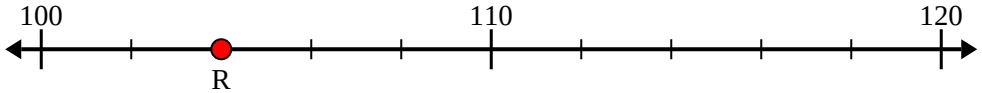

Answers

1. **495**
2. **490**
3. **702.5**
4. **819**
5. **110**
6. **440**
7. **250**
8. **115**
9. **210**
10. **104**

1-10	90	80	70	60	50	40	30	20	10	0