Finding Ending Time with a Numberline

Name:

Solve each problem.

1) Start: 2:50
Elapsed: 2 hrs & 50 mins
End: _____

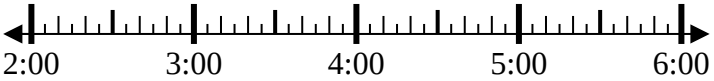

2) Start: 9:10
Elapsed: 1 hr & 10 mins
End: _____

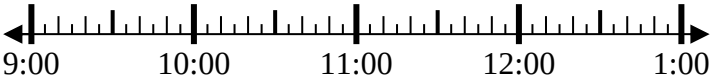

3) Start: 7:05
Elapsed: 1 hr & 15 mins
End: _____

4) Start: 3:00
Elapsed: 1 hr & 15 mins
End: _____

5) Start: 7:15
Elapsed: 1 hr & 40 mins
End: _____

6) Start: 5:00
Elapsed: 2 hrs & 15 mins
End: _____

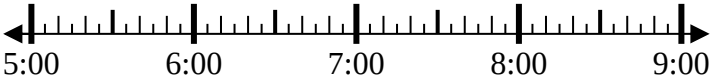

7) Start: 1:00
Elapsed: 2 hrs & 45 mins
End: _____

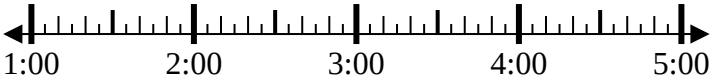

8) Start: 4:35
Elapsed: 1 hr & 20 mins
End: _____

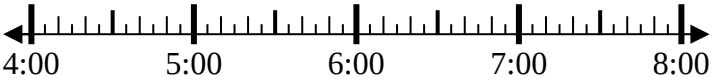

Answers

1. _____
2. _____
3. _____
4. _____
5. _____
6. _____
7. _____
8. _____

1-8	88	75	63	50	38	25	13	0

Finding Ending Time with a Numberline

Name: **Answer Key**

Solve each problem.

1) Start: 2:50
Elapsed: 2 hrs & 50 mins
End: 5:40

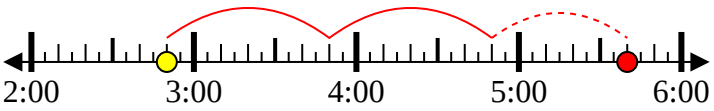

2) Start: 9:10
Elapsed: 1 hr & 10 mins
End: 10:20

3) Start: 7:05
Elapsed: 1 hr & 15 mins
End: 8:20

4) Start: 3:00
Elapsed: 1 hr & 15 mins
End: 4:15

5) Start: 7:15
Elapsed: 1 hr & 40 mins
End: 8:55

6) Start: 5:00
Elapsed: 2 hrs & 15 mins
End: 7:15

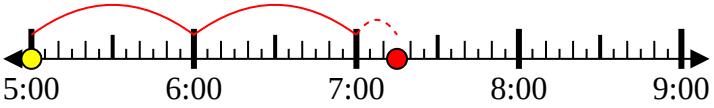

7) Start: 1:00
Elapsed: 2 hrs & 45 mins
End: 3:45

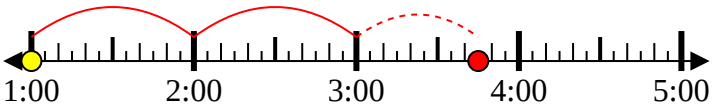

8) Start: 4:35
Elapsed: 1 hr & 20 mins
End: 5:55

Answers

1. 5:40
2. 10:20
3. 8:20
4. 4:15
5. 8:55
6. 7:15
7. 3:45
8. 5:55

1-8	88	75	63	50	38	25	13	0