Finding Elapsed Time with a Numberline

Name:

Solve each problem.

1) Start: 10:50

Elapsed: _____

End: 1:20

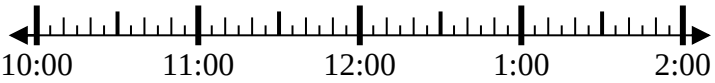

2) Start: 5:10

Elapsed: _____

End: 6:35

3) Start: 11:40

Elapsed: _____

End: 1:15

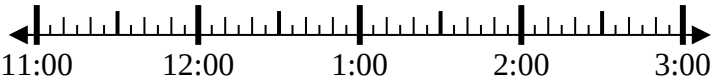

4) Start: 4:20

Elapsed: _____

End: 6:35

5) Start: 5:15

Elapsed: _____

End: 7:40

6) Start: 10:20

Elapsed: _____

End: 12:55

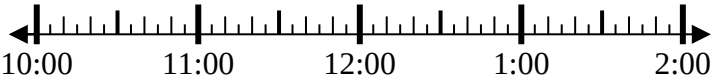

7) Start: 12:45

Elapsed: _____

End: 3:35

8) Start: 10:40

Elapsed: _____

End: 12:10

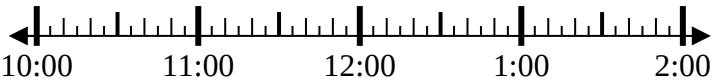

Answers

1. _____
2. _____
3. _____
4. _____
5. _____
6. _____
7. _____
8. _____

1-8	88	75	63	50	38	25	13	0

Finding Elapsed Time with a Numberline

Name: **Answer Key**

Solve each problem.

1) Start: 10:50
Elapsed: 2 hrs & 30 mins
End: 1:20

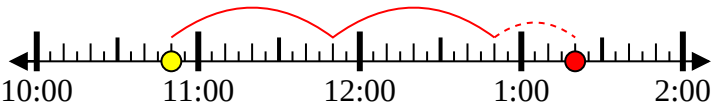

2) Start: 5:10
Elapsed: 1 hr & 25 mins
End: 6:35

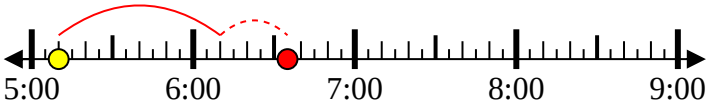

3) Start: 11:40
Elapsed: 1 hr & 35 mins
End: 1:15

4) Start: 4:20
Elapsed: 2 hrs & 15 mins
End: 6:35

5) Start: 5:15
Elapsed: 2 hrs & 25 mins
End: 7:40

6) Start: 10:20
Elapsed: 2 hrs & 35 mins
End: 12:55

7) Start: 12:45
Elapsed: 2 hrs & 50 mins
End: 3:35

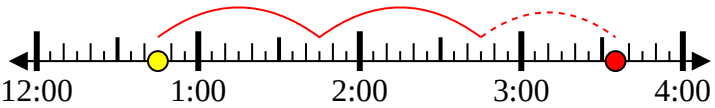

8) Start: 10:40
Elapsed: 1 hr & 30 mins
End: 12:10

Answers

1. **2 hrs & 30 mins**
2. **1 hr & 25 mins**
3. **1 hr & 35 mins**
4. **2 hrs & 15 mins**
5. **2 hrs & 25 mins**
6. **2 hrs & 35 mins**
7. **2 hrs & 50 mins**
8. **1 hr & 30 mins**

1-8	88	75	63	50	38	25	13	0