Identifying Right Triangles

Name:

Determine if the triangle shown is a right triangle (yes) or not (no).

1)

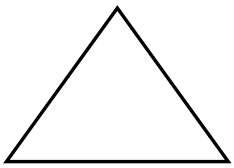

2)

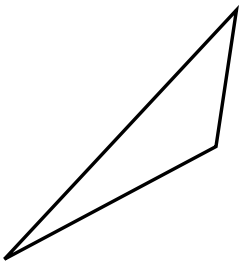

3)

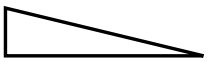

4)

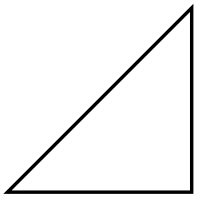

5)

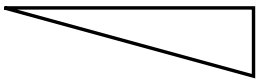

6)

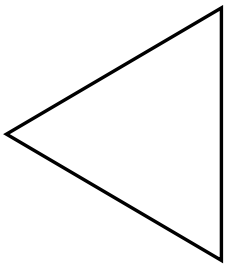

7)

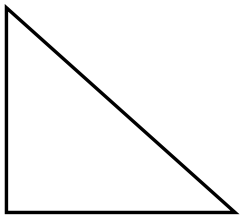

8)



9)



10)

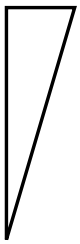

11)



12)

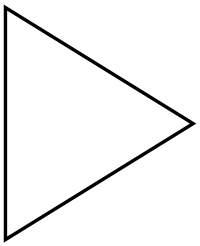

13)

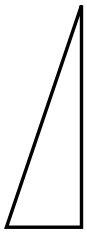

14)



15)

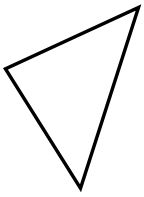

Answers

1. _____
2. _____
3. _____
4. _____
5. _____
6. _____
7. _____
8. _____
9. _____
10. _____
11. _____
12. _____
13. _____
14. _____
15. _____

1-10	93	87	80	73	67	60	53	47	40	33
11-15	27	20	13	7	0					

Identifying Right Triangles

Name: **Answer Key**

Determine if the triangle shown is a right triangle (yes) or not (no).

1)

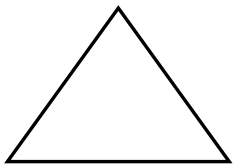

2)

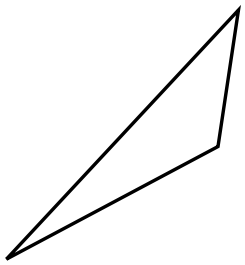

3)

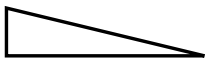

4)

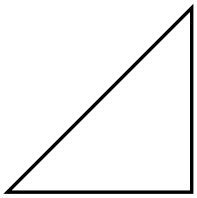

5)

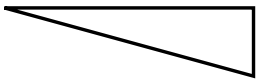

6)

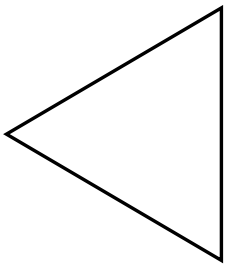

7)

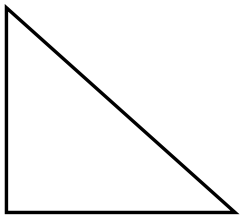

8)



9)



10)

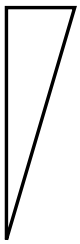

11)



12)

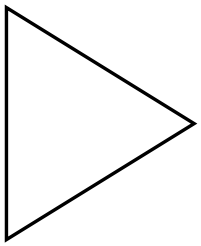

13)

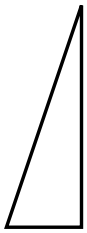

14)



15)

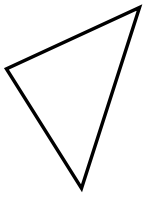

Answers

1. no
2. no
3. yes
4. yes
5. yes
6. no
7. yes
8. no
9. no
10. yes
11. no
12. no
13. yes
14. no
15. no

1-10	93	87	80	73	67	60	53	47	40	33
11-15	27	20	13	7	0					