Determining Spinner Percent Chance

Name:

Solve each problem. Round your answer to the nearest tenth.

1)

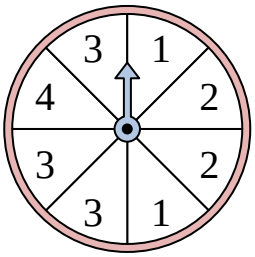

The spinner has a _____% chance of landing on a 3.

2)

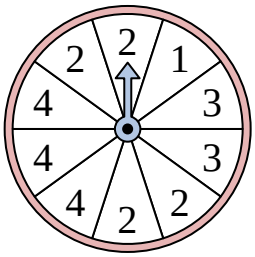

The spinner has a _____% chance of landing on a 4.

3)

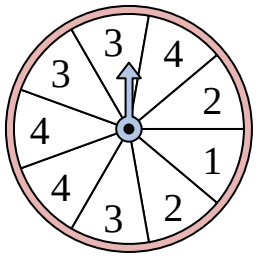

The spinner has a _____% chance of landing on a 3.

4)

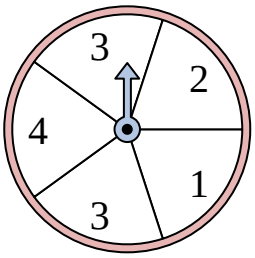

The spinner has a _____% chance of landing on a 1.

5)

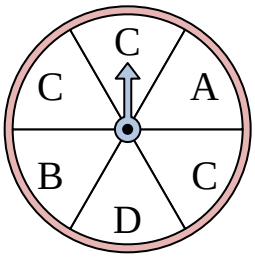

The spinner has a _____% chance of landing on a C.

6)

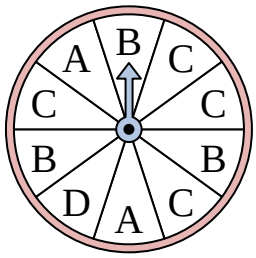

The spinner has a _____% chance of landing on a D.

7)

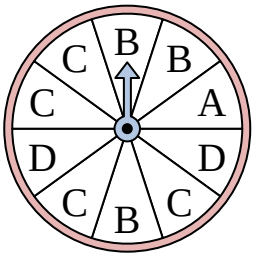

The spinner has a _____% chance of landing on a A.

8)

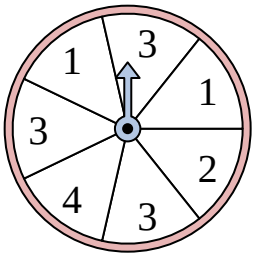

The spinner has a _____% chance of landing on a 3.

9)

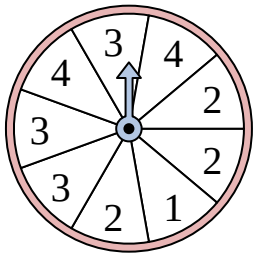

The spinner has a _____% chance of landing on a 4.

10)

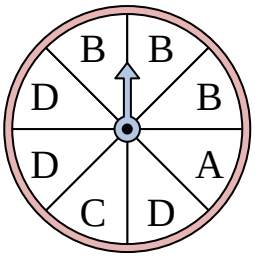

The spinner has a _____% chance of landing on a B.

11)

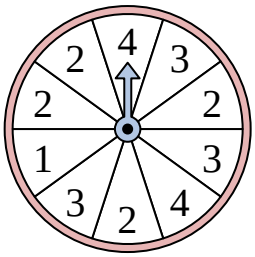

The spinner has a _____% chance of landing on a 1.

12)

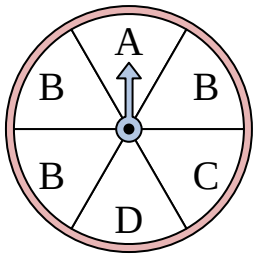

The spinner has a _____% chance of landing on a C.

Answers

1. _____
2. _____
3. _____
4. _____
5. _____
6. _____
7. _____
8. _____
9. _____
10. _____
11. _____
12. _____

1-10	92	83	75	67	58	50	42	33	25	17
11-12	8	0								

Determining Spinner Percent Chance

Name: **Answer Key**

Solve each problem. Round your answer to the nearest tenth.

1)

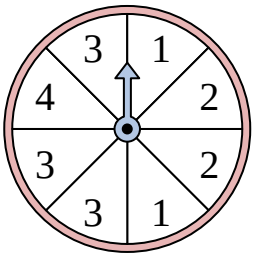

The spinner has a _____% chance of landing on a 3.

2)

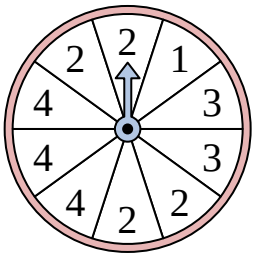

The spinner has a _____% chance of landing on a 4.

3)

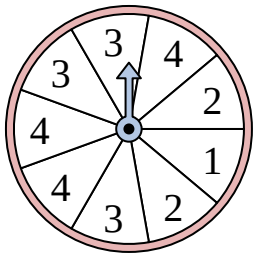

The spinner has a _____% chance of landing on a 3.

4)

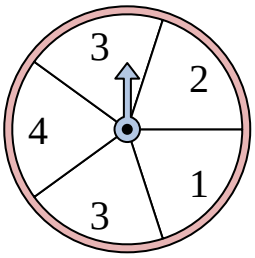

The spinner has a _____% chance of landing on a 1.

5)

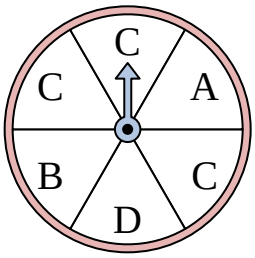

The spinner has a _____% chance of landing on a C.

6)

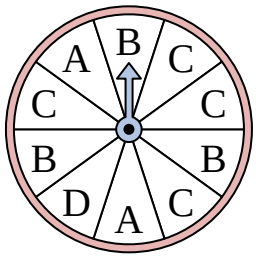

The spinner has a _____% chance of landing on a D.

7)

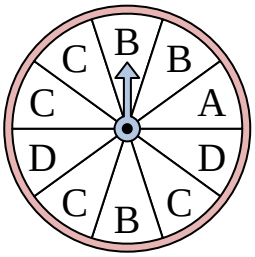

The spinner has a _____% chance of landing on a A.

8)

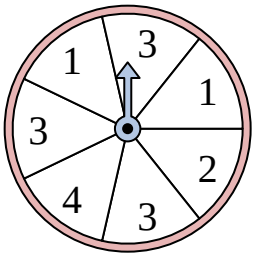

The spinner has a _____% chance of landing on a 3.

9)

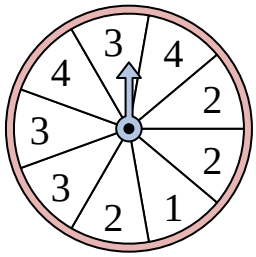

The spinner has a _____% chance of landing on a 4.

10)

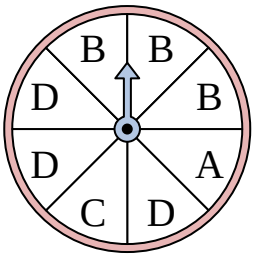

The spinner has a _____% chance of landing on a B.

11)

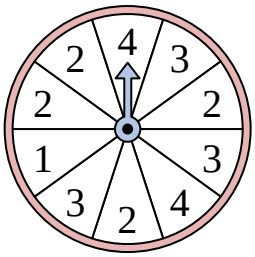

The spinner has a _____% chance of landing on a 1.

12)

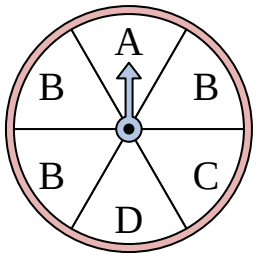

The spinner has a _____% chance of landing on a C.

Answers

1. **37.5**
2. **30**
3. **33.3**
4. **20**
5. **50**
6. **10**
7. **10**
8. **42.9**
9. **22.2**
10. **37.5**
11. **10**
12. **16.7**

1-10	92	83	75	67	58	50	42	33	25	17
11-12	8	0								

Determining Spinner Percent Chance

Name:

Solve each problem. Round your answer to the nearest tenth.

1)

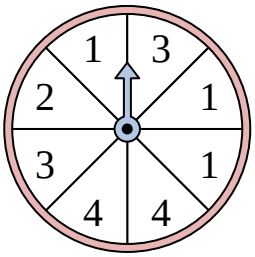

The spinner has a _____% chance of landing on a 3.

2)

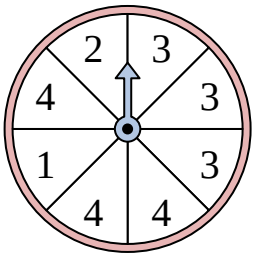

The spinner has a _____% chance of landing on a 3.

3)

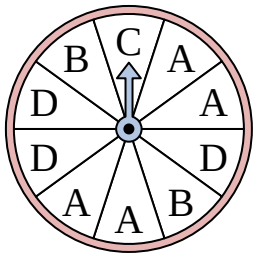

The spinner has a _____% chance of landing on a B.

4)

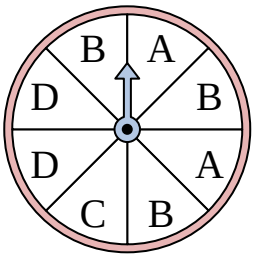

The spinner has a _____% chance of landing on a C.

5)

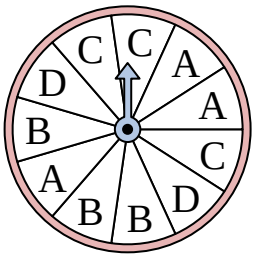

The spinner has a _____% chance of landing on a D.

6)

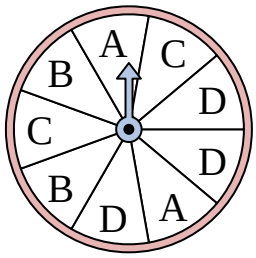

The spinner has a _____% chance of landing on a C.

7)

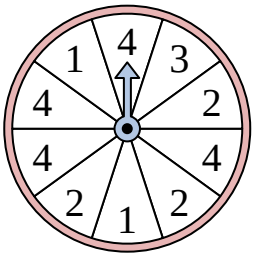

The spinner has a _____% chance of landing on a 1.

8)

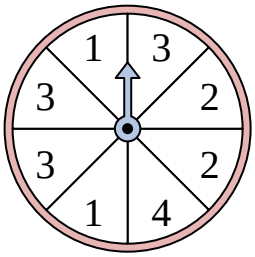

The spinner has a _____% chance of landing on a 3.

9)

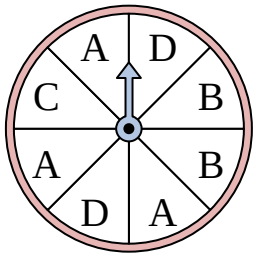

The spinner has a _____% chance of landing on a B.

10)

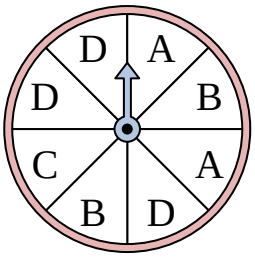

The spinner has a _____% chance of landing on a B.

11)

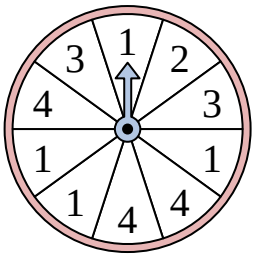

The spinner has a _____% chance of landing on a 3.

12)

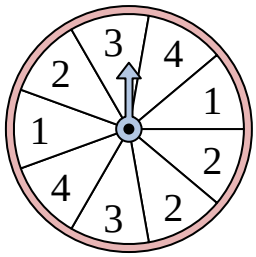

The spinner has a _____% chance of landing on a 1.

Answers

1. _____
2. _____
3. _____
4. _____
5. _____
6. _____
7. _____
8. _____
9. _____
10. _____
11. _____
12. _____

1-10	92	83	75	67	58	50	42	33	25	17
11-12	8	0								

Determining Spinner Percent Chance

Name: **Answer Key**

Solve each problem. Round your answer to the nearest tenth.

1)

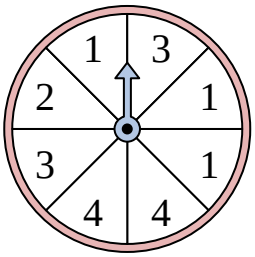

The spinner has a _____% chance of landing on a 3.

2)

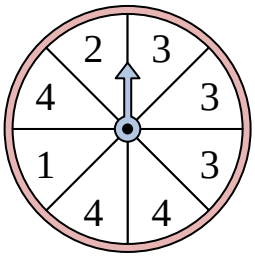

The spinner has a _____% chance of landing on a 3.

3)

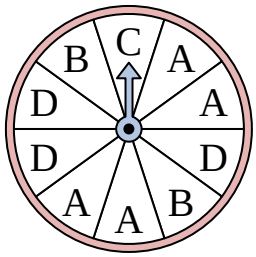

The spinner has a _____% chance of landing on a B.

4)

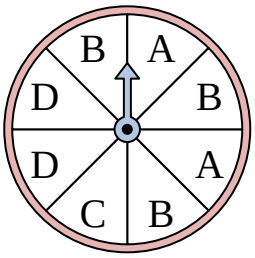

The spinner has a _____% chance of landing on a C.

5)

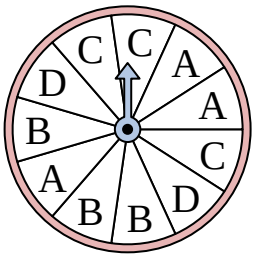

The spinner has a _____% chance of landing on a D.

6)

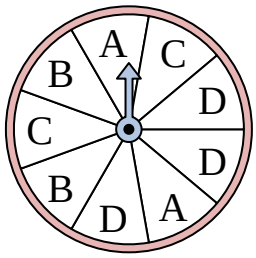

The spinner has a _____% chance of landing on a C.

7)

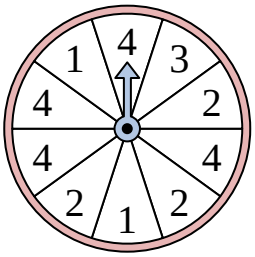

The spinner has a _____% chance of landing on a 1.

8)

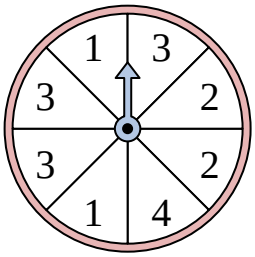

The spinner has a _____% chance of landing on a 3.

9)

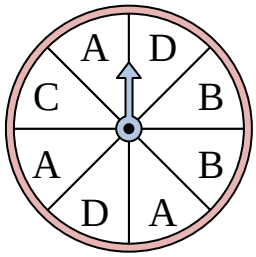

The spinner has a _____% chance of landing on a B.

10)

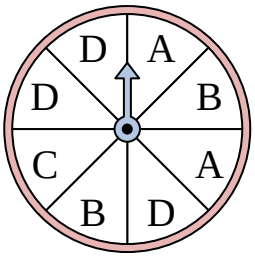

The spinner has a _____% chance of landing on a B.

11)

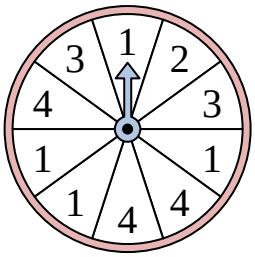

The spinner has a _____% chance of landing on a 3.

12)

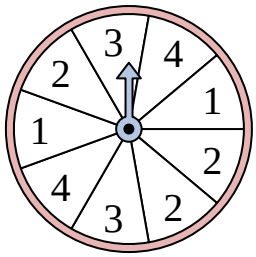

The spinner has a _____% chance of landing on a 1.

Answers

1. 25
2. 37.5
3. 20
4. 12.5
5. 18.2
6. 22.2
7. 20
8. 37.5
9. 25
10. 25
11. 20
12. 22.2

1-10	92	83	75	67	58	50	42	33	25	17
11-12	8	0								

Determining Spinner Percent Chance

Name:

Solve each problem. Round your answer to the nearest tenth.

1)

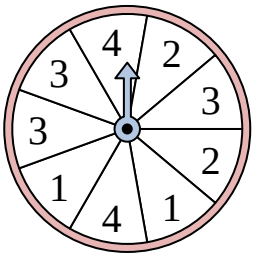

The spinner has a _____% chance of landing on a 2.

2)

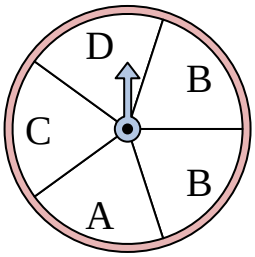

The spinner has a _____% chance of landing on a D.

3)

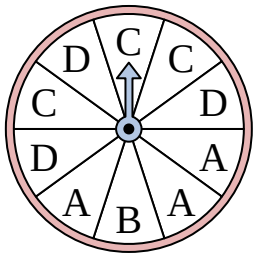

The spinner has a _____% chance of landing on a B.

4)

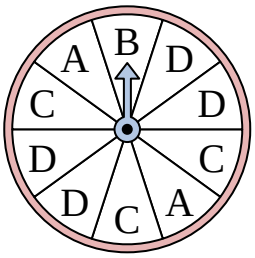

The spinner has a _____% chance of landing on a A.

5)

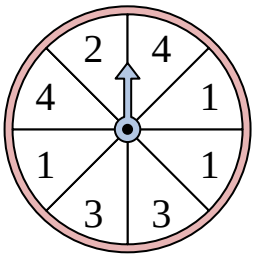

The spinner has a _____% chance of landing on a 3.

6)

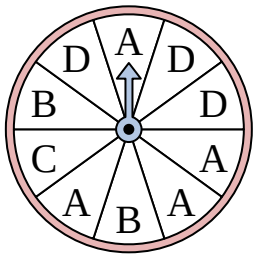

The spinner has a _____% chance of landing on a C.

7)

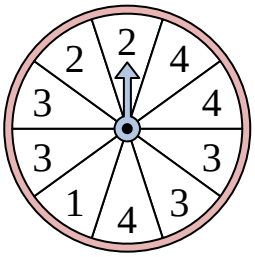

The spinner has a _____% chance of landing on a 4.

8)

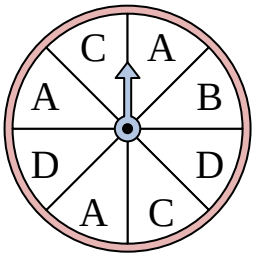

The spinner has a _____% chance of landing on a C.

9)

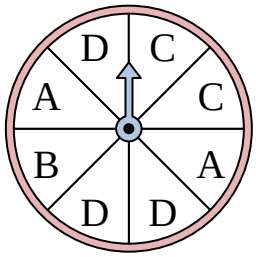

The spinner has a _____% chance of landing on a D.

10)

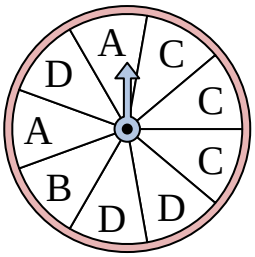

The spinner has a _____% chance of landing on a A.

11)

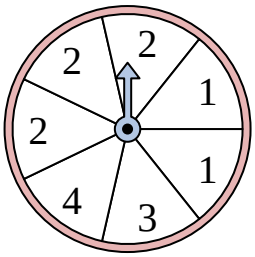

The spinner has a _____% chance of landing on a 1.

12)

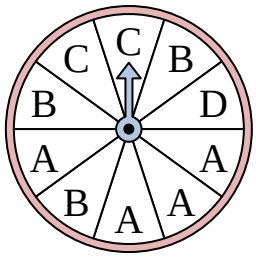

The spinner has a _____% chance of landing on a A.

Answers

1. _____
2. _____
3. _____
4. _____
5. _____
6. _____
7. _____
8. _____
9. _____
10. _____
11. _____
12. _____

1-10	92	83	75	67	58	50	42	33	25	17
11-12	8	0								

Determining Spinner Percent Chance

Name: **Answer Key**

Solve each problem. Round your answer to the nearest tenth.

1)

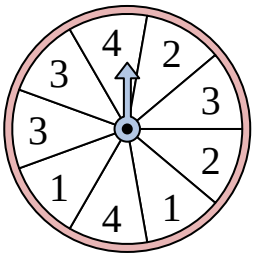

The spinner has a _____% chance of landing on a 2.

2)

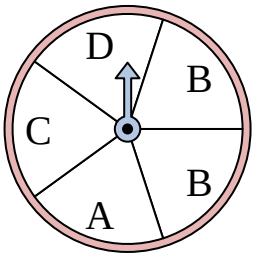

The spinner has a _____% chance of landing on a D.

3)

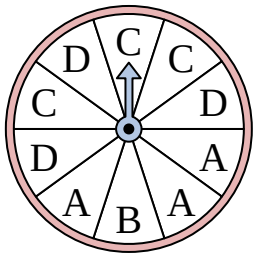

The spinner has a _____% chance of landing on a B.

4)

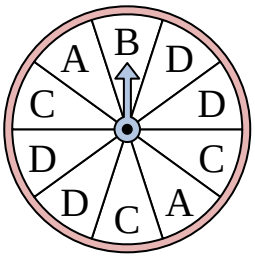

The spinner has a _____% chance of landing on a A.

5)

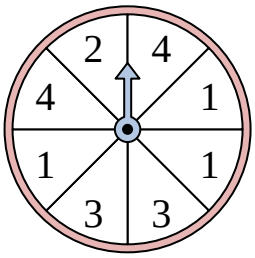

The spinner has a _____% chance of landing on a 3.

6)

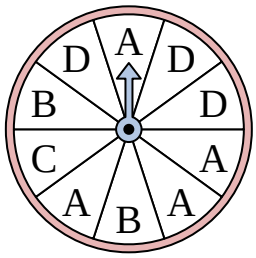

The spinner has a _____% chance of landing on a C.

7)

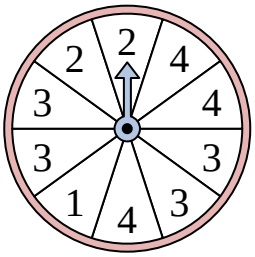

The spinner has a _____% chance of landing on a 4.

8)

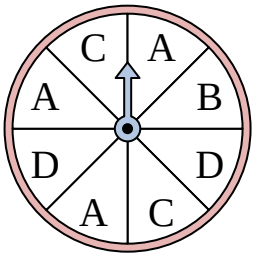

The spinner has a _____% chance of landing on a C.

9)

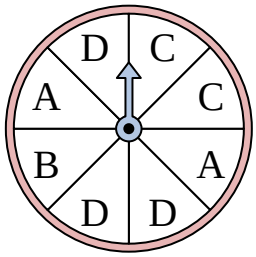

The spinner has a _____% chance of landing on a D.

10)

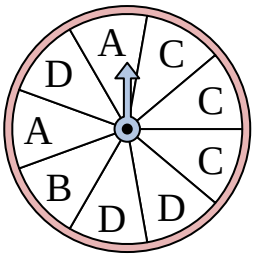

The spinner has a _____% chance of landing on a A.

11)

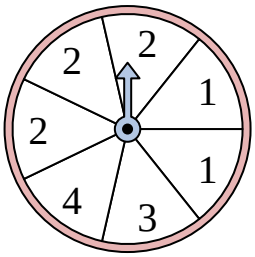

The spinner has a _____% chance of landing on a 1.

12)

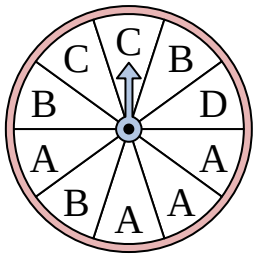

The spinner has a _____% chance of landing on a A.

Answers

1. 22.2
2. 20
3. 10
4. 20
5. 25
6. 10
7. 30
8. 25
9. 37.5
10. 22.2
11. 28.6
12. 40

1-10	92	83	75	67	58	50	42	33	25	17
11-12	8	0								

Determining Spinner Percent Chance

Name:

Solve each problem. Round your answer to the nearest tenth.

1)

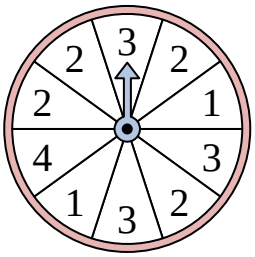

The spinner has a _____% chance of landing on a 2.

2)

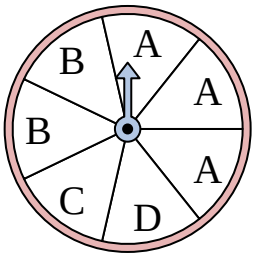

The spinner has a _____% chance of landing on a D.

3)

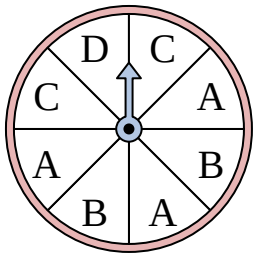

The spinner has a _____% chance of landing on a A.

4)

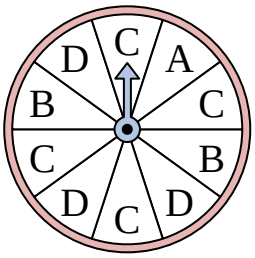

The spinner has a _____% chance of landing on a D.

5)

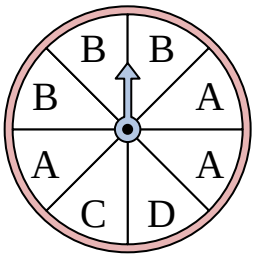

The spinner has a _____% chance of landing on a D.

6)

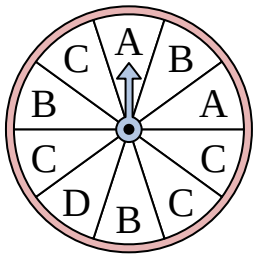

The spinner has a _____% chance of landing on a B.

7)

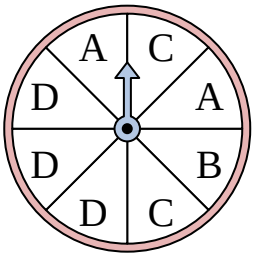

The spinner has a _____% chance of landing on a D.

8)

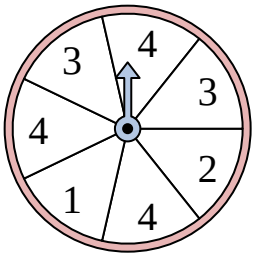

The spinner has a _____% chance of landing on a 2.

9)

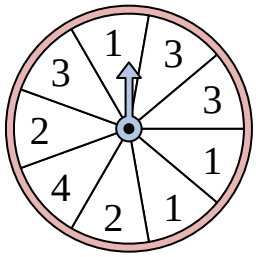

The spinner has a _____% chance of landing on a 1.

10)

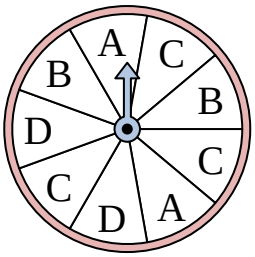

The spinner has a _____% chance of landing on a C.

11)

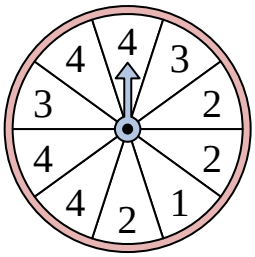

The spinner has a _____% chance of landing on a 4.

12)

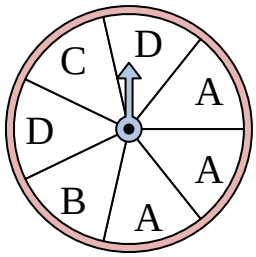

The spinner has a _____% chance of landing on a D.

Answers

1. _____
2. _____
3. _____
4. _____
5. _____
6. _____
7. _____
8. _____
9. _____
10. _____
11. _____
12. _____

1-10	92	83	75	67	58	50	42	33	25	17
11-12	8	0								

Determining Spinner Percent Chance

Name: **Answer Key**

Solve each problem. Round your answer to the nearest tenth.

1)

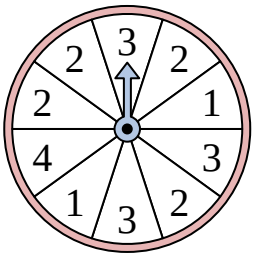

The spinner has a _____% chance of landing on a 2.

2)

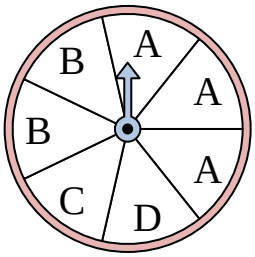

The spinner has a _____% chance of landing on a D.

3)

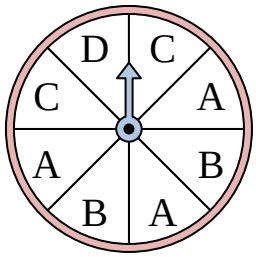

The spinner has a _____% chance of landing on a A.

4)

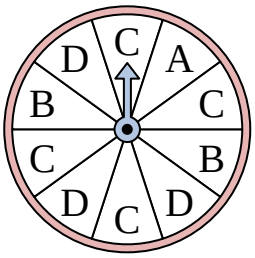

The spinner has a _____% chance of landing on a D.

5)

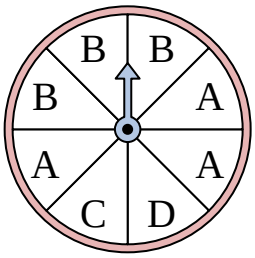

The spinner has a _____% chance of landing on a D.

6)

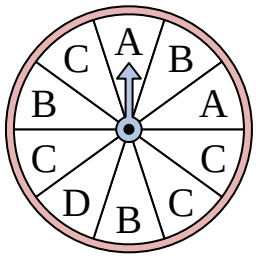

The spinner has a _____% chance of landing on a B.

7)

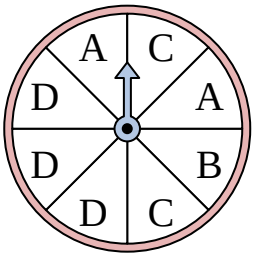

The spinner has a _____% chance of landing on a D.

8)

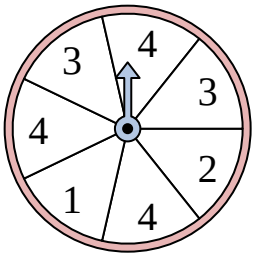

The spinner has a _____% chance of landing on a 2.

9)

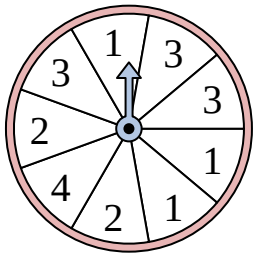

The spinner has a _____% chance of landing on a 1.

10)

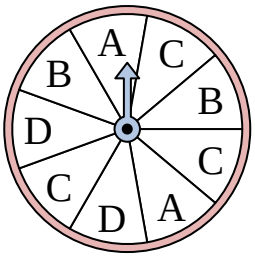

The spinner has a _____% chance of landing on a C.

11)

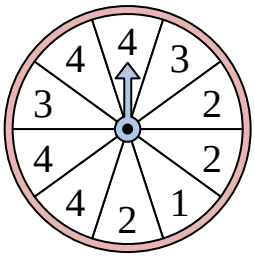

The spinner has a _____% chance of landing on a 4.

12)

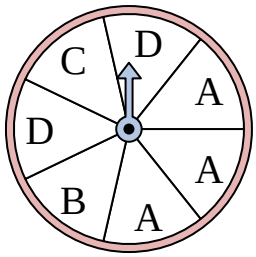

The spinner has a _____% chance of landing on a D.

Answers

1. 40
2. 14.3
3. 37.5
4. 30
5. 12.5
6. 30
7. 37.5
8. 14.3
9. 33.3
10. 33.3
11. 40
12. 28.6

1-10	92	83	75	67	58	50	42	33	25	17
11-12	8	0								

Determining Spinner Percent Chance

Name:

Solve each problem. Round your answer to the nearest tenth.

1)

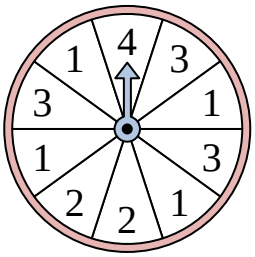

The spinner has a _____% chance of landing on a 3.

2)

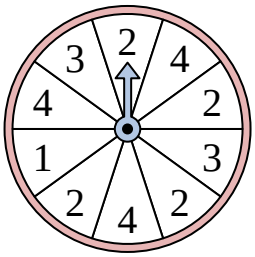

The spinner has a _____% chance of landing on a 3.

3)

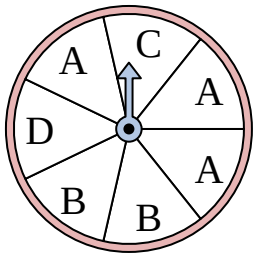

The spinner has a _____% chance of landing on a A.

4)

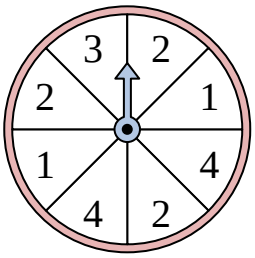

The spinner has a _____% chance of landing on a 2.

5)

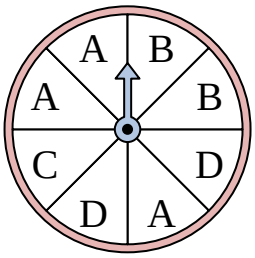

The spinner has a _____% chance of landing on a C.

6)

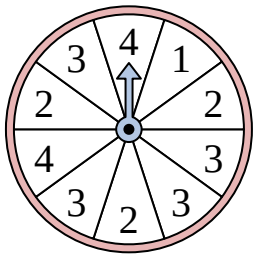

The spinner has a _____% chance of landing on a 3.

7)

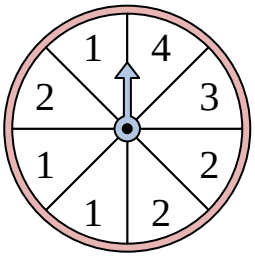

The spinner has a _____% chance of landing on a 2.

8)

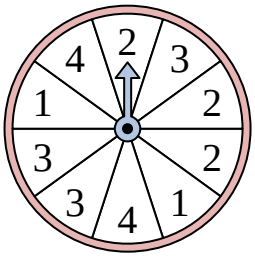

The spinner has a _____% chance of landing on a 3.

9)

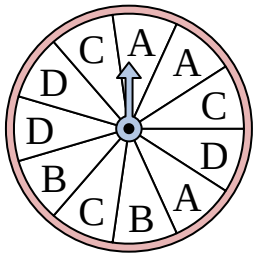

The spinner has a _____% chance of landing on a C.

10)

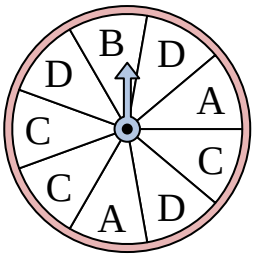

The spinner has a _____% chance of landing on a B.

11)

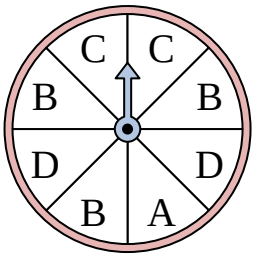

The spinner has a _____% chance of landing on a C.

12)

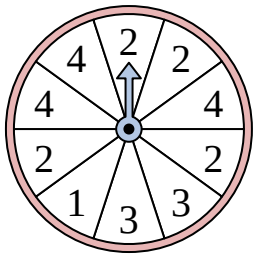

The spinner has a _____% chance of landing on a 4.

Answers

1. _____
2. _____
3. _____
4. _____
5. _____
6. _____
7. _____
8. _____
9. _____
10. _____
11. _____
12. _____

1-10	92	83	75	67	58	50	42	33	25	17
11-12	8	0								

Determining Spinner Percent Chance

Name: **Answer Key**

Solve each problem. Round your answer to the nearest tenth.

1)

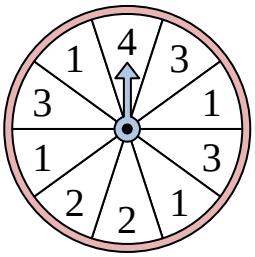

The spinner has a _____% chance of landing on a 3.

2)

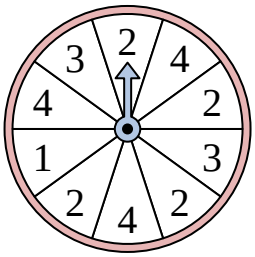

The spinner has a _____% chance of landing on a 3.

3)

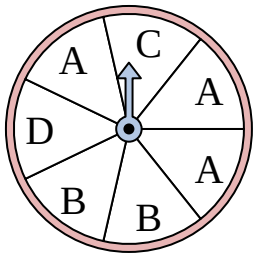

The spinner has a _____% chance of landing on a A.

4)

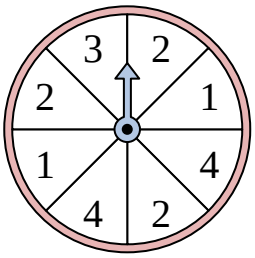

The spinner has a _____% chance of landing on a 2.

5)

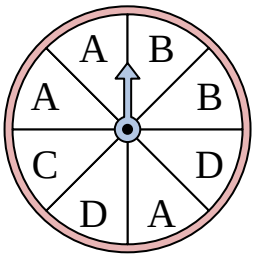

The spinner has a _____% chance of landing on a C.

6)

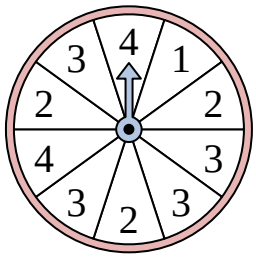

The spinner has a _____% chance of landing on a 3.

7)

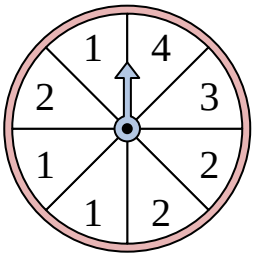

The spinner has a _____% chance of landing on a 2.

8)

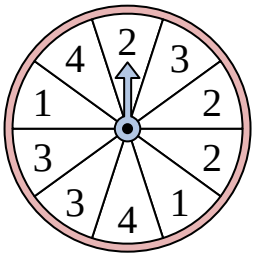

The spinner has a _____% chance of landing on a 3.

9)

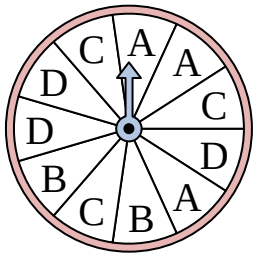

The spinner has a _____% chance of landing on a C.

10)

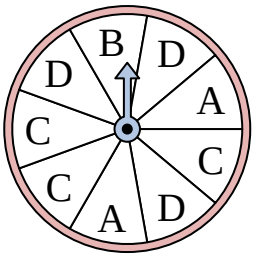

The spinner has a _____% chance of landing on a B.

11)

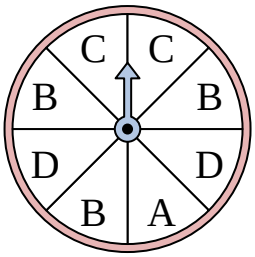

The spinner has a _____% chance of landing on a C.

12)

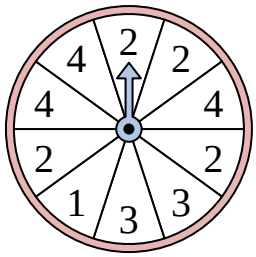

The spinner has a _____% chance of landing on a 4.

Answers

1. 30
2. 20
3. 42.9
4. 37.5
5. 12.5
6. 40
7. 37.5
8. 30
9. 27.3
10. 11.1
11. 25
12. 30

1-10	92	83	75	67	58	50	42	33	25	17
11-12	8	0								

Determining Spinner Percent Chance

Name:

Solve each problem. Round your answer to the nearest tenth.

1)

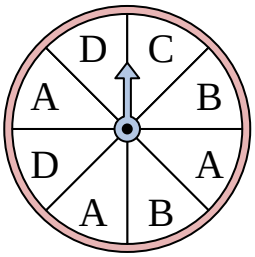

The spinner has a _____% chance of landing on a C.

2)

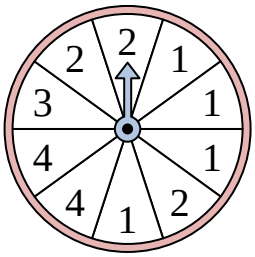

The spinner has a _____% chance of landing on a 3.

3)

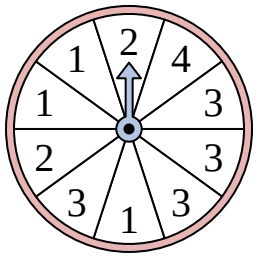

The spinner has a _____% chance of landing on a 4.

4)

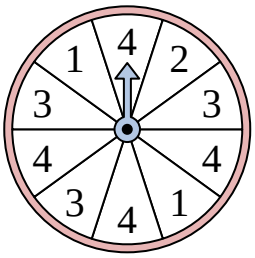

The spinner has a _____% chance of landing on a 4.

5)

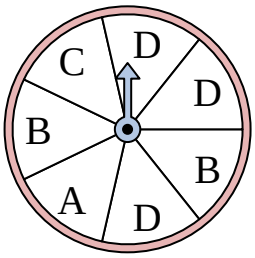

The spinner has a _____% chance of landing on a C.

6)

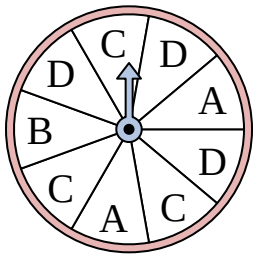

The spinner has a _____% chance of landing on a C.

7)

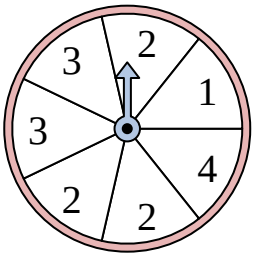

The spinner has a _____% chance of landing on a 2.

8)

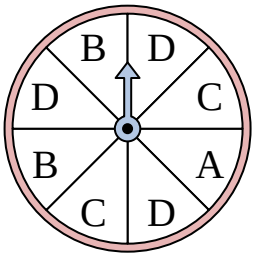

The spinner has a _____% chance of landing on a D.

9)

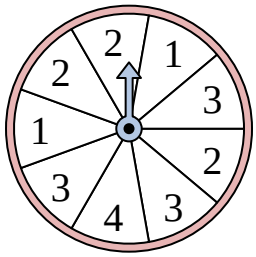

The spinner has a _____% chance of landing on a 4.

10)

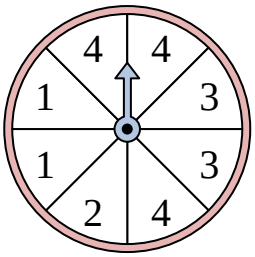

The spinner has a _____% chance of landing on a 4.

11)

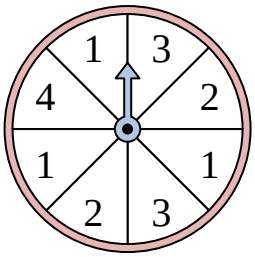

The spinner has a _____% chance of landing on a 4.

12)

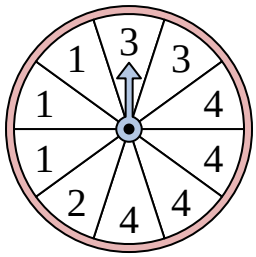

The spinner has a _____% chance of landing on a 1.

Answers

1. _____
2. _____
3. _____
4. _____
5. _____
6. _____
7. _____
8. _____
9. _____
10. _____
11. _____
12. _____

1-10	92	83	75	67	58	50	42	33	25	17
11-12	8	0								

Determining Spinner Percent Chance

Name: **Answer Key**

Solve each problem. Round your answer to the nearest tenth.

1)

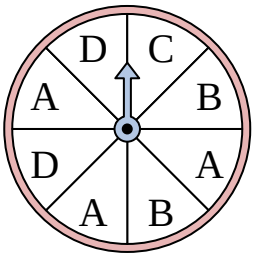

The spinner has a _____% chance of landing on a C.

2)

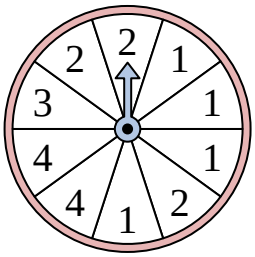

The spinner has a _____% chance of landing on a 3.

3)

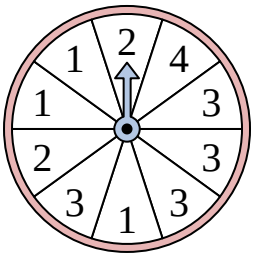

The spinner has a _____% chance of landing on a 4.

4)

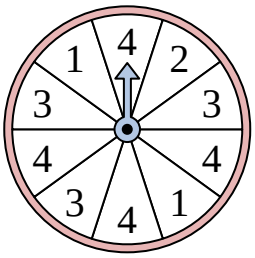

The spinner has a _____% chance of landing on a 4.

5)

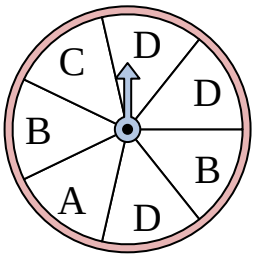

The spinner has a _____% chance of landing on a C.

6)

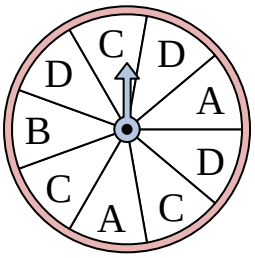

The spinner has a _____% chance of landing on a C.

7)

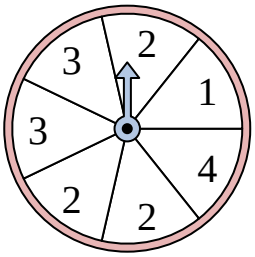

The spinner has a _____% chance of landing on a 2.

8)

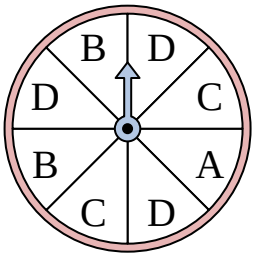

The spinner has a _____% chance of landing on a D.

9)

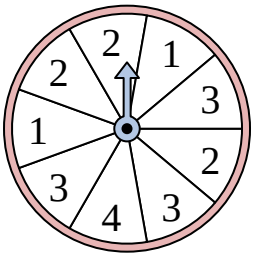

The spinner has a _____% chance of landing on a 4.

10)

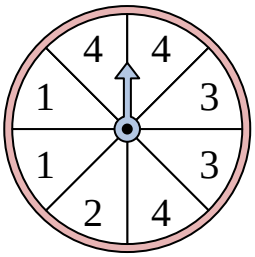

The spinner has a _____% chance of landing on a 4.

11)

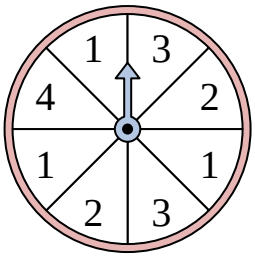

The spinner has a _____% chance of landing on a 4.

12)

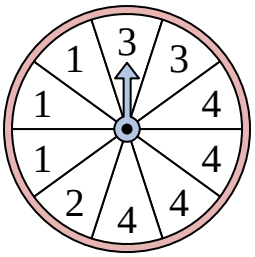

The spinner has a _____% chance of landing on a 1.

Answers

1. 12.5
2. 10
3. 10
4. 40
5. 14.3
6. 33.3
7. 42.9
8. 37.5
9. 11.1
10. 37.5
11. 12.5
12. 30

1-10	92	83	75	67	58	50	42	33	25	17
11-12	8	0								

Determining Spinner Percent Chance

Name:

Solve each problem. Round your answer to the nearest tenth.

1)

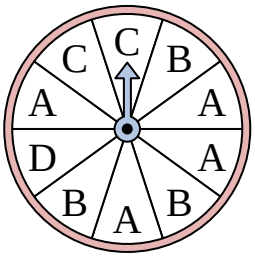

The spinner has a _____% chance of landing on a B.

2)

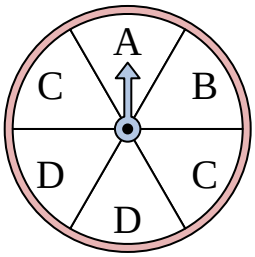

The spinner has a _____% chance of landing on a B.

3)

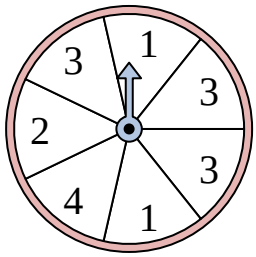

The spinner has a _____% chance of landing on a 2.

4)

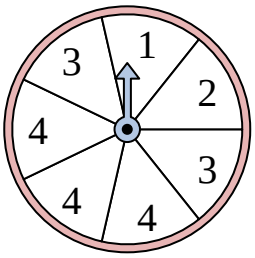

The spinner has a _____% chance of landing on a 4.

5)



The spinner has a _____% chance of landing on a 2.

6)

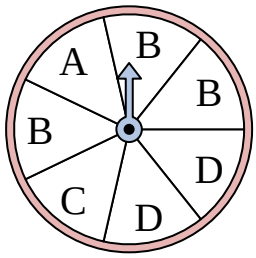

The spinner has a _____% chance of landing on a C.

7)

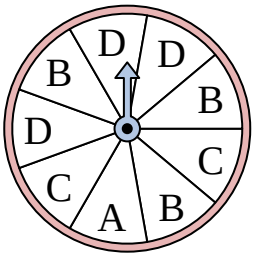

The spinner has a _____% chance of landing on a A.

8)

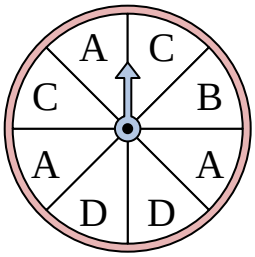

The spinner has a _____% chance of landing on a C.

9)

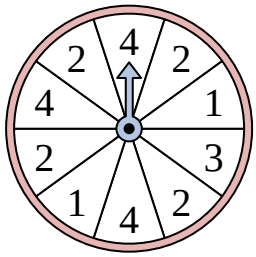

The spinner has a _____% chance of landing on a 2.

10)

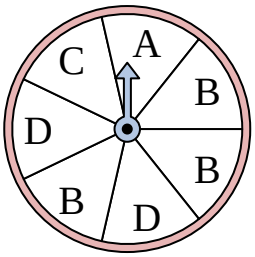

The spinner has a _____% chance of landing on a C.

11)

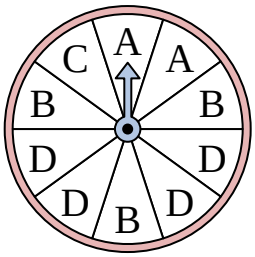

The spinner has a _____% chance of landing on a A.

12)



The spinner has a _____% chance of landing on a 2.

Answers

1. _____
2. _____
3. _____
4. _____
5. _____
6. _____
7. _____
8. _____
9. _____
10. _____
11. _____
12. _____

1-10	92	83	75	67	58	50	42	33	25	17
11-12	8	0								

Determining Spinner Percent Chance

Name: **Answer Key**

Solve each problem. Round your answer to the nearest tenth.

1)

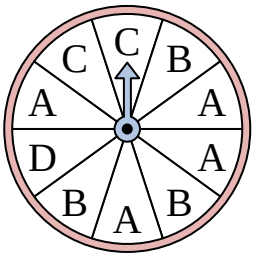

The spinner has a _____% chance of landing on a B.

2)

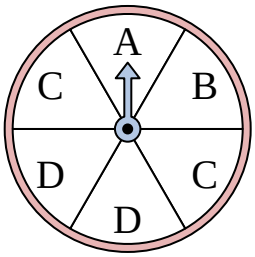

The spinner has a _____% chance of landing on a B.

3)

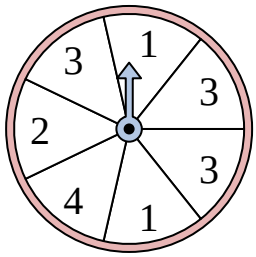

The spinner has a _____% chance of landing on a 2.

4)

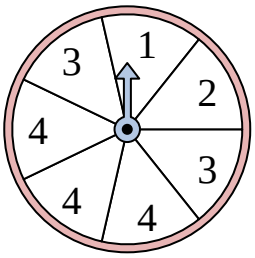

The spinner has a _____% chance of landing on a 4.

5)



The spinner has a _____% chance of landing on a 2.

6)

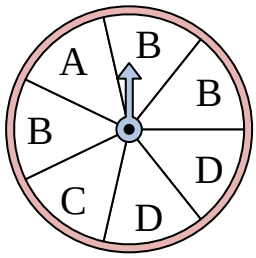

The spinner has a _____% chance of landing on a C.

7)

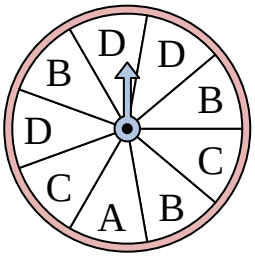

The spinner has a _____% chance of landing on a A.

8)

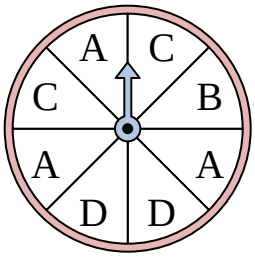

The spinner has a _____% chance of landing on a C.

9)

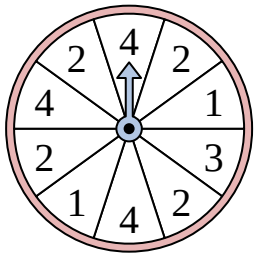

The spinner has a _____% chance of landing on a 2.

10)

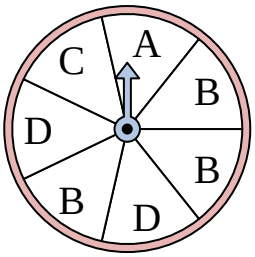

The spinner has a _____% chance of landing on a C.

11)

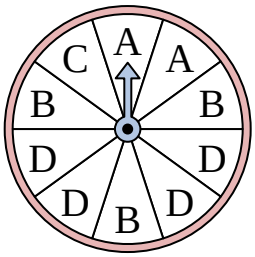

The spinner has a _____% chance of landing on a A.

12)



The spinner has a _____% chance of landing on a 2.

Answers

1. 30
2. 16.7
3. 14.3
4. 42.9
5. 30
6. 14.3
7. 11.1
8. 25
9. 40
10. 14.3
11. 20
12. 18.2

1-10	92	83	75	67	58	50	42	33	25	17
11-12	8	0								

Determining Spinner Percent Chance

Name:

Solve each problem. Round your answer to the nearest tenth.

1)

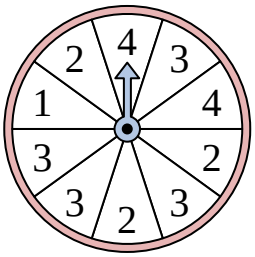

The spinner has a _____% chance of landing on a 2.

2)

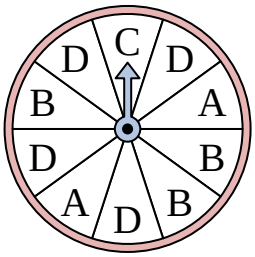

The spinner has a _____% chance of landing on a D.

3)

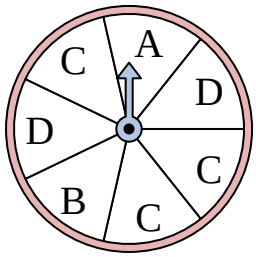

The spinner has a _____% chance of landing on a C.

4)

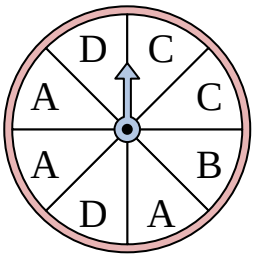

The spinner has a _____% chance of landing on a A.

5)

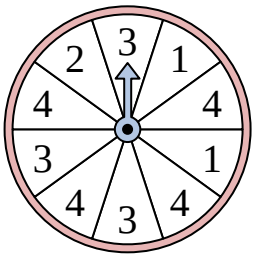

The spinner has a _____% chance of landing on a 2.

6)

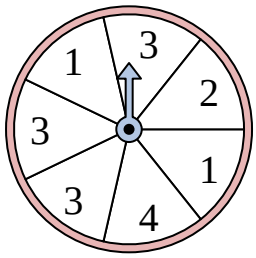

The spinner has a _____% chance of landing on a 2.

7)

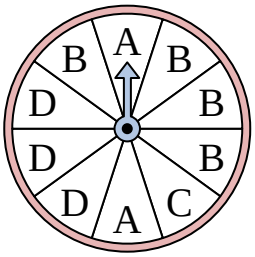

The spinner has a _____% chance of landing on a B.

8)

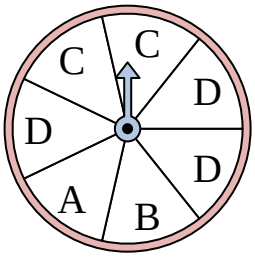

The spinner has a _____% chance of landing on a C.

9)

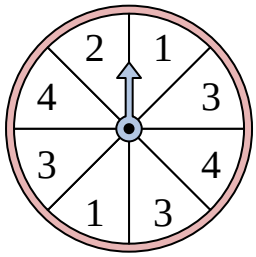

The spinner has a _____% chance of landing on a 1.

10)

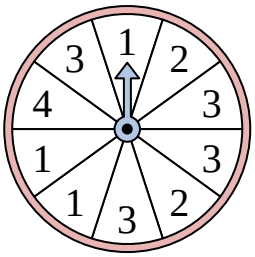

The spinner has a _____% chance of landing on a 4.

11)

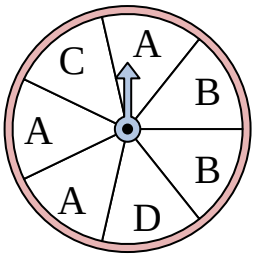

The spinner has a _____% chance of landing on a D.

12)

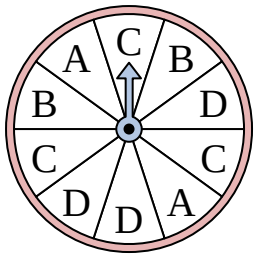

The spinner has a _____% chance of landing on a C.

Answers

1. _____
2. _____
3. _____
4. _____
5. _____
6. _____
7. _____
8. _____
9. _____
10. _____
11. _____
12. _____

1-10	92	83	75	67	58	50	42	33	25	17
11-12	8	0								

Determining Spinner Percent Chance

Name: **Answer Key**

Solve each problem. Round your answer to the nearest tenth.

1)

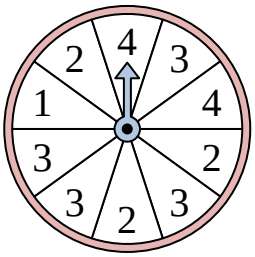

The spinner has a _____% chance of landing on a 2.

2)

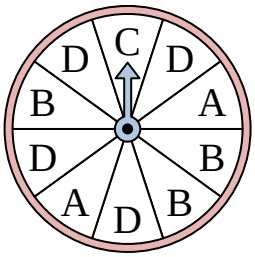

The spinner has a _____% chance of landing on a D.

3)

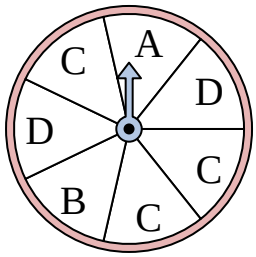

The spinner has a _____% chance of landing on a C.

4)

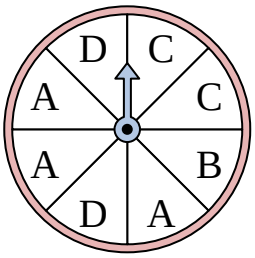

The spinner has a _____% chance of landing on a A.

5)

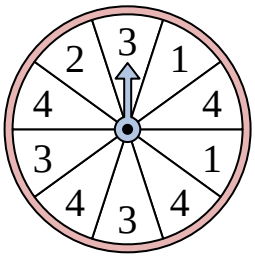

The spinner has a _____% chance of landing on a 2.

6)

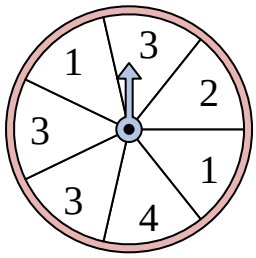

The spinner has a _____% chance of landing on a 2.

7)

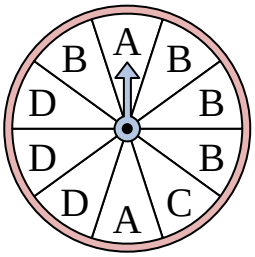

The spinner has a _____% chance of landing on a B.

8)

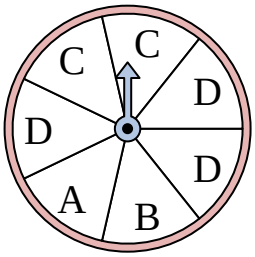

The spinner has a _____% chance of landing on a C.

9)

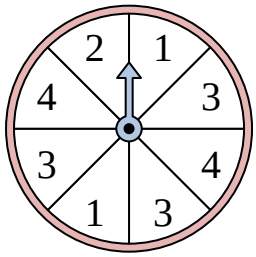

The spinner has a _____% chance of landing on a 1.

10)

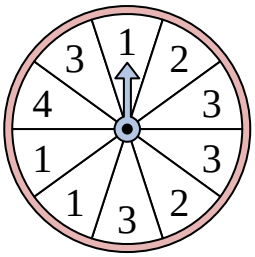

The spinner has a _____% chance of landing on a 4.

11)

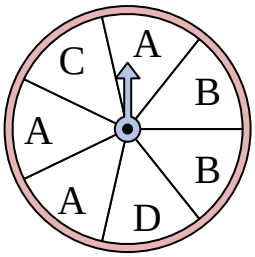

The spinner has a _____% chance of landing on a D.

12)

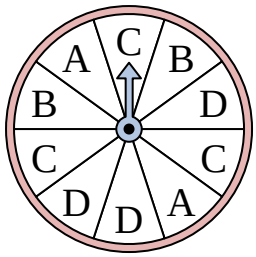

The spinner has a _____% chance of landing on a C.

Answers

1. 30
2. 40
3. 42.9
4. 37.5
5. 10
6. 14.3
7. 40
8. 28.6
9. 25
10. 10
11. 14.3
12. 30

1-10	92	83	75	67	58	50	42	33	25	17
11-12	8	0								

Determining Spinner Percent Chance

Name:

Solve each problem. Round your answer to the nearest tenth.

1)

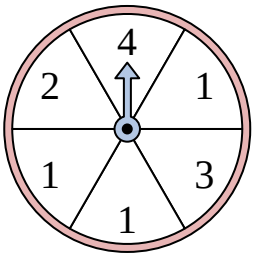

The spinner has a _____% chance of landing on a 2.

2)

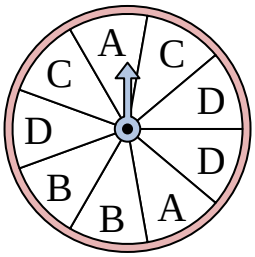

The spinner has a _____% chance of landing on a B.

3)

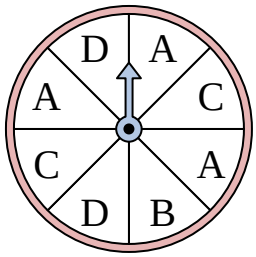

The spinner has a _____% chance of landing on a C.

4)

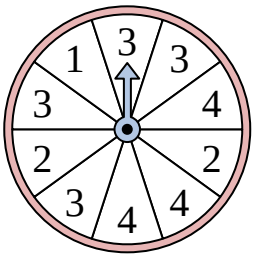

The spinner has a _____% chance of landing on a 3.

5)

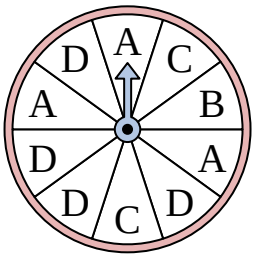

The spinner has a _____% chance of landing on a D.

6)

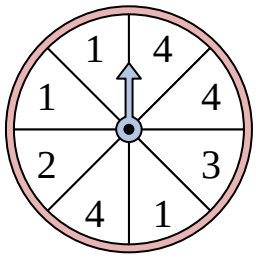

The spinner has a _____% chance of landing on a 4.

7)

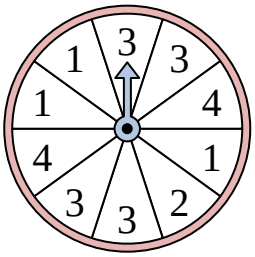

The spinner has a _____% chance of landing on a 4.

8)

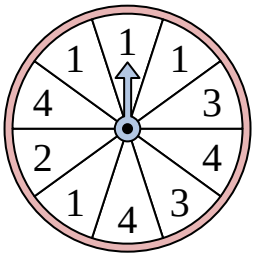

The spinner has a _____% chance of landing on a 1.

9)

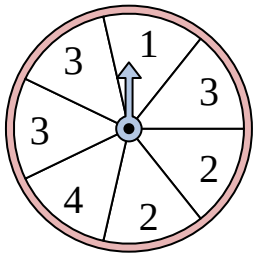

The spinner has a _____% chance of landing on a 3.

10)

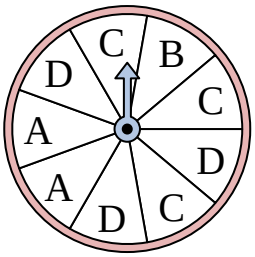

The spinner has a _____% chance of landing on a C.

11)

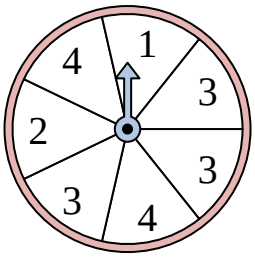

The spinner has a _____% chance of landing on a 2.

12)

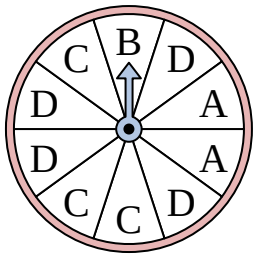

The spinner has a _____% chance of landing on a D.

Answers

1. _____
2. _____
3. _____
4. _____
5. _____
6. _____
7. _____
8. _____
9. _____
10. _____
11. _____
12. _____

1-10	92	83	75	67	58	50	42	33	25	17
11-12	8	0								

Determining Spinner Percent Chance

Name: **Answer Key**

Solve each problem. Round your answer to the nearest tenth.

1)

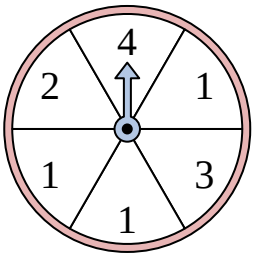

The spinner has a _____% chance of landing on a 2.

2)

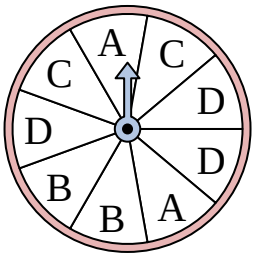

The spinner has a _____% chance of landing on a B.

3)

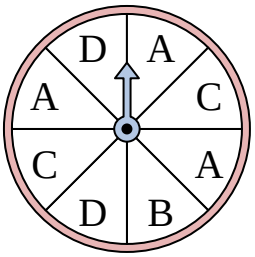

The spinner has a _____% chance of landing on a C.

4)

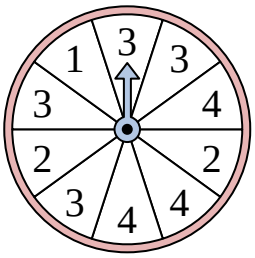

The spinner has a _____% chance of landing on a 3.

5)

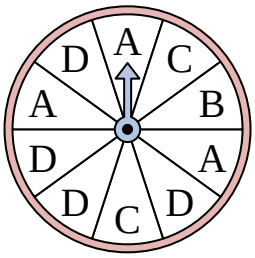

The spinner has a _____% chance of landing on a D.

6)

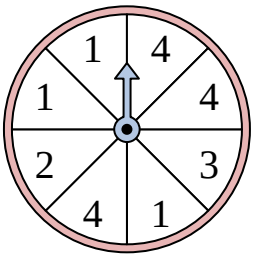

The spinner has a _____% chance of landing on a 4.

7)

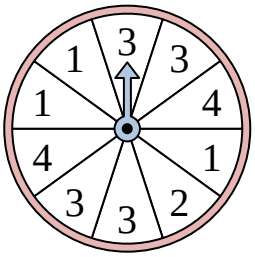

The spinner has a _____% chance of landing on a 4.

8)

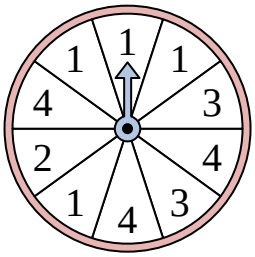

The spinner has a _____% chance of landing on a 1.

9)

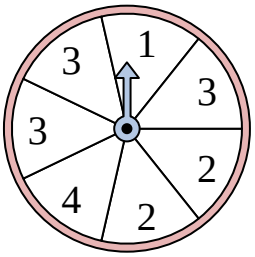

The spinner has a _____% chance of landing on a 3.

10)

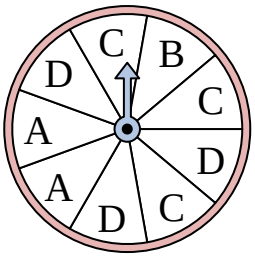

The spinner has a _____% chance of landing on a C.

11)

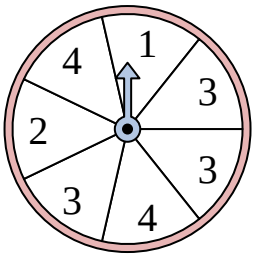

The spinner has a _____% chance of landing on a 2.

12)

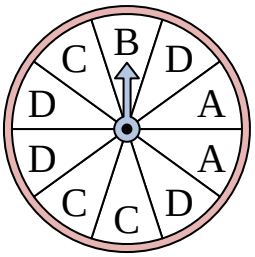

The spinner has a _____% chance of landing on a D.

Answers

1. **16.7**
2. **22.2**
3. **25**
4. **40**
5. **40**
6. **37.5**
7. **20**
8. **40**
9. **42.9**
10. **33.3**
11. **14.3**
12. **40**

1-10	92	83	75	67	58	50	42	33	25	17
11-12	8	0								

Determining Spinner Percent Chance

Name:

Solve each problem. Round your answer to the nearest tenth.

1)

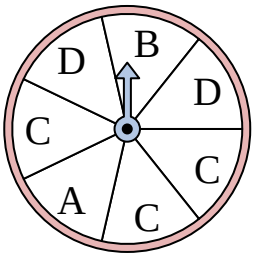

The spinner has a _____% chance of landing on a D.

2)

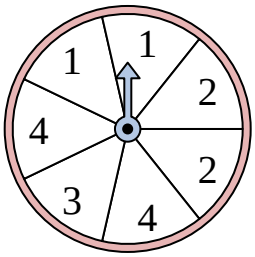

The spinner has a _____% chance of landing on a 3.

3)

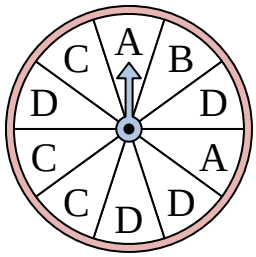

The spinner has a _____% chance of landing on a B.

4)

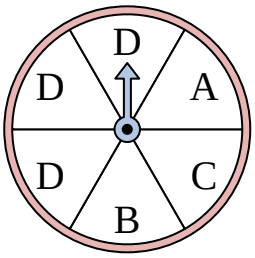

The spinner has a _____% chance of landing on a B.

5)

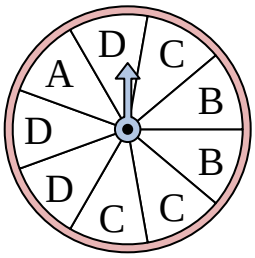

The spinner has a _____% chance of landing on a C.

6)

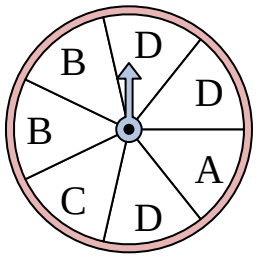

The spinner has a _____% chance of landing on a B.

7)

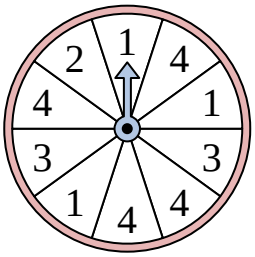

The spinner has a _____% chance of landing on a 4.

8)

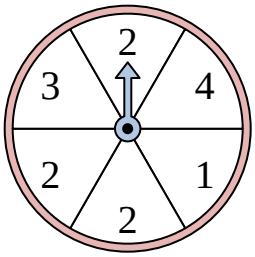

The spinner has a _____% chance of landing on a 1.

9)

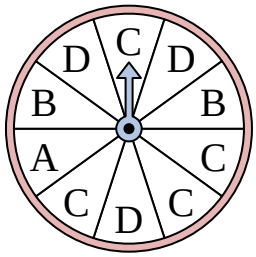

The spinner has a _____% chance of landing on a C.

10)

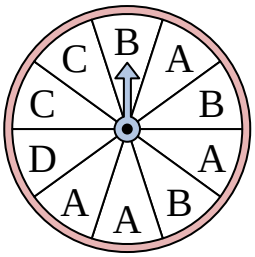

The spinner has a _____% chance of landing on a D.

11)

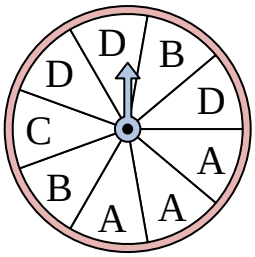

The spinner has a _____% chance of landing on a B.

12)

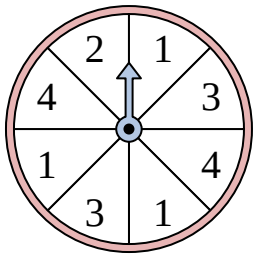

The spinner has a _____% chance of landing on a 4.

Answers

1. _____
2. _____
3. _____
4. _____
5. _____
6. _____
7. _____
8. _____
9. _____
10. _____
11. _____
12. _____

1-10	92	83	75	67	58	50	42	33	25	17
11-12	8	0								

Determining Spinner Percent Chance

Name: **Answer Key**

Solve each problem. Round your answer to the nearest tenth.

1)

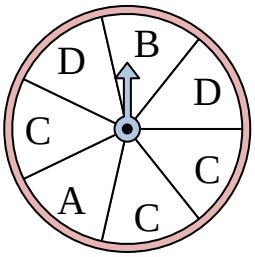

The spinner has a _____% chance of landing on a D.

2)

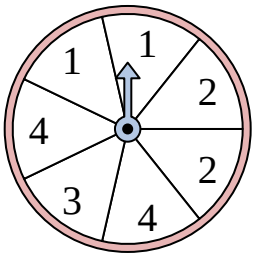

The spinner has a _____% chance of landing on a 3.

3)

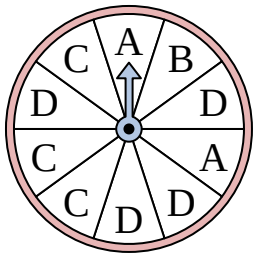

The spinner has a _____% chance of landing on a B.

4)

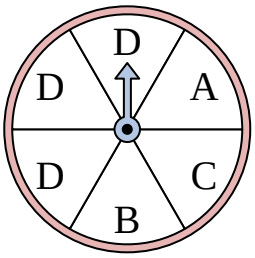

The spinner has a _____% chance of landing on a B.

5)

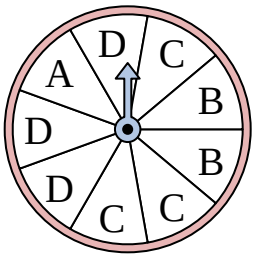

The spinner has a _____% chance of landing on a C.

6)

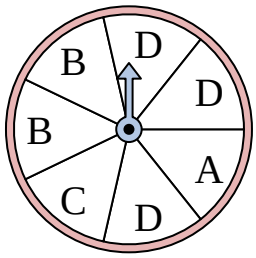

The spinner has a _____% chance of landing on a B.

7)

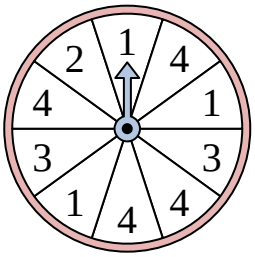

The spinner has a _____% chance of landing on a 4.

8)

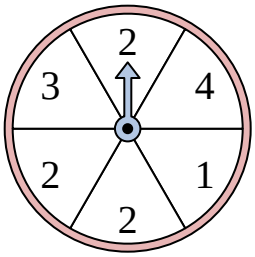

The spinner has a _____% chance of landing on a 1.

9)

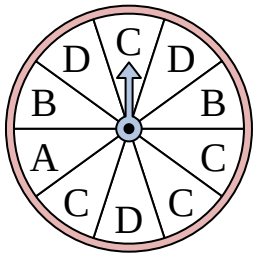

The spinner has a _____% chance of landing on a C.

10)

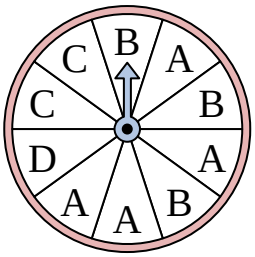

The spinner has a _____% chance of landing on a D.

11)

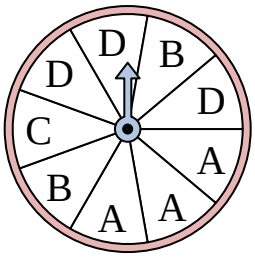

The spinner has a _____% chance of landing on a B.

12)

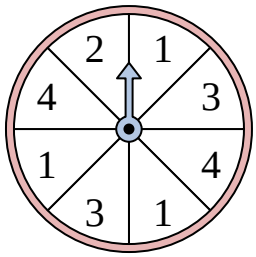

The spinner has a _____% chance of landing on a 4.

Answers

1. 28.6
2. 14.3
3. 10
4. 16.7
5. 33.3
6. 28.6
7. 40
8. 16.7
9. 40
10. 10
11. 22.2
12. 25

1-10	92	83	75	67	58	50	42	33	25	17
11-12	8	0								