Finding Radicals on a Numberline

Name:

Determine which letter on the numberline best represents the radical.

1) $\sqrt{119}$

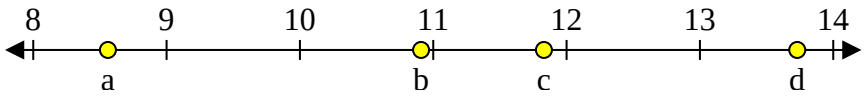

2) $\sqrt{81}$

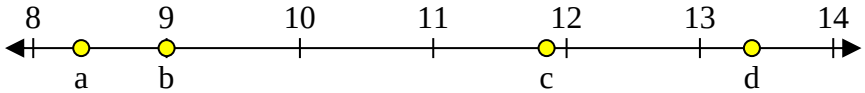

3) $\sqrt{24}$

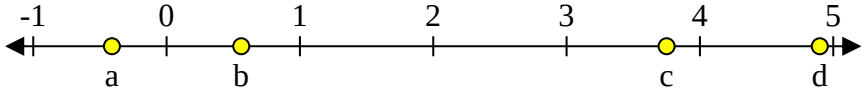

4) $\sqrt{96}$

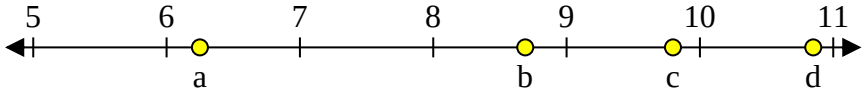

5) $\sqrt{93}$

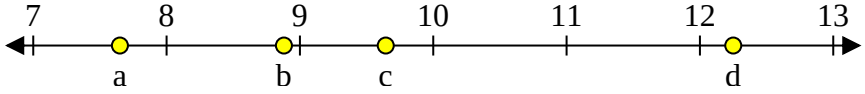

6) $\sqrt{132}$

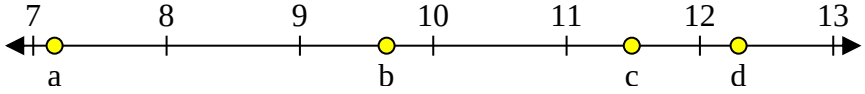

7) $\sqrt{17}$

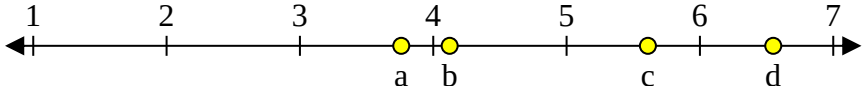

8) $\sqrt{117}$

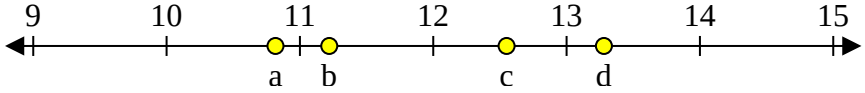

9) $\sqrt{21}$

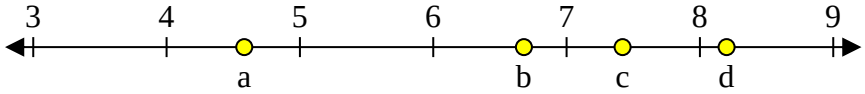

10) $\sqrt{97}$

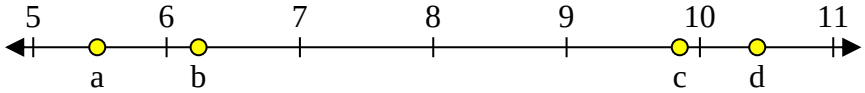

Answers

1. _____
2. _____
3. _____
4. _____
5. _____
6. _____
7. _____
8. _____
9. _____
10. _____

1-10	90	80	70	60	50	40	30	20	10	0

Finding Radicals on a Numberline

Name: **Answer Key**

Determine which letter on the numberline best represents the radical.

1) $\sqrt{119}$

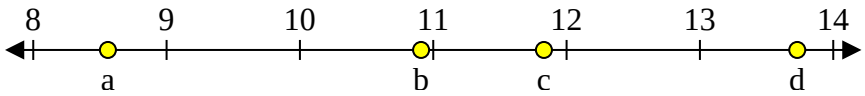

2) $\sqrt{81}$

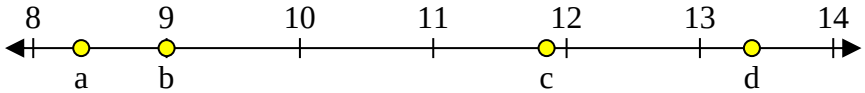

3) $\sqrt{24}$

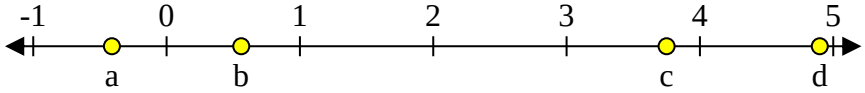

4) $\sqrt{96}$

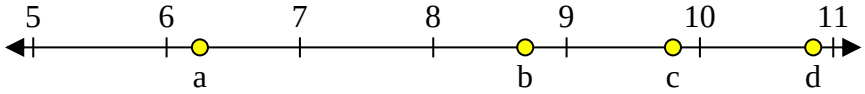

5) $\sqrt{93}$

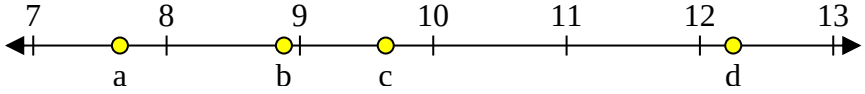

6) $\sqrt{132}$

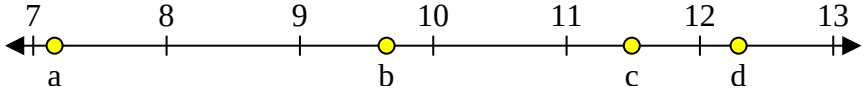

7) $\sqrt{17}$

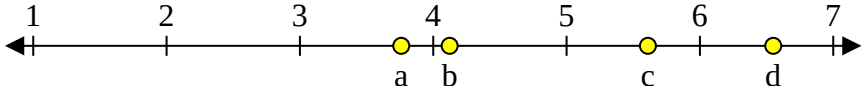

8) $\sqrt{117}$

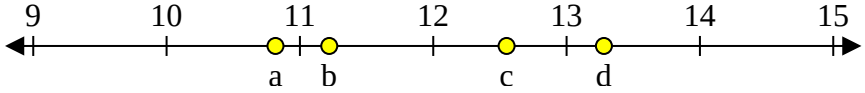

9) $\sqrt{21}$

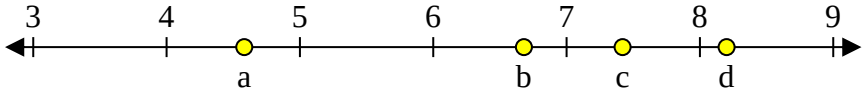

10) $\sqrt{97}$

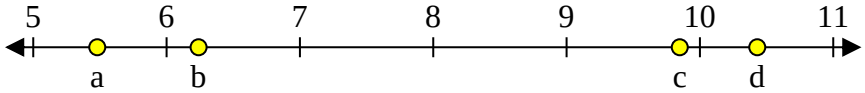

Answers

1. **b**
2. **b**
3. **d**
4. **c**
5. **c**
6. **c**
7. **b**
8. **a**
9. **a**
10. **c**

1-10	90	80	70	60	50	40	30	20	10	0