Identifying Coins

Name:

Count the number of quarters (25¢), dimes(10¢), nickels(5¢) and pennies(1¢).

Ex)

1)

2) 

3)

4)

5) 

6)

7)

8)

9)

10)

Answers

Ex.	1	1	4	3
1.				
2.				
3.				
4.				
5.				
6.				
7.				
8.				
9.				
10.				

1-10	90	80	70	60	50	40	30	20	10	0

Identifying Coins

Name: **Answer Key**

Count the number of quarters (25¢), dimes(10¢), nickels(5¢) and pennies(1¢).

Ex)

1)

2)



3)

4)

5)



6)

7)

8)

9)

10)

Answers

Ex.	1	1	4	3
1.	3	2	1	3
2.	3	2	2	2
3.	2	2	2	3
4.	1	3	3	2
5.	1	2	2	4
6.	2	2	3	2
7.	4	2	2	1
8.	3	3	1	2
9.	1	2	4	2
10.	1	2	3	3

1-10	90	80	70	60	50	40	30	20	10	0