Comparing Two Measurements Name:

Measure the width and height of each block in inches and in centimeters.

Ex)



1)

2)

3)



4)

Answers

Ex.	3	1	7.6	2.5
1.				
2.				
3.				
4.				

1-4	75	50	25	0

Measure the width and height of each block in inches and in centimeters.

Ex)



1)

2)

3)



4)

Answers

Ex.	3	1	7.6	2.5
1.	5	0 1/2	12.7	1.3
2.	1 1/2	0 1/2	3.8	1.3
3.	0 1/2	1	1.3	2.5
4.	4 1/2	0 1/2	11.4	1.3

1-4	75	50	25	0