Identifying Lines

Name:

Use 'parallel', 'perp'(perpendicular) or 'inter'(intersecting) to describe the lines.

1)

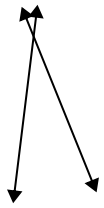

2)

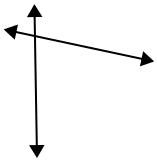

3)

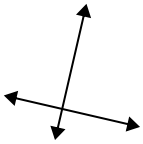

4)

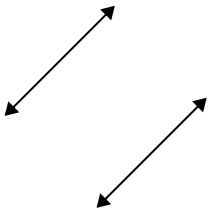

5)

6)

7)

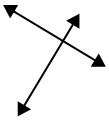

8)

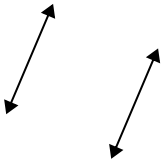

9)

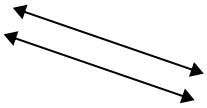

10)

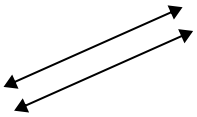

11)

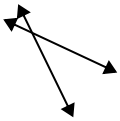

12)

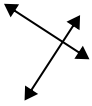

13)

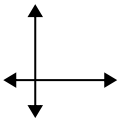

14)

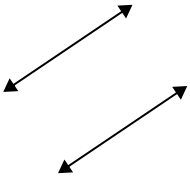

15)

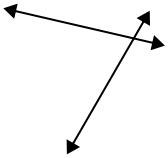

Answers

1. _____
2. _____
3. _____
4. _____
5. _____
6. _____
7. _____
8. _____
9. _____
10. _____
11. _____
12. _____
13. _____
14. _____
15. _____

1-10	93	87	80	73	67	60	53	47	40	33
11-15	27	20	13	7	0					

Identifying Lines

Name: **Answer Key**

Use 'parallel', 'perp'(perpendicular) or 'inter'(intersecting) to describe the lines.

1)

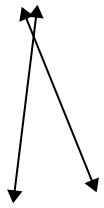

2)

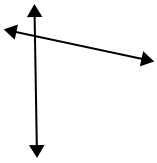

3)

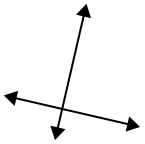

4)

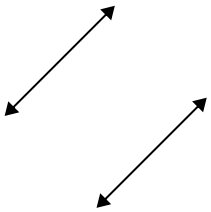

5)

6)

7)

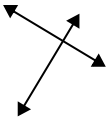

8)

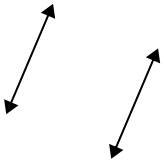

9)

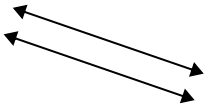

10)

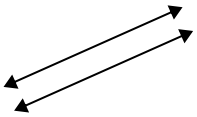

11)

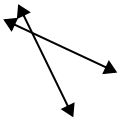

12)

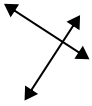

13)

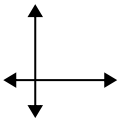

14)

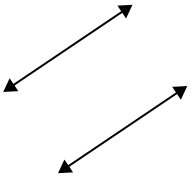

15)

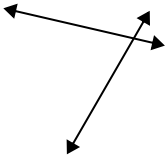

Answers

1. inter
2. inter
3. perp & inter
4. parallel
5. perp & inter
6. inter
7. perp & inter
8. parallel
9. parallel
10. parallel
11. inter
12. perp & inter
13. perp & inter
14. parallel
15. inter

1-10	93	87	80	73	67	60	53	47	40	33
11-15	27	20	13	7	0					