Writing Fractions

Name:

Write the shaded amount as a fraction of the whole amount.

1) 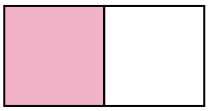

2) 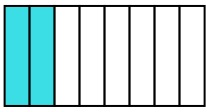

3) 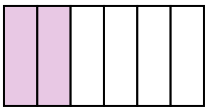

4) 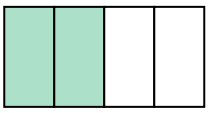

5) 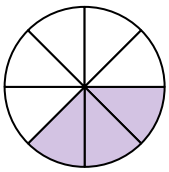

6) 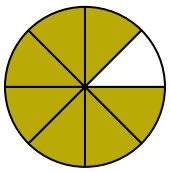

7) 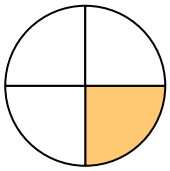

8) 

9) 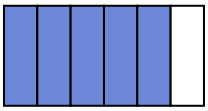

10) 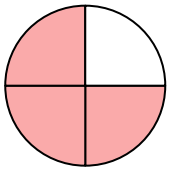

11) 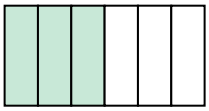

12) 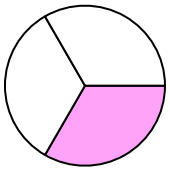

13) 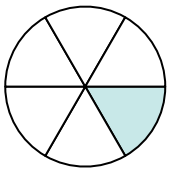

14) 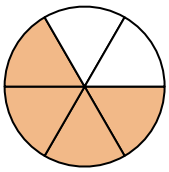

15) 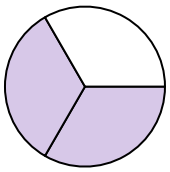

16) 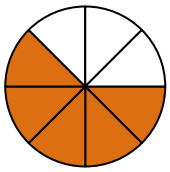

17) 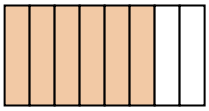

18) 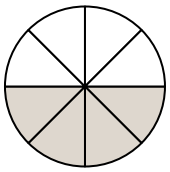

Answers

1. _____
2. _____
3. _____
4. _____
5. _____
6. _____
7. _____
8. _____
9. _____
10. _____
11. _____
12. _____
13. _____
14. _____
15. _____
16. _____
17. _____
18. _____

1-10	94	89	83	78	72	67	61	56	50	44
11-18	39	33	28	22	17	11	6	0		

Writing Fractions

Name: **Answer Key**

Write the shaded amount as a fraction of the whole amount.

1) 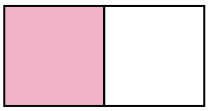

2) 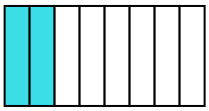

3) 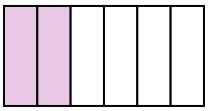

4) 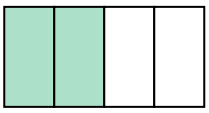

5) 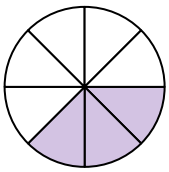

6) 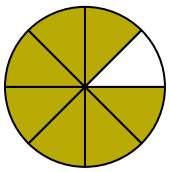

7) 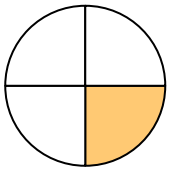

8) 

9) 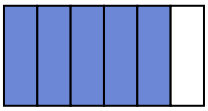

10) 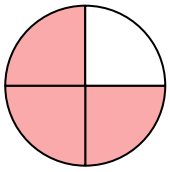

11) 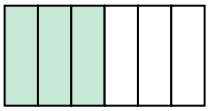

12) 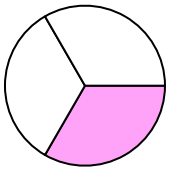

13) 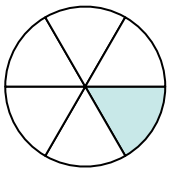

14) 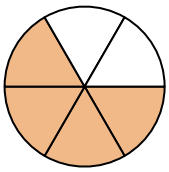

15) 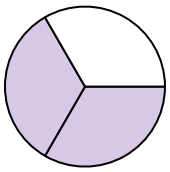

16) 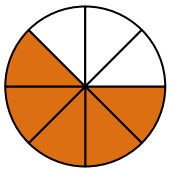

17) 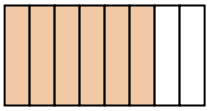

18) 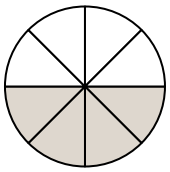

Answers

1. $\frac{1}{2}$
2. $\frac{2}{8}$
3. $\frac{2}{6}$
4. $\frac{2}{4}$
5. $\frac{3}{8}$
6. $\frac{7}{8}$
7. $\frac{1}{4}$
8. $\frac{1}{8}$
9. $\frac{5}{6}$
10. $\frac{3}{4}$
11. $\frac{3}{6}$
12. $\frac{1}{3}$
13. $\frac{1}{6}$
14. $\frac{4}{6}$
15. $\frac{2}{3}$
16. $\frac{5}{8}$
17. $\frac{6}{8}$
18. $\frac{4}{8}$

1-10	94	89	83	78	72	67	61	56	50	44
11-18	39	33	28	22	17	11	6	0		

Writing Fractions

Name:

Write the shaded amount as a fraction of the whole amount.

1) 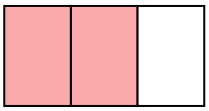

2) 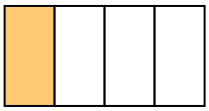

3) 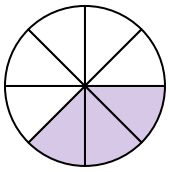

4) 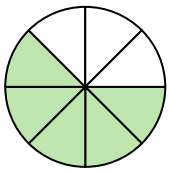

5) 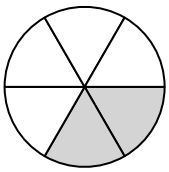

6) 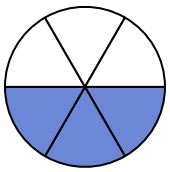

7) 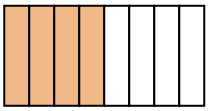

8) 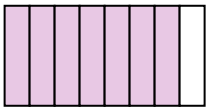

9) 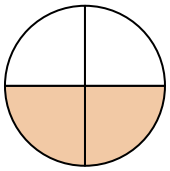

10) 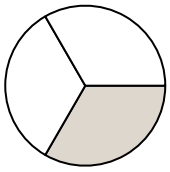

11)

12)

13) 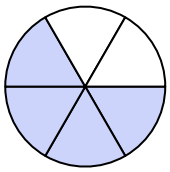

14) 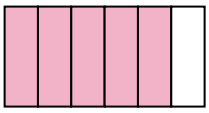

15) 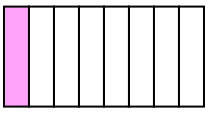

16) 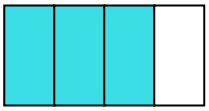

17) 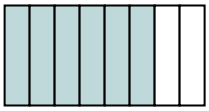

18) 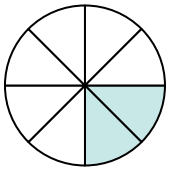

Answers

1. _____
2. _____
3. _____
4. _____
5. _____
6. _____
7. _____
8. _____
9. _____
10. _____
11. _____
12. _____
13. _____
14. _____
15. _____
16. _____
17. _____
18. _____

1-10	94	89	83	78	72	67	61	56	50	44
11-18	39	33	28	22	17	11	6	0		

Writing Fractions

Name: **Answer Key**

Write the shaded amount as a fraction of the whole amount.

1) 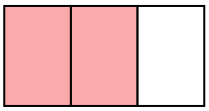

2) 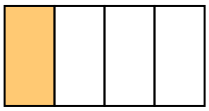

3) 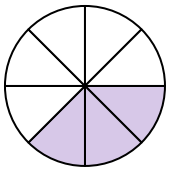

4) 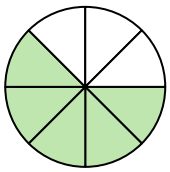

5) 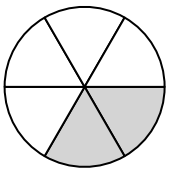

6) 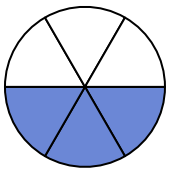

7) 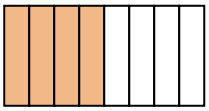

8) 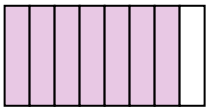

9) 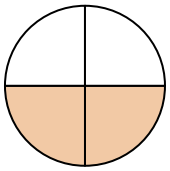

10) 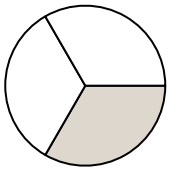

11)

12)

13) 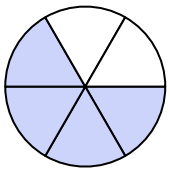

14) 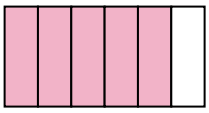

15) 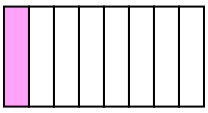

16) 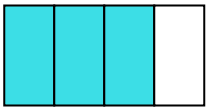

17) 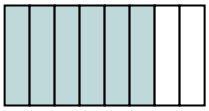

18) 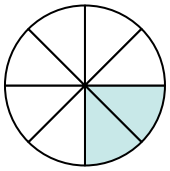

Answers

1. $\frac{2}{3}$
2. $\frac{1}{4}$
3. $\frac{3}{8}$
4. $\frac{5}{8}$
5. $\frac{2}{6}$
6. $\frac{3}{6}$
7. $\frac{4}{8}$
8. $\frac{7}{8}$
9. $\frac{2}{4}$
10. $\frac{1}{3}$
11. $\frac{1}{2}$
12. $\frac{1}{6}$
13. $\frac{4}{6}$
14. $\frac{5}{6}$
15. $\frac{1}{8}$
16. $\frac{3}{4}$
17. $\frac{6}{8}$
18. $\frac{2}{8}$

1-10	94	89	83	78	72	67	61	56	50	44
11-18	39	33	28	22	17	11	6	0		

Writing Fractions

Name:

Write the shaded amount as a fraction of the whole amount.

1)

2)

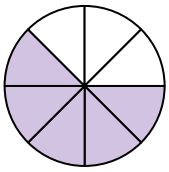

3)

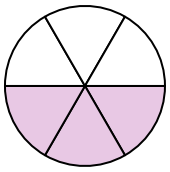

4)

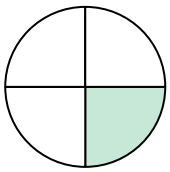

5)

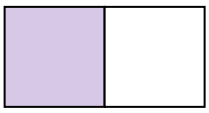

6)

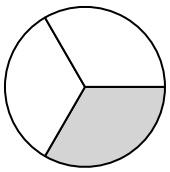

7)

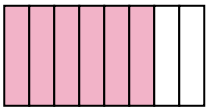

8)

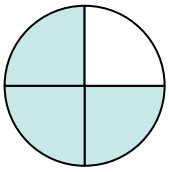

9)

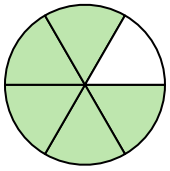

10)

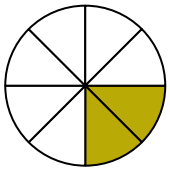

11)

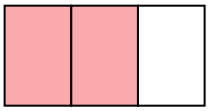

12)

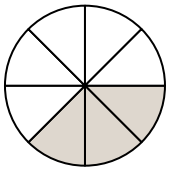

13)

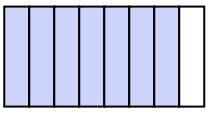

14)

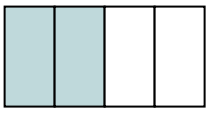

15)

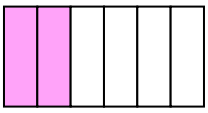

16)

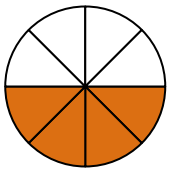

17)

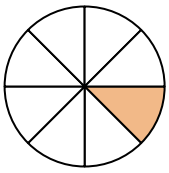

18)

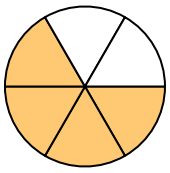

Answers

1. _____
2. _____
3. _____
4. _____
5. _____
6. _____
7. _____
8. _____
9. _____
10. _____
11. _____
12. _____
13. _____
14. _____
15. _____
16. _____
17. _____
18. _____

1-10	94	89	83	78	72	67	61	56	50	44
11-18	39	33	28	22	17	11	6	0		

Writing Fractions

Name: **Answer Key**

Write the shaded amount as a fraction of the whole amount.

1)

2) 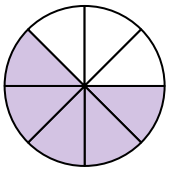

3) 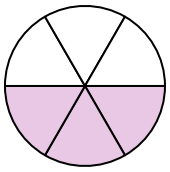

4) 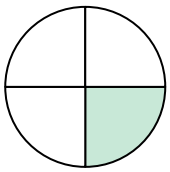

5) 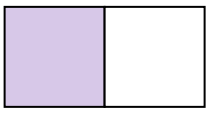

6) 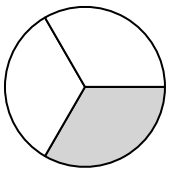

7) 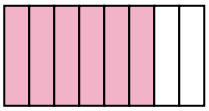

8) 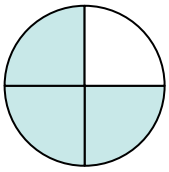

9) 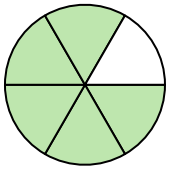

10) 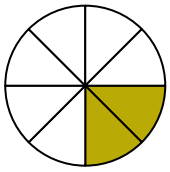

11) 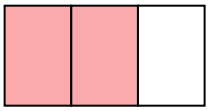

12) 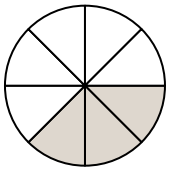

13) 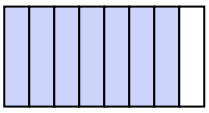

14) 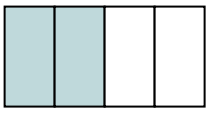

15) 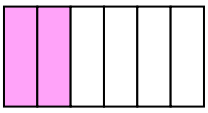

16) 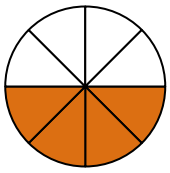

17) 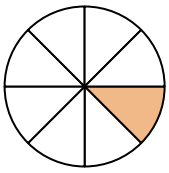

18) 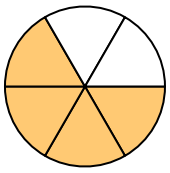

Answers

1. $\frac{1}{6}$
2. $\frac{5}{8}$
3. $\frac{3}{6}$
4. $\frac{1}{4}$
5. $\frac{1}{2}$
6. $\frac{1}{3}$
7. $\frac{6}{8}$
8. $\frac{3}{4}$
9. $\frac{5}{6}$
10. $\frac{2}{8}$
11. $\frac{2}{3}$
12. $\frac{3}{8}$
13. $\frac{7}{8}$
14. $\frac{2}{4}$
15. $\frac{2}{6}$
16. $\frac{4}{8}$
17. $\frac{1}{8}$
18. $\frac{4}{6}$

1-10	94	89	83	78	72	67	61	56	50	44
11-18	39	33	28	22	17	11	6	0		

Writing Fractions

Name:

Write the shaded amount as a fraction of the whole amount.

1)

2) 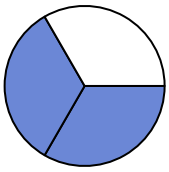

3) 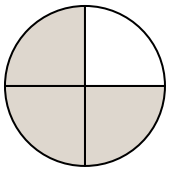

4) 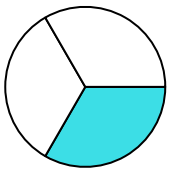

5) 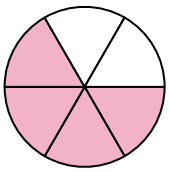

6) 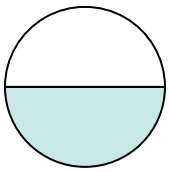

7) 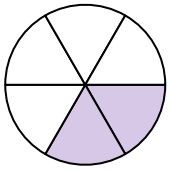

8) 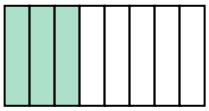

9)

10) 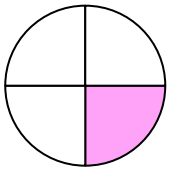

11)

12) 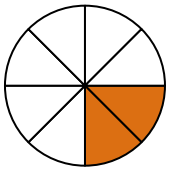

13) 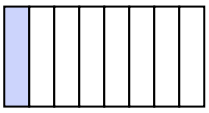

14) 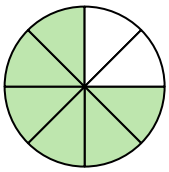

15) 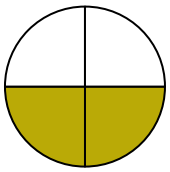

16) 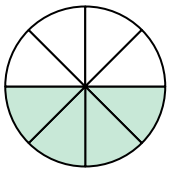

17) 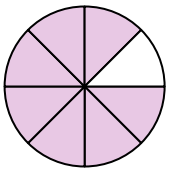

18) 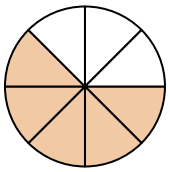

Answers

1. _____
2. _____
3. _____
4. _____
5. _____
6. _____
7. _____
8. _____
9. _____
10. _____
11. _____
12. _____
13. _____
14. _____
15. _____
16. _____
17. _____
18. _____

1-10	94	89	83	78	72	67	61	56	50	44
11-18	39	33	28	22	17	11	6	0		

Writing Fractions

Name: **Answer Key**

Write the shaded amount as a fraction of the whole amount.

1)

2) 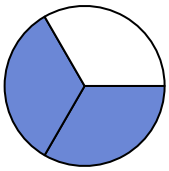

3) 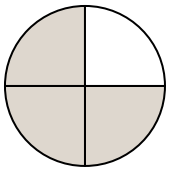

4) 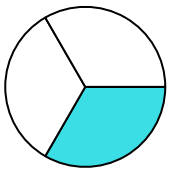

5) 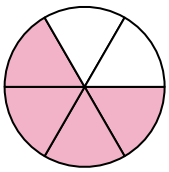

6) 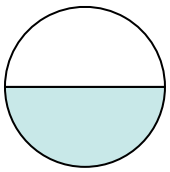

7) 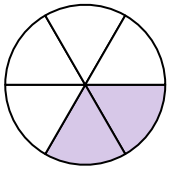

8) 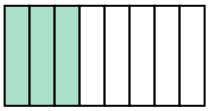

9)

10) 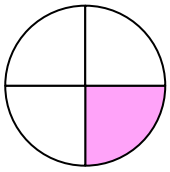

11)

12) 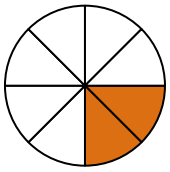

13) 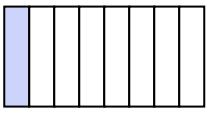

14) 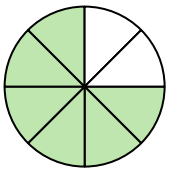

15) 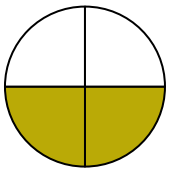

16) 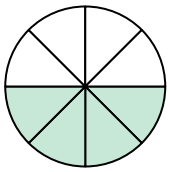

17) 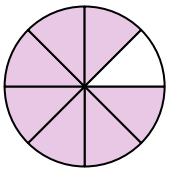

18) 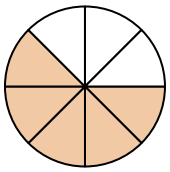

Answers

1. $\frac{5}{6}$
2. $\frac{2}{3}$
3. $\frac{3}{4}$
4. $\frac{1}{3}$
5. $\frac{4}{6}$
6. $\frac{1}{2}$
7. $\frac{2}{6}$
8. $\frac{3}{8}$
9. $\frac{1}{6}$
10. $\frac{1}{4}$
11. $\frac{3}{6}$
12. $\frac{2}{8}$
13. $\frac{1}{8}$
14. $\frac{6}{8}$
15. $\frac{2}{4}$
16. $\frac{4}{8}$
17. $\frac{7}{8}$
18. $\frac{5}{8}$

1-10	94	89	83	78	72	67	61	56	50	44
11-18	39	33	28	22	17	11	6	0		

Writing Fractions

Name:

Write the shaded amount as a fraction of the whole amount.

1) 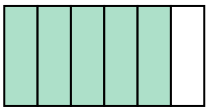

2)

3) 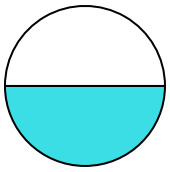

4) 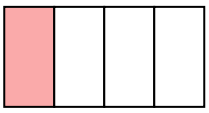

5) 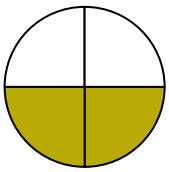

6) 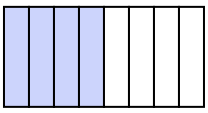

7) 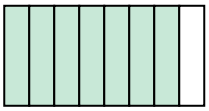

8) 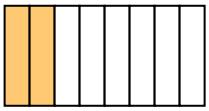

9) 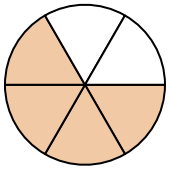

10) 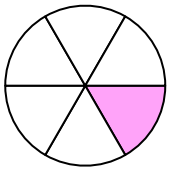

11) 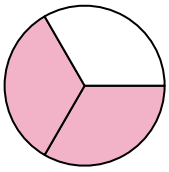

12) 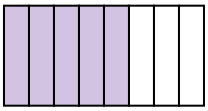

13) 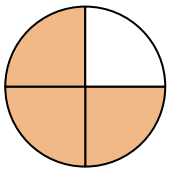

14) 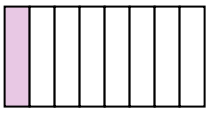

15) 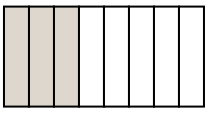

16) 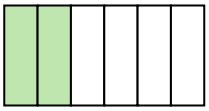

17) 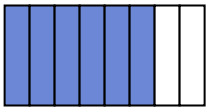

18) 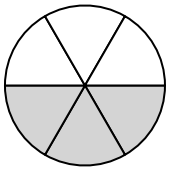

Answers

1. _____
2. _____
3. _____
4. _____
5. _____
6. _____
7. _____
8. _____
9. _____
10. _____
11. _____
12. _____
13. _____
14. _____
15. _____
16. _____
17. _____
18. _____

1-10	94	89	83	78	72	67	61	56	50	44
11-18	39	33	28	22	17	11	6	0		

Writing Fractions

Name: **Answer Key**

Write the shaded amount as a fraction of the whole amount.

1) 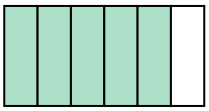

2)

3) 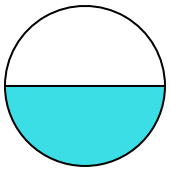

4) 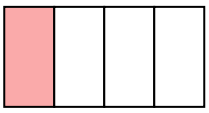

5) 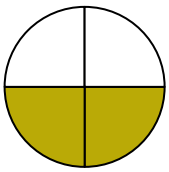

6) 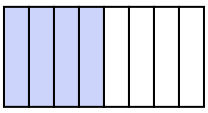

7) 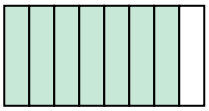

8) 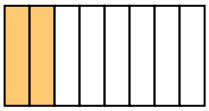

9) 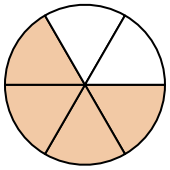

10) 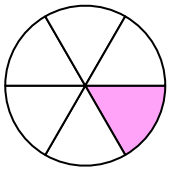

11) 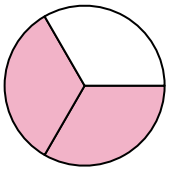

12) 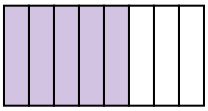

13) 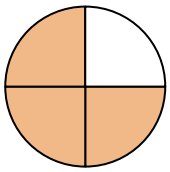

14) 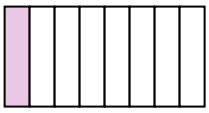

15) 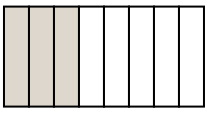

16) 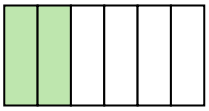

17) 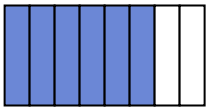

18) 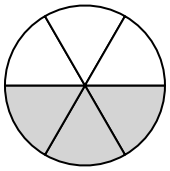

Answers

1. $\frac{5}{6}$
2. $\frac{1}{3}$
3. $\frac{1}{2}$
4. $\frac{1}{4}$
5. $\frac{2}{4}$
6. $\frac{4}{8}$
7. $\frac{7}{8}$
8. $\frac{2}{8}$
9. $\frac{4}{6}$
10. $\frac{1}{6}$
11. $\frac{2}{3}$
12. $\frac{5}{8}$
13. $\frac{3}{4}$
14. $\frac{1}{8}$
15. $\frac{3}{8}$
16. $\frac{2}{6}$
17. $\frac{6}{8}$
18. $\frac{3}{6}$

1-10	94	89	83	78	72	67	61	56	50	44
11-18	39	33	28	22	17	11	6	0		

Writing Fractions

Name:

Write the shaded amount as a fraction of the whole amount.

1)

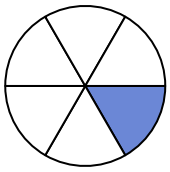

2)

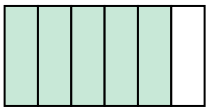

3)

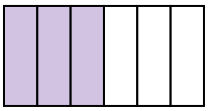

4)

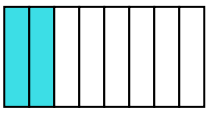

5)

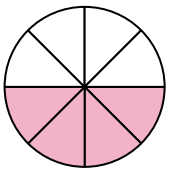

6)

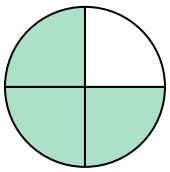

7)

8)

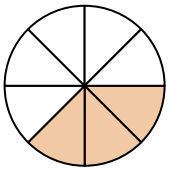

9)

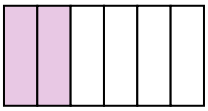

10)

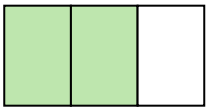

11)

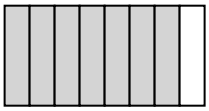

12)

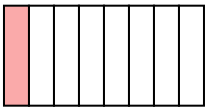

13)

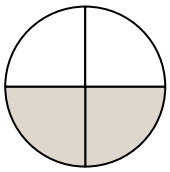

14)

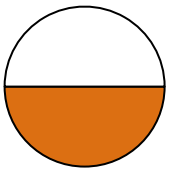

15)

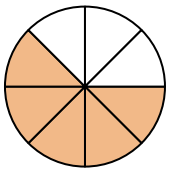

16)

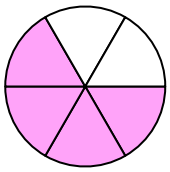

17)

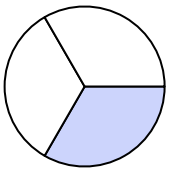

18)

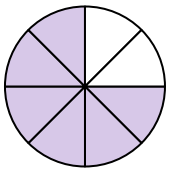

Answers

1. _____
2. _____
3. _____
4. _____
5. _____
6. _____
7. _____
8. _____
9. _____
10. _____
11. _____
12. _____
13. _____
14. _____
15. _____
16. _____
17. _____
18. _____

1-10	94	89	83	78	72	67	61	56	50	44
11-18	39	33	28	22	17	11	6	0		

Writing Fractions

Name: **Answer Key**

Write the shaded amount as a fraction of the whole amount.

1) 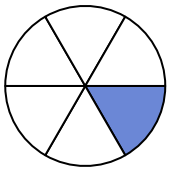

2) 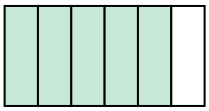

3) 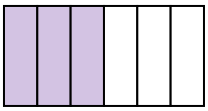

4) 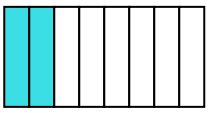

5) 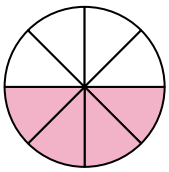

6) 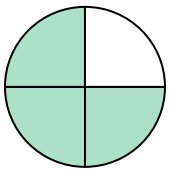

7)

8) 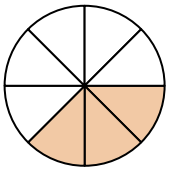

9) 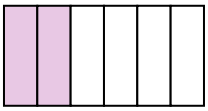

10) 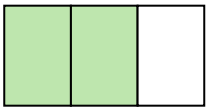

11) 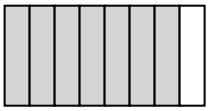

12) 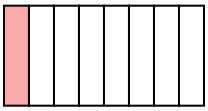

13) 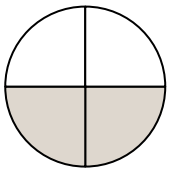

14) 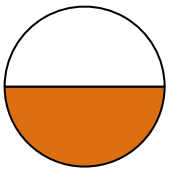

15) 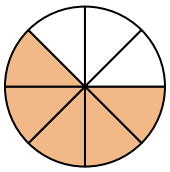

16) 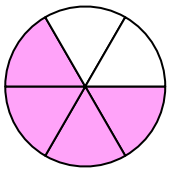

17) 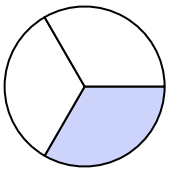

18) 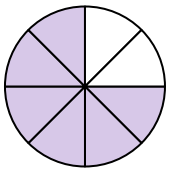

Answers

1. $\frac{1}{6}$
2. $\frac{5}{6}$
3. $\frac{3}{6}$
4. $\frac{2}{8}$
5. $\frac{4}{8}$
6. $\frac{3}{4}$
7. $\frac{1}{4}$
8. $\frac{3}{8}$
9. $\frac{2}{6}$
10. $\frac{2}{3}$
11. $\frac{7}{8}$
12. $\frac{1}{8}$
13. $\frac{2}{4}$
14. $\frac{1}{2}$
15. $\frac{5}{8}$
16. $\frac{4}{6}$
17. $\frac{1}{3}$
18. $\frac{6}{8}$

1-10	94	89	83	78	72	67	61	56	50	44
11-18	39	33	28	22	17	11	6	0		

Writing Fractions Name:

Write the shaded amount as a fraction of the whole amount.

1) 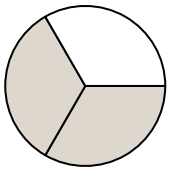

2) 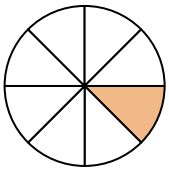

3) 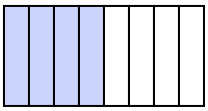

4) 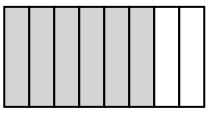

5) 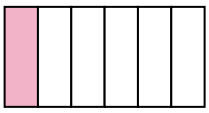

6) 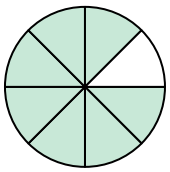

7) 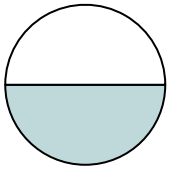

8) 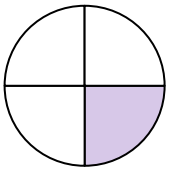

9) 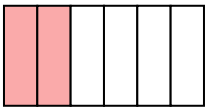

10) 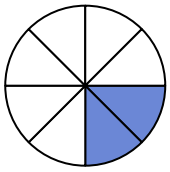

11) 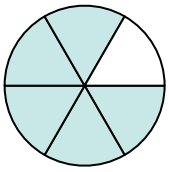

12) 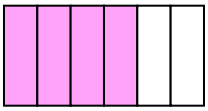

13) 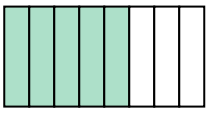

14) 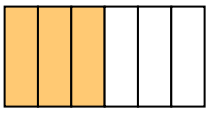

15) 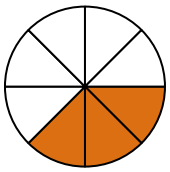

16)

17) 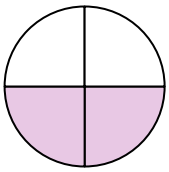

18) 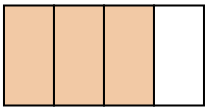

Answers

1. _____
2. _____
3. _____
4. _____
5. _____
6. _____
7. _____
8. _____
9. _____
10. _____
11. _____
12. _____
13. _____
14. _____
15. _____
16. _____
17. _____
18. _____

1-10	94	89	83	78	72	67	61	56	50	44
11-18	39	33	28	22	17	11	6	0		

Writing Fractions

Name: **Answer Key**

Write the shaded amount as a fraction of the whole amount.

1)

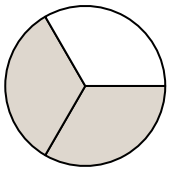

2)

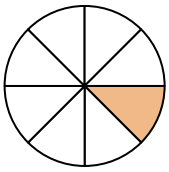

3)

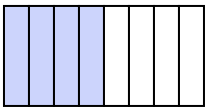

4)

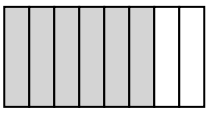

5)

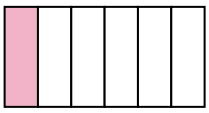

6)

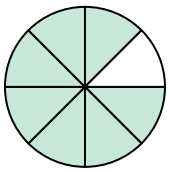

7)

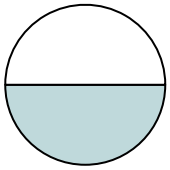

8)

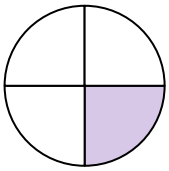

9)

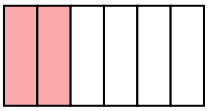

10)

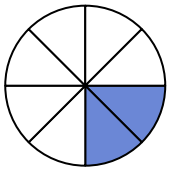

11)

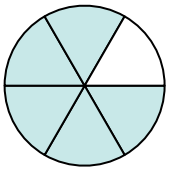

12)

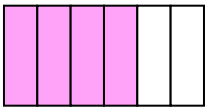

13)

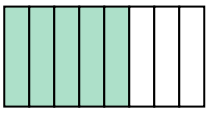

14)

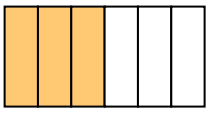

15)

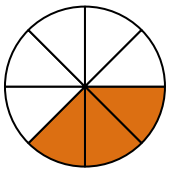

16)

17)

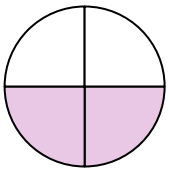

18)

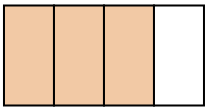

Answers

1. $\frac{2}{3}$
2. $\frac{1}{8}$
3. $\frac{4}{8}$
4. $\frac{6}{8}$
5. $\frac{1}{6}$
6. $\frac{7}{8}$
7. $\frac{1}{2}$
8. $\frac{1}{4}$
9. $\frac{2}{6}$
10. $\frac{2}{8}$
11. $\frac{5}{6}$
12. $\frac{4}{6}$
13. $\frac{5}{8}$
14. $\frac{3}{6}$
15. $\frac{3}{8}$
16. $\frac{1}{3}$
17. $\frac{2}{4}$
18. $\frac{3}{4}$

1-10	94	89	83	78	72	67	61	56	50	44
11-18	39	33	28	22	17	11	6	0		

Writing Fractions

Name:

Write the shaded amount as a fraction of the whole amount.

1) 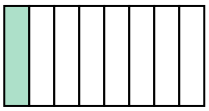

2) 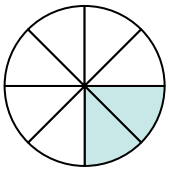

3) 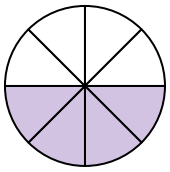

4) 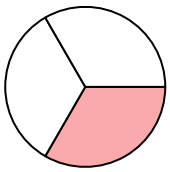

5) 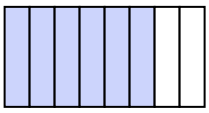

6) 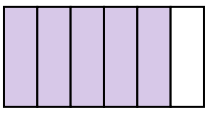

7) 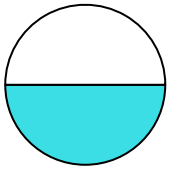

8) 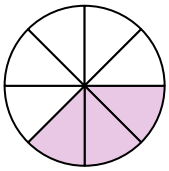

9)

10) 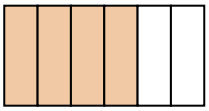

11) 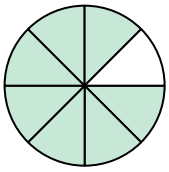

12) 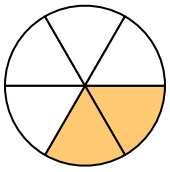

13) 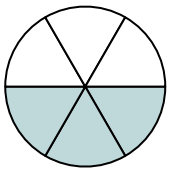

14) 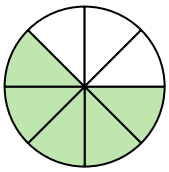

15) 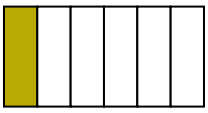

16) 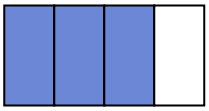

17) 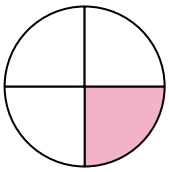

18) 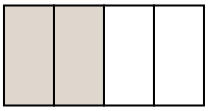

Answers

1. _____
2. _____
3. _____
4. _____
5. _____
6. _____
7. _____
8. _____
9. _____
10. _____
11. _____
12. _____
13. _____
14. _____
15. _____
16. _____
17. _____
18. _____

1-10	94	89	83	78	72	67	61	56	50	44
11-18	39	33	28	22	17	11	6	0		

Writing Fractions

Name: **Answer Key**

Write the shaded amount as a fraction of the whole amount.

1) 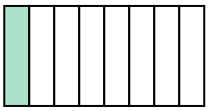

2) 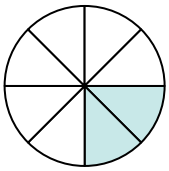

3) 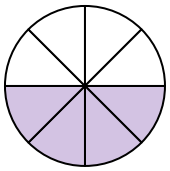

4) 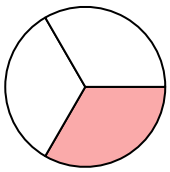

5) 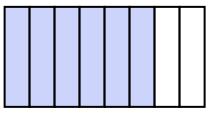

6) 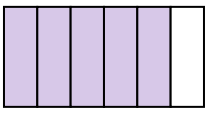

7) 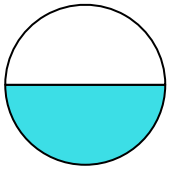

8) 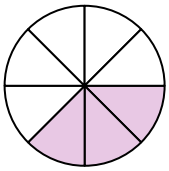

9)

10) 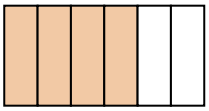

11) 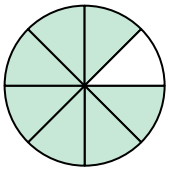

12) 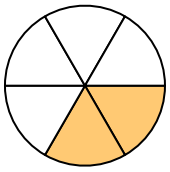

13) 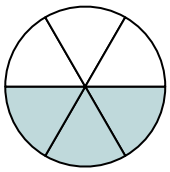

14) 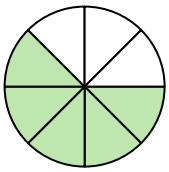

15) 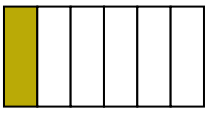

16) 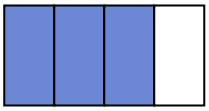

17) 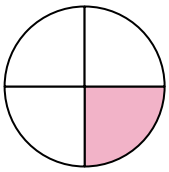

18) 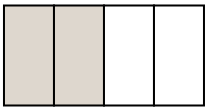

Answers

1. $\frac{1}{8}$
2. $\frac{2}{8}$
3. $\frac{4}{8}$
4. $\frac{1}{3}$
5. $\frac{6}{8}$
6. $\frac{5}{6}$
7. $\frac{1}{2}$
8. $\frac{3}{8}$
9. $\frac{2}{3}$
10. $\frac{4}{6}$
11. $\frac{7}{8}$
12. $\frac{2}{6}$
13. $\frac{3}{6}$
14. $\frac{5}{8}$
15. $\frac{1}{6}$
16. $\frac{3}{4}$
17. $\frac{1}{4}$
18. $\frac{2}{4}$

1-10	94	89	83	78	72	67	61	56	50	44
11-18	39	33	28	22	17	11	6	0		

Writing Fractions

Name:

Write the shaded amount as a fraction of the whole amount.

1)



2)

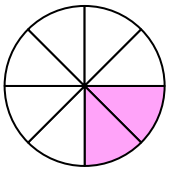

3)

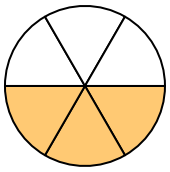

4)

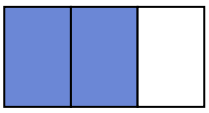

5)

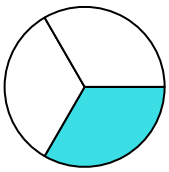

6)

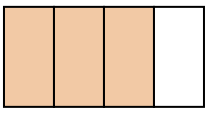

7)

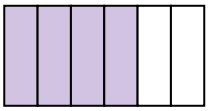

8)

9)

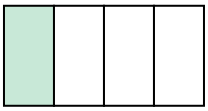

10)

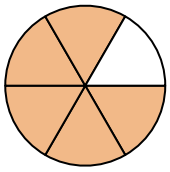

11)

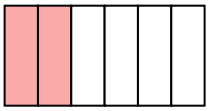

12)

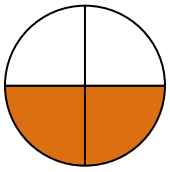

13)

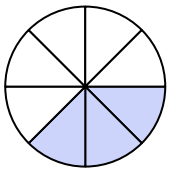

14)

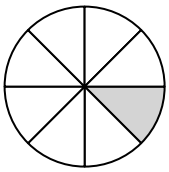

15)

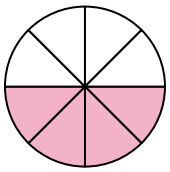

16)

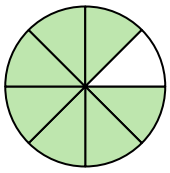

17)

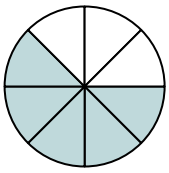

18)

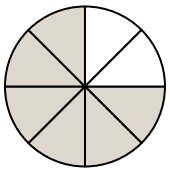

Answers

1. _____
2. _____
3. _____
4. _____
5. _____
6. _____
7. _____
8. _____
9. _____
10. _____
11. _____
12. _____
13. _____
14. _____
15. _____
16. _____
17. _____
18. _____

1-10	94	89	83	78	72	67	61	56	50	44
11-18	39	33	28	22	17	11	6	0		

Writing Fractions

Name: **Answer Key**

Write the shaded amount as a fraction of the whole amount.

1)



2)

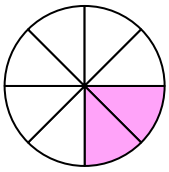

3)

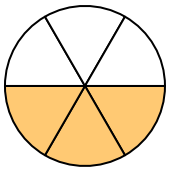

4)

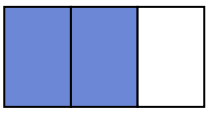

5)

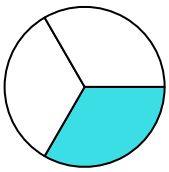

6)

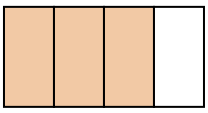

7)

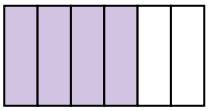

8)

9)

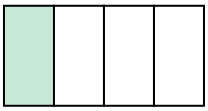

10)

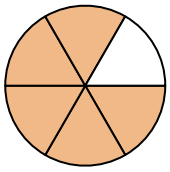

11)

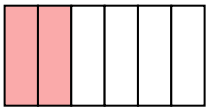

12)

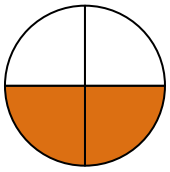

13)

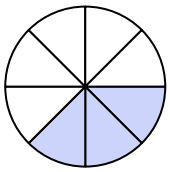

14)

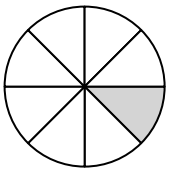

15)

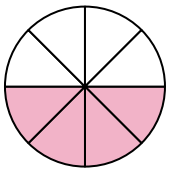

16)

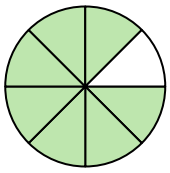

17)

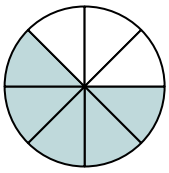

18)

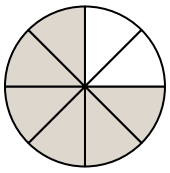

Answers

1. $\frac{1}{2}$
2. $\frac{2}{8}$
3. $\frac{3}{6}$
4. $\frac{2}{3}$
5. $\frac{1}{3}$
6. $\frac{3}{4}$
7. $\frac{4}{6}$
8. $\frac{1}{6}$
9. $\frac{1}{4}$
10. $\frac{5}{6}$
11. $\frac{2}{6}$
12. $\frac{2}{4}$
13. $\frac{3}{8}$
14. $\frac{1}{8}$
15. $\frac{4}{8}$
16. $\frac{7}{8}$
17. $\frac{5}{8}$
18. $\frac{6}{8}$

1-10	94	89	83	78	72	67	61	56	50	44
11-18	39	33	28	22	17	11	6	0		

Writing Fractions

Name:

Write the shaded amount as a fraction of the whole amount.

1)

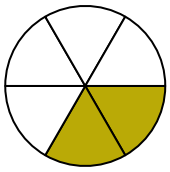

2)

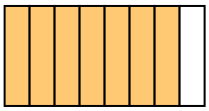

3)

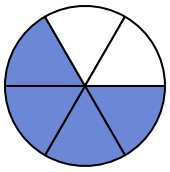

4)

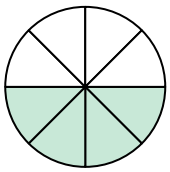

5)

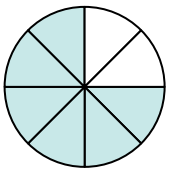

6)

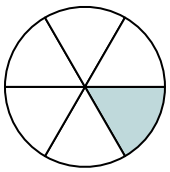

7)

8)

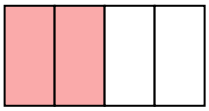

9)

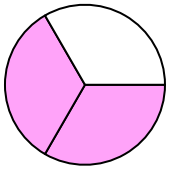

10)

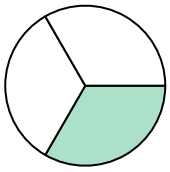

11)

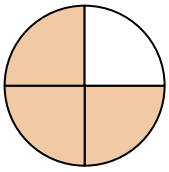

12)

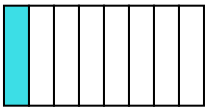

13)

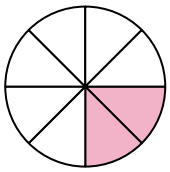

14)

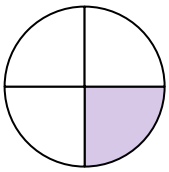

15)

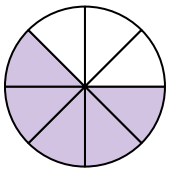

16)

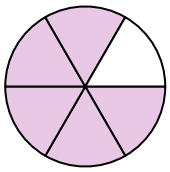

17)

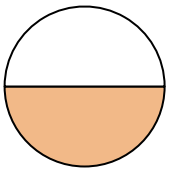

18)

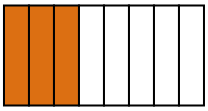

Answers

1. _____
2. _____
3. _____
4. _____
5. _____
6. _____
7. _____
8. _____
9. _____
10. _____
11. _____
12. _____
13. _____
14. _____
15. _____
16. _____
17. _____
18. _____

1-10	94	89	83	78	72	67	61	56	50	44
11-18	39	33	28	22	17	11	6	0		

Writing Fractions

Name: **Answer Key**

Write the shaded amount as a fraction of the whole amount.

1)

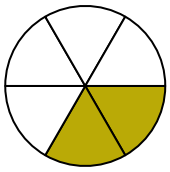

2)

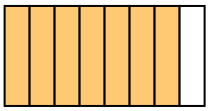

3)

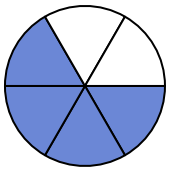

4)

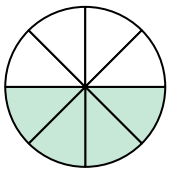

5)

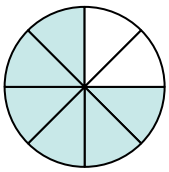

6)

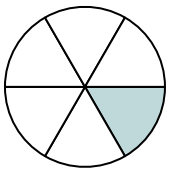

7)

8)

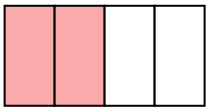

9)

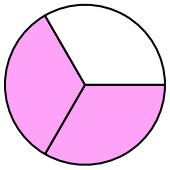

10)

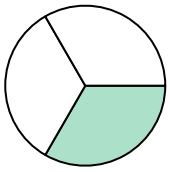

11)

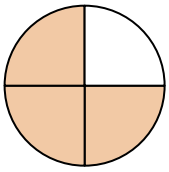

12)

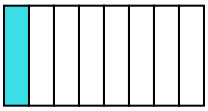

13)

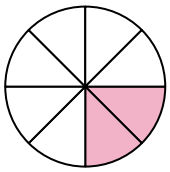

14)

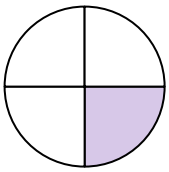

15)

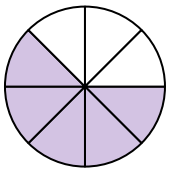

16)

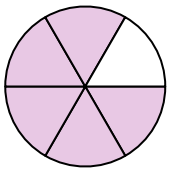

17)

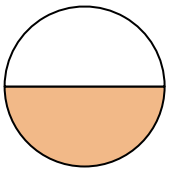

18)

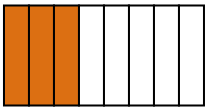

Answers

1. $\frac{2}{6}$
2. $\frac{7}{8}$
3. $\frac{4}{6}$
4. $\frac{4}{8}$
5. $\frac{6}{8}$
6. $\frac{1}{6}$
7. $\frac{3}{6}$
8. $\frac{2}{4}$
9. $\frac{2}{3}$
10. $\frac{1}{3}$
11. $\frac{3}{4}$
12. $\frac{1}{8}$
13. $\frac{2}{8}$
14. $\frac{1}{4}$
15. $\frac{5}{8}$
16. $\frac{5}{6}$
17. $\frac{1}{2}$
18. $\frac{3}{8}$

1-10	94	89	83	78	72	67	61	56	50	44
11-18	39	33	28	22	17	11	6	0		