Dividing with a Numberline Name:

Use the numberline to solve each problem. The first is marked for you.

1) $2 \div \frac{1}{3}$

2) $6 \div \frac{1}{3}$

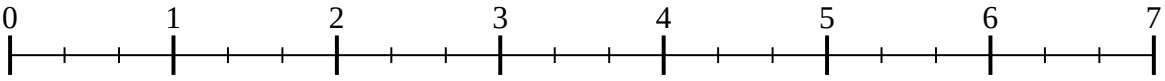

3) $5 \div \frac{1}{4}$

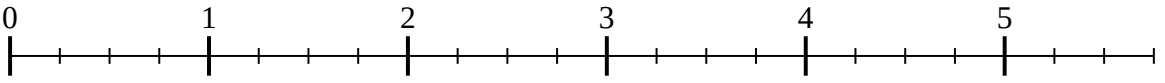

4) $7 \div \frac{1}{5}$

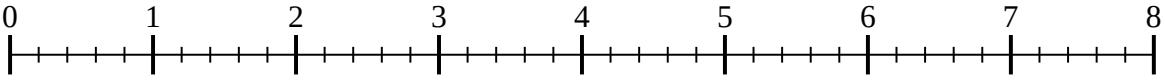

5) $5 \div \frac{1}{3}$

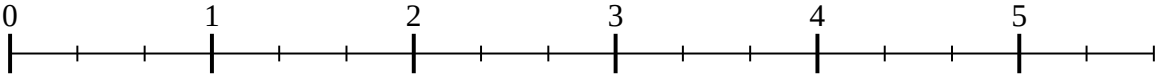

6) $6 \div \frac{1}{4}$

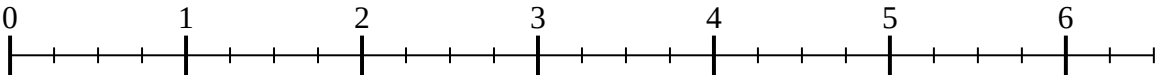

7) $7 \div \frac{1}{6}$

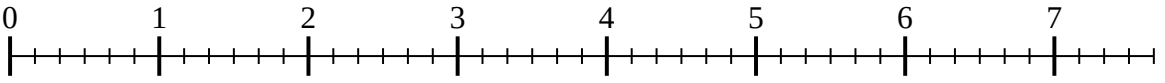

8) $3 \div \frac{1}{4}$

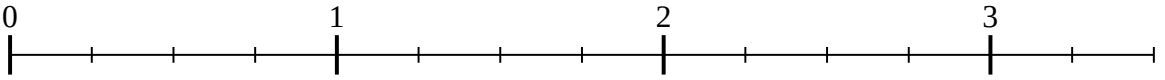

9) $6 \div \frac{1}{6}$

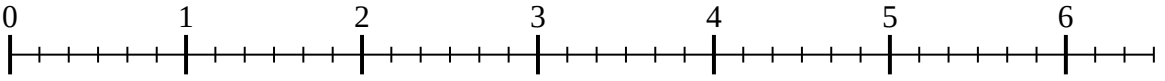

Answers

1. _____
2. _____
3. _____
4. _____
5. _____
6. _____
7. _____
8. _____
9. _____

1-9	89	78	67	56	44	33	22	11	0

Dividing with a Numberline

Name: **Answer Key**

Use the numberline to solve each problem. The first is marked for you.

1) $2 \div \frac{1}{3}$

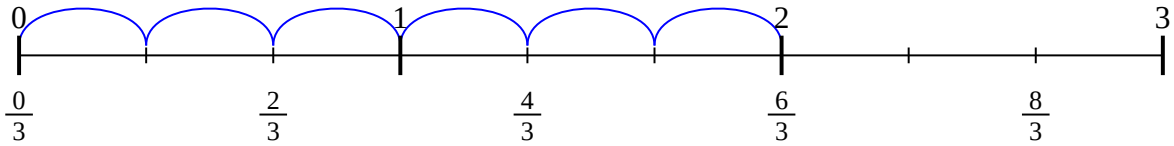

2) $6 \div \frac{1}{3}$

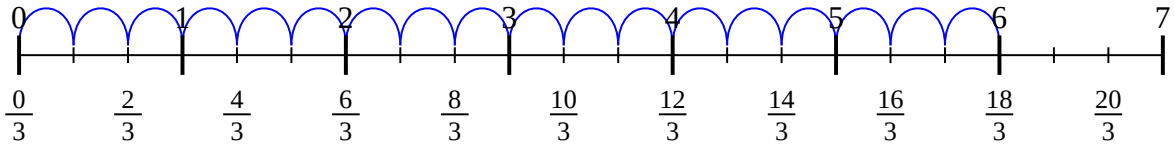

3) $5 \div \frac{1}{4}$

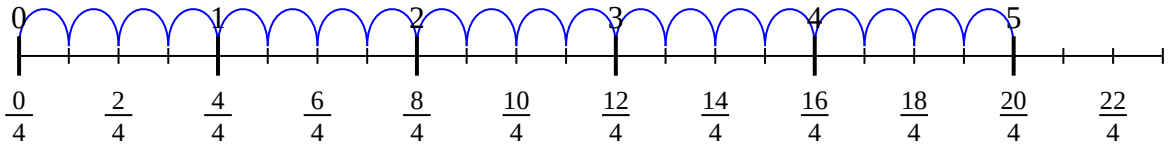

4) $7 \div \frac{1}{5}$

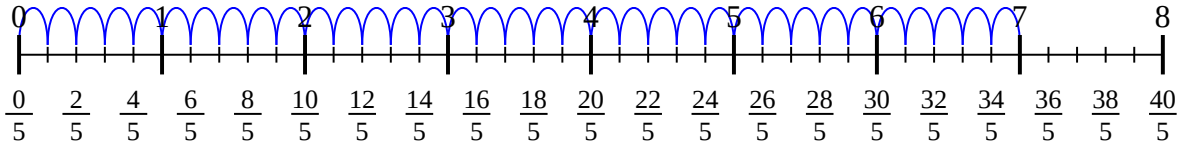

5) $5 \div \frac{1}{3}$

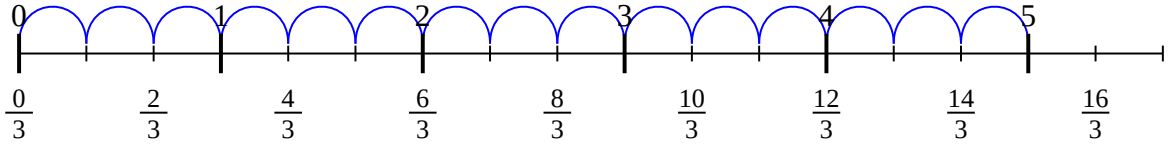

6) $6 \div \frac{1}{4}$

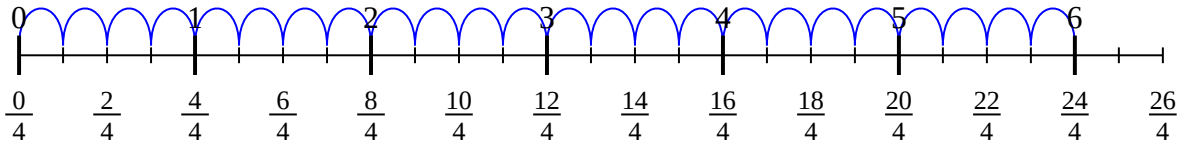

7) $7 \div \frac{1}{6}$

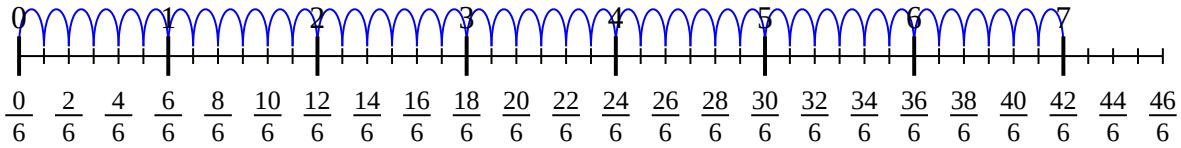

8) $3 \div \frac{1}{4}$

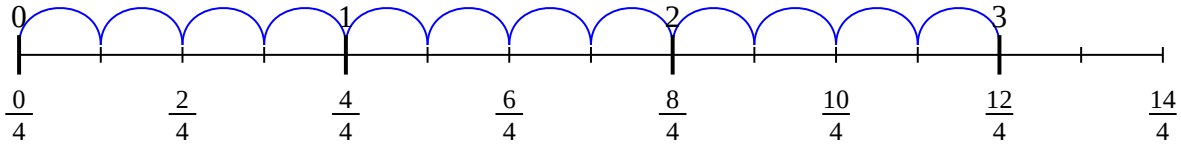

9) $6 \div \frac{1}{6}$

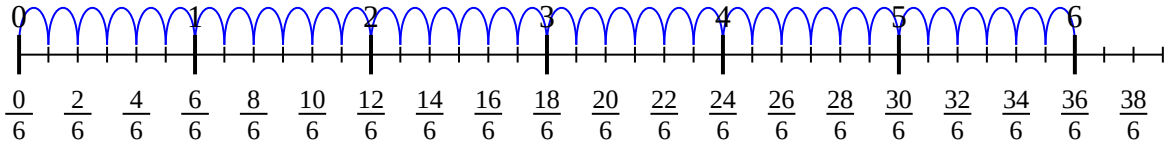

Answers

1. $\frac{6}{1}$
2. $\frac{18}{1}$
3. $\frac{20}{1}$
4. $\frac{35}{1}$
5. $\frac{15}{1}$
6. $\frac{24}{1}$
7. $\frac{42}{1}$
8. $\frac{12}{1}$
9. $\frac{36}{1}$

1-9	89	78	67	56	44	33	22	11	0

Dividing with a Numberline

Name:

Use the numberline to solve each problem. The first is marked for you.

$^{6}/_{1}$	$^{36}/_{1}$	$^{42}/_{1}$	$^{12}/_{1}$
$^{20}/_{1}$	$^{35}/_{1}$	$^{18}/_{1}$	$^{15}/_{1}$
$^{24}/_{1}$			

1) $2 \div {}^{1}/_{3}$



2) $6 \div {}^{1}/_{3}$

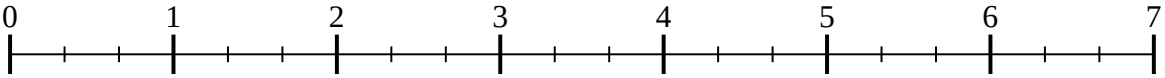

3) $5 \div {}^{1}/_{4}$

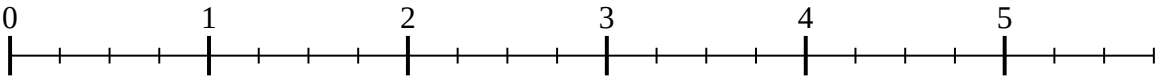

4) $7 \div {}^{1}/_{5}$

5) $5 \div {}^{1}/_{3}$

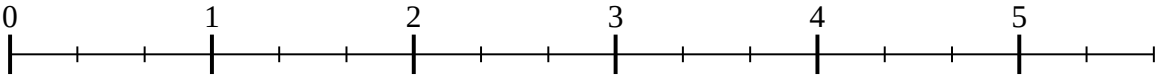

6) $6 \div {}^{1}/_{4}$

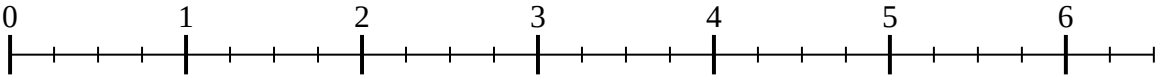

7) $7 \div {}^{1}/_{6}$

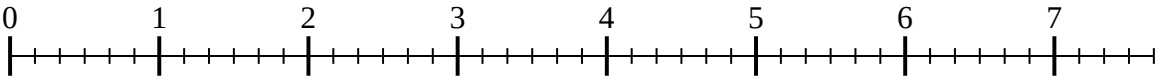

8) $3 \div {}^{1}/_{4}$

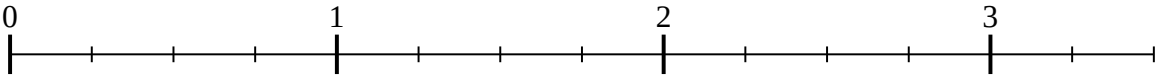

9) $6 \div {}^{1}/_{6}$

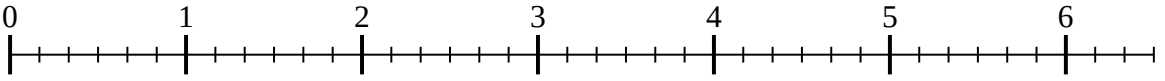

Answers

1. _____
2. _____
3. _____
4. _____
5. _____
6. _____
7. _____
8. _____
9. _____

1-9	89	78	67	56	44	33	22	11	0