Dividing with a Numberline Name:

Use the numberline to solve each problem. The first is marked for you.

1) $3 \div \frac{2}{6}$

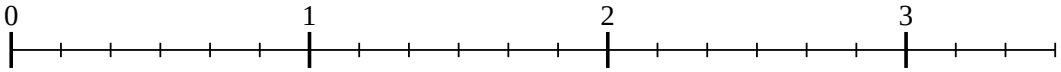

2) $3 \div \frac{3}{4}$

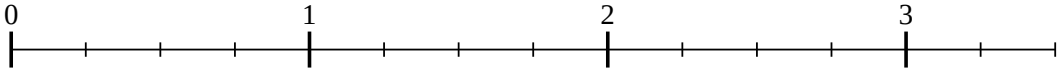

3) $6 \div \frac{2}{3}$

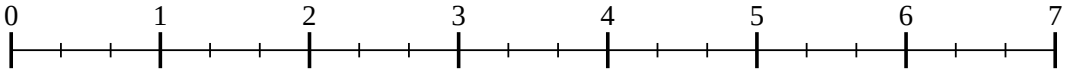

4) $3 \div \frac{2}{3}$

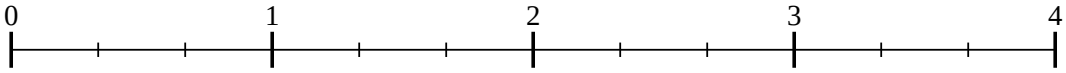

5) $6 \div \frac{3}{4}$

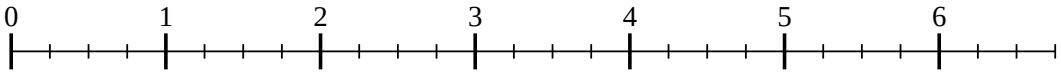

6) $6 \div \frac{3}{5}$

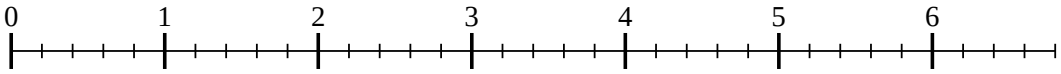

7) $4 \div \frac{3}{5}$

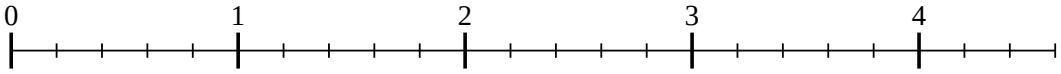

8) $7 \div \frac{2}{5}$

9) $5 \div \frac{4}{6}$

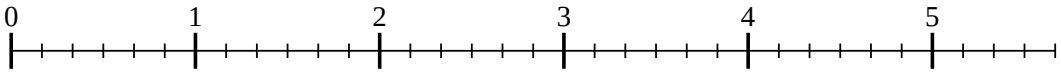

Answers

1. _____
2. _____
3. _____
4. _____
5. _____
6. _____
7. _____
8. _____
9. _____

1-9	89	78	67	56	44	33	22	11	0

Dividing with a Numberline

Name: **Answer Key**

Use the numberline to solve each problem. The first is marked for you.

1) $3 \div \frac{2}{6}$

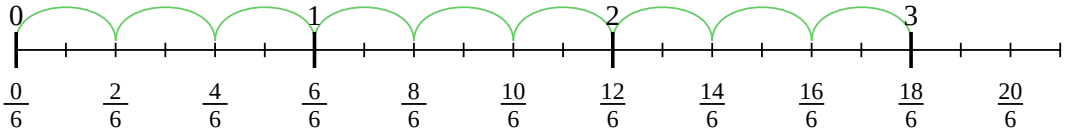

2) $3 \div \frac{3}{4}$

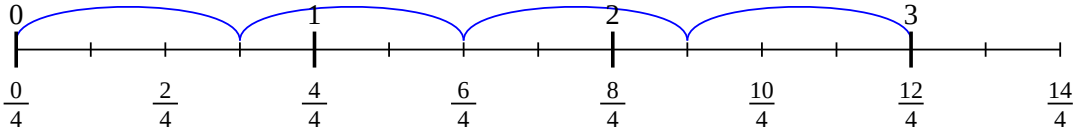

3) $6 \div \frac{2}{3}$

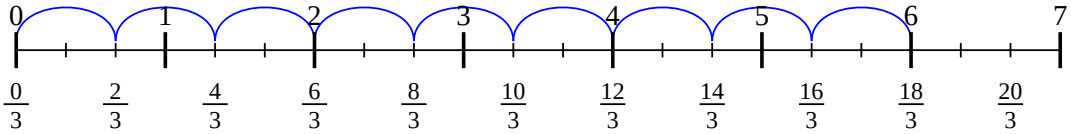

4) $3 \div \frac{2}{3}$

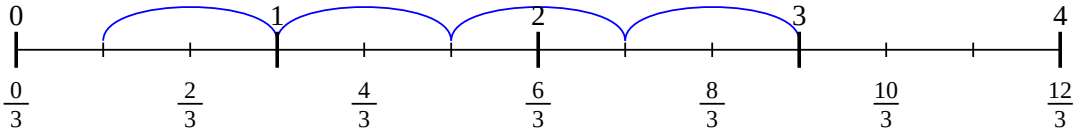

5) $6 \div \frac{3}{4}$

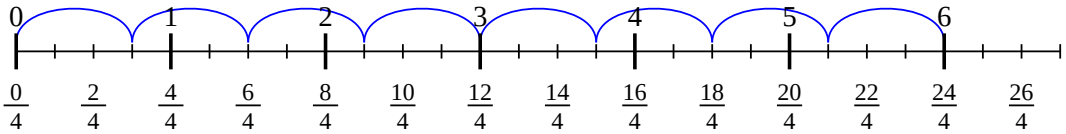

6) $6 \div \frac{3}{5}$

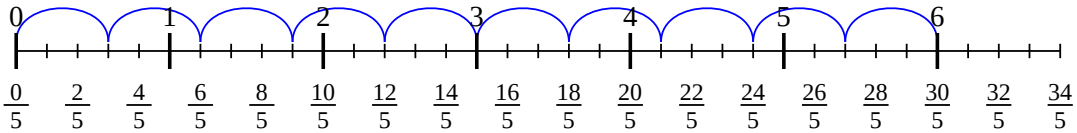

7) $4 \div \frac{3}{5}$

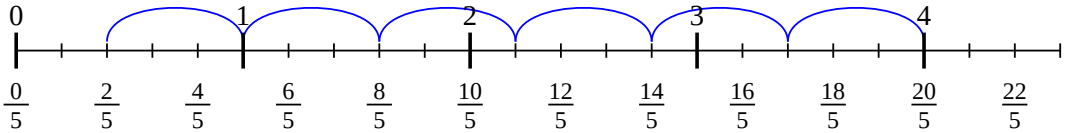

8) $7 \div \frac{2}{5}$

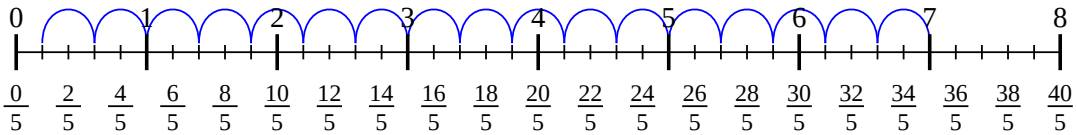

9) $5 \div \frac{4}{6}$

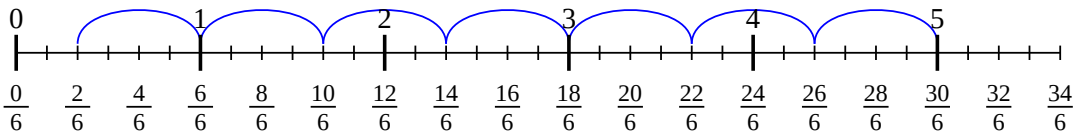

Answers

1. $18/2$
2. $12/3$
3. $18/2$
4. $9/2$
5. $24/3$
6. $30/3$
7. $20/3$
8. $35/2$
9. $30/4$

1-9	89	78	67	56	44	33	22	11	0