Identifying Partitioned Shapes

Name:

Determine which choice(s) show the shape partitioned so each piece has equal area. If none, write 'none'.

1) A.  B. 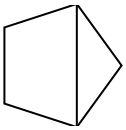 C. 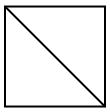 D. 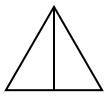

2) A. 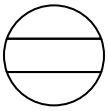 B. 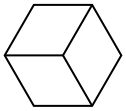 C. 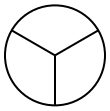 D.

3) A. 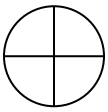 B. 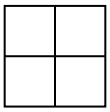 C. 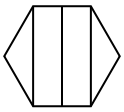 D. 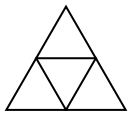

4) A. 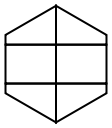 B. 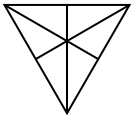 C. 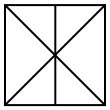 D. 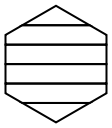

5) A. 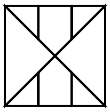 B.  C. 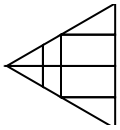 D. 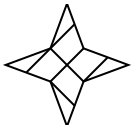

6) A. 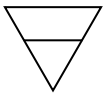 B. 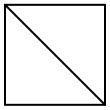 C. 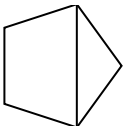 D. 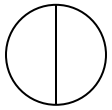

7) A. 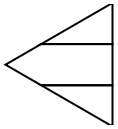 B. 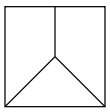 C. 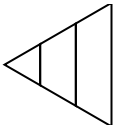 D. 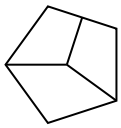

8) A.  B. 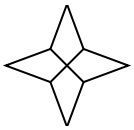 C. 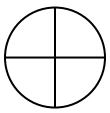 D. 

Answers

1. _____
2. _____
3. _____
4. _____
5. _____
6. _____
7. _____
8. _____

1-8	88	75	63	50	38	25	13	0

Identifying Partitioned Shapes

Name: **Answer Key**

Determine which choice(s) show the shape partitioned so each piece has equal area. If none, write 'none'.

1) A.  B. 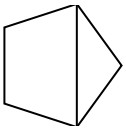 C. 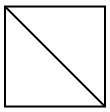 D. 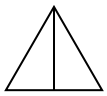

2) A. 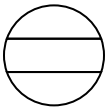 B. 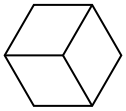 C. 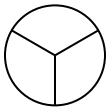 D.

3) A. 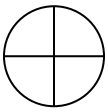 B. 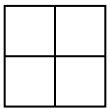 C. 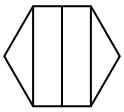 D. 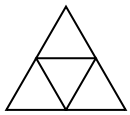

4) A. 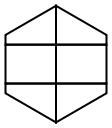 B. 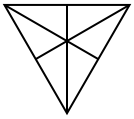 C. 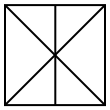 D. 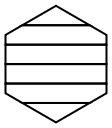

5) A. 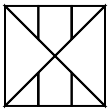 B.  C. 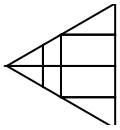 D. 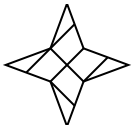

6) A. 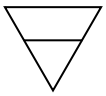 B. 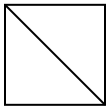 C. 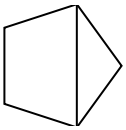 D. 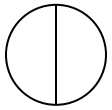

7) A. 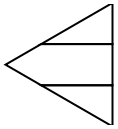 B. 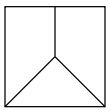 C. 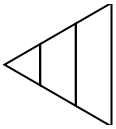 D. 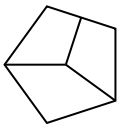

8) A.  B. 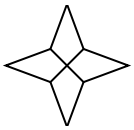 C. 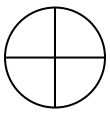 D. 

Answers

1. C,D
2. B,C
3. A,B,D
4. B
5. B
6. B,D
7. none
8. A,B,C,D

1-8	88	75	63	50	38	25	13	0