# Identifying Fractions and Decimals on a Number Wheel

Name:

**Solve each problem.**

**1)** Which choice represents the un-shaded portion of the number wheel?

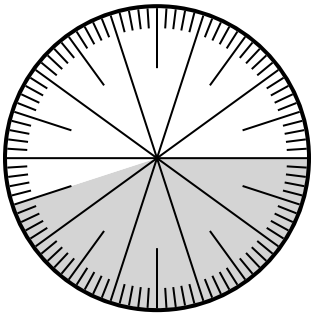

A. $^{55}/_{100}$ B. 5.5

C. 5.50 D. $^{0.55}/_{100}$

**2)** Which choice represents the un-shaded portion of the number wheel?

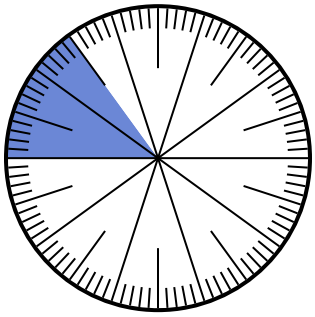

A. $^{15}/_{85}$ B. 0.85

C. 85 D. $^{85}/_{15}$

**3)** Which choice represents the shaded portion of the number wheel?



A. $^{0.1}/_{100}$ B. 0.0010

C. 0.1 D. 1.00

**4)** Which choice represents the shaded portion of the number wheel?

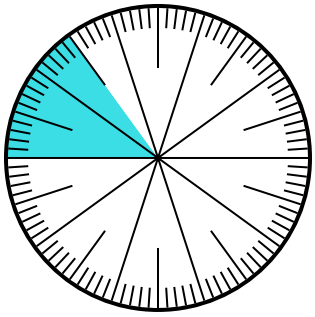

A. 8.50 B. 0.015

C. 0.15 D. 15

**5)** Which choice represents the shaded portion of the number wheel?

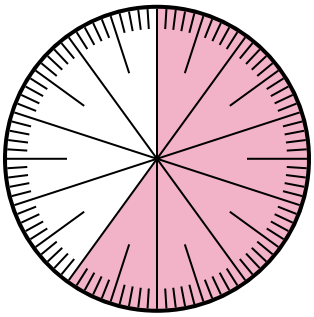

A. $^{60}/_{100}$ B. 6.00

C. 0.0060 D. 60.0

**6)** Which choice represents the shaded portion of the number wheel?

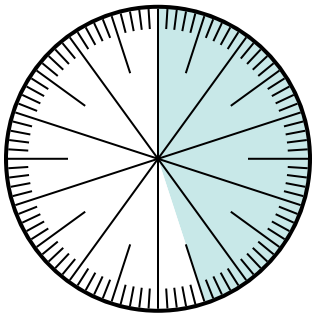

A. $^{4.5}/_{100}$ B. $^{0.45}/_{100}$

C. $^{45}/_{100}$ D. $^{45}/_{55}$

**Answers**

1. _____
2. _____
3. _____
4. _____
5. _____
6. _____

| | | | | | | |
|---|---|---|---|---|---|---|
| 1-6 | 83 | 67 | 50 | 33 | 17 | 0 |

Identifying Fractions and Decimals on a Number Wheel Name: **Answer Key**

**Solve each problem.**

**1)** Which choice represents the un-shaded portion of the number wheel?

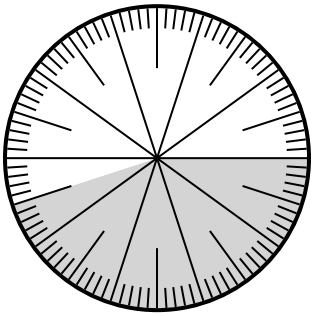

A. $^{55}/_{100}$ B. 5.5

C. 5.50 D. $^{0.55}/_{100}$

**2)** Which choice represents the un-shaded portion of the number wheel?

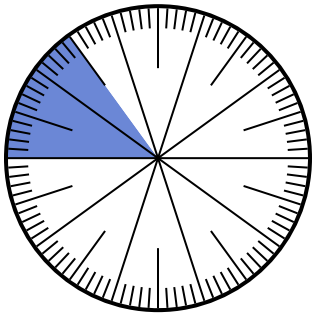

A. $^{15}/_{85}$ B. 0.85

C. 85 D. $^{85}/_{15}$

**3)** Which choice represents the shaded portion of the number wheel?



A. $^{0.1}/_{100}$ B. 0.0010

C. 0.1 D. 1.00

**4)** Which choice represents the shaded portion of the number wheel?

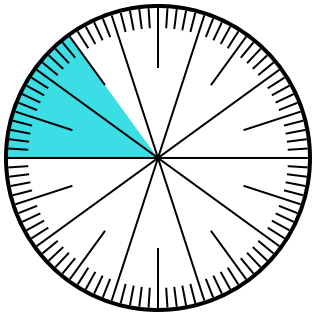

A. 8.50 B. 0.015

C. 0.15 D. 15

**5)** Which choice represents the shaded portion of the number wheel?

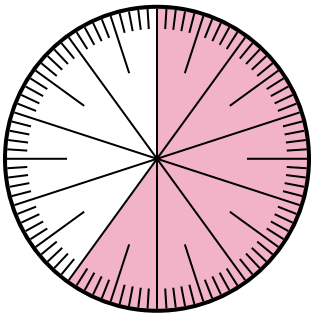

A. $^{60}/_{100}$ B. 6.00

C. 0.0060 D. 60.0

**6)** Which choice represents the shaded portion of the number wheel?

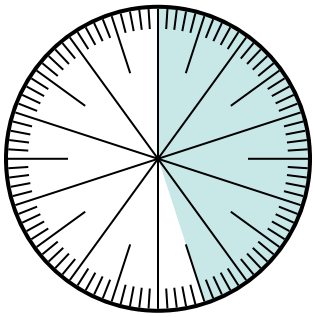

A. $^{4.5}/_{100}$ B. $^{0.45}/_{100}$

C. $^{45}/_{100}$ D. $^{45}/_{55}$

**Answers**

1. A
2. B
3. C
4. C
5. A
6. C



| 1-6 | 83 | 67 | 50 | 33 | 17 | 0 |
|---|---|---|---|---|---|---|