Finding Equivalent Fractions - Visual

Name:

Determine which letter best represents an equivalent fraction.

1) 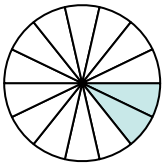

$\frac{2}{14}$

2) 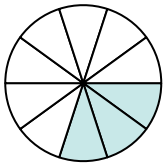

$\frac{3}{10}$

3) 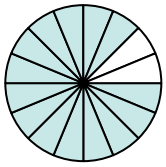

$\frac{14}{16}$

4) 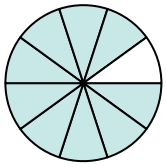

$\frac{9}{10}$

5) 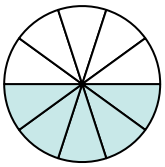

$\frac{5}{10}$

6) 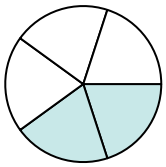

$\frac{2}{5}$

7) 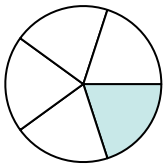

$\frac{1}{5}$

8) 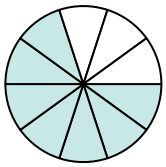

$\frac{7}{10}$

9) 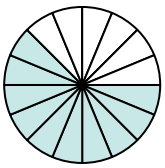

$\frac{10}{16}$

10) 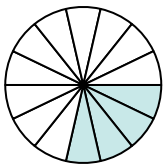

$\frac{4}{14}$

11) 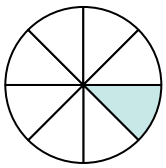

$\frac{1}{8}$

12) 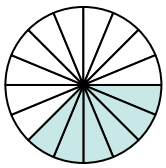

$\frac{6}{16}$

A. 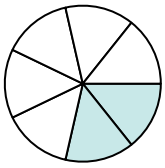

$\frac{2}{7}$

B. 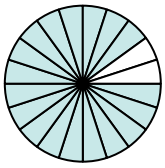

$\frac{18}{20}$

C. 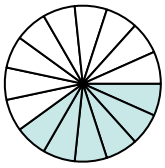

$\frac{6}{15}$

D. 

$\frac{10}{20}$

E. 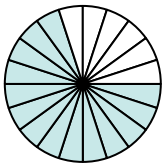

$\frac{14}{20}$

F. 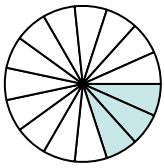

$\frac{3}{15}$

G. 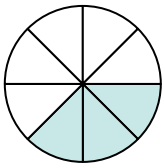

$\frac{3}{8}$

H. 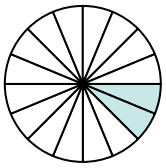

$\frac{2}{16}$

I. 

$\frac{6}{20}$

J. 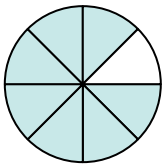

$\frac{7}{8}$

K. 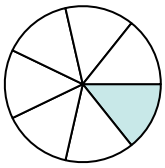

$\frac{1}{7}$

L. 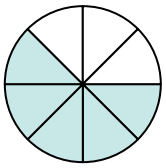

$\frac{5}{8}$

Answers

1. _____
2. _____
3. _____
4. _____
5. _____
6. _____
7. _____
8. _____
9. _____
10. _____
11. _____
12. _____

1-10	92	83	75	67	58	50	42	33	25	17
11-12	8	0								

Finding Equivalent Fractions - Visual

Name: **Answer Key**

Determine which letter best represents an equivalent fraction.

1)

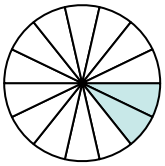

$\frac{2}{14}$

2)

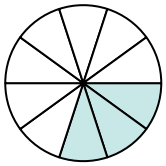

$\frac{3}{10}$

3)

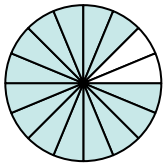

$\frac{14}{16}$

4)

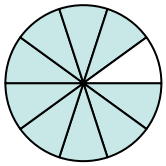

$\frac{9}{10}$

5)

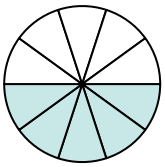

$\frac{5}{10}$

6)

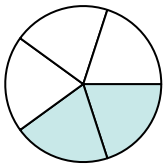

$\frac{2}{5}$

7)

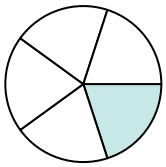

$\frac{1}{5}$

8)

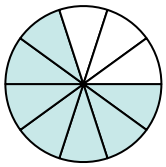

$\frac{7}{10}$

9)

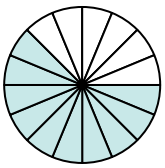

$\frac{10}{16}$

10)

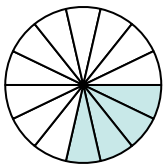

$\frac{4}{14}$

11)

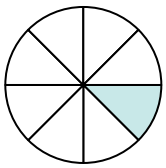

$\frac{1}{8}$

12)

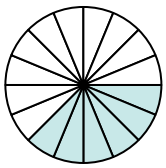

$\frac{6}{16}$

A.

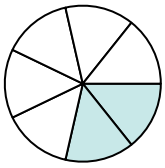

$\frac{2}{7}$

B.

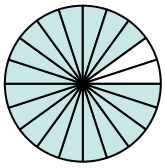

$\frac{18}{20}$

C.

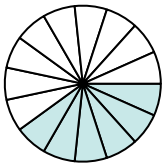

$\frac{6}{15}$

D.



$\frac{10}{20}$

E.

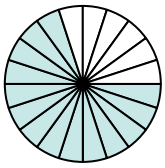

$\frac{14}{20}$

F.

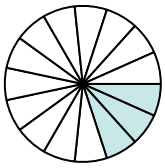

$\frac{3}{15}$

G.

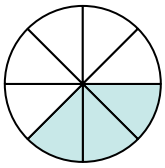

$\frac{3}{8}$

H.

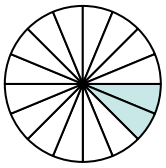

$\frac{2}{16}$

I.



$\frac{6}{20}$

J.

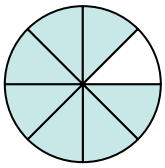

$\frac{7}{8}$

K.

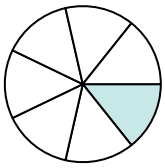

$\frac{1}{7}$

L.

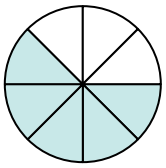

$\frac{5}{8}$

Answers

1. K
2. I
3. J
4. B
5. D
6. C
7. F
8. E
9. L
10. A
11. H
12. G

1-10	92	83	75	67	58	50	42	33	25	17
11-12	8	0								