Fraction, Decimal & Percent (Visual)

Name:

Determine the value written as a fraction , decimal & a percent.

Ex)

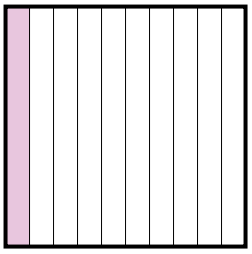

fraction $\frac{1}{10}$
decimal 0.1
percent 10

1)

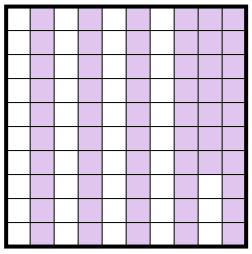

fraction
decimal
percent

2)

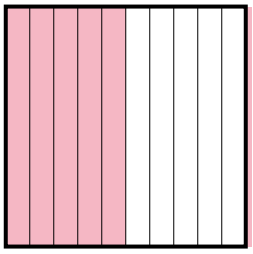

fraction
decimal
percent

3)

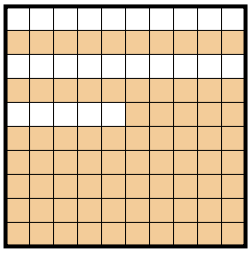

fraction
decimal
percent

4)

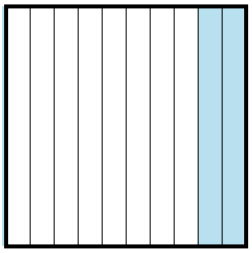

fraction
decimal
percent

5)

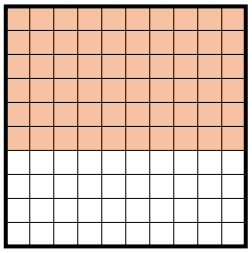

fraction
decimal
percent

6)

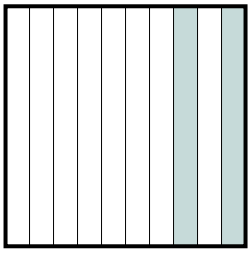

fraction
decimal
percent

7)

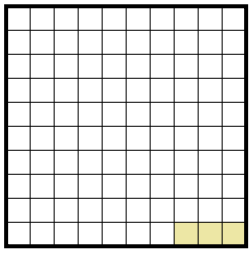

fraction
decimal
percent

8)

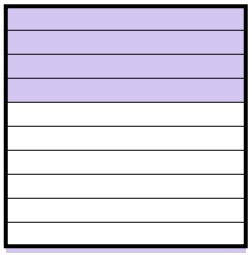

fraction
decimal
percent

9)

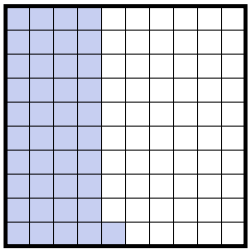

fraction
decimal
percent

10)

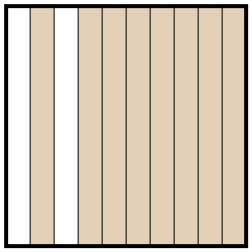

fraction
decimal
percent

11)

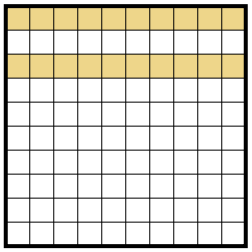

fraction
decimal
percent

Answers

Ex.	$\frac{1}{10}$	0.1	10%
1.			
2.			
3.			
4.			
5.			
6.			
7.			
8.			
9.			
10.			
11.			

Fraction, Decimal & Percent (Visual) Name: **Answer Key**

Determine the value written as a fraction , decimal & a percent.

Ex)

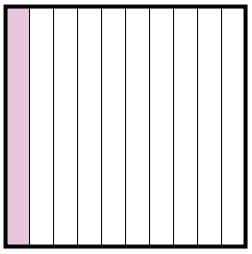

fraction $\frac{1}{10}$
decimal 0.1
percent 10

1)

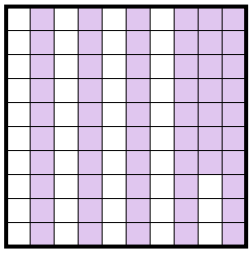

fraction $\frac{57}{100}$
decimal 0.57
percent 57

2)

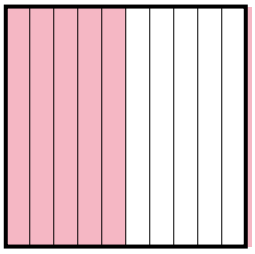

fraction $\frac{9}{10}$
decimal 0.9
percent 90

3)

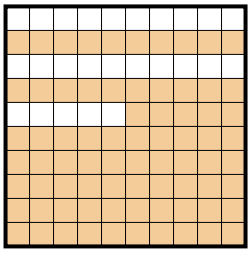

fraction $\frac{75}{100}$
decimal 0.75
percent 75

4)

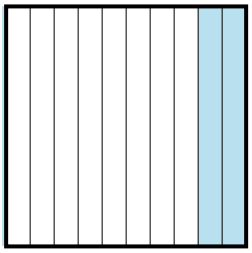

fraction $\frac{4}{10}$
decimal 0.4
percent 40

5)

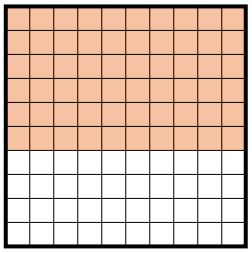

fraction $\frac{60}{100}$
decimal 0.60
percent 60

6)

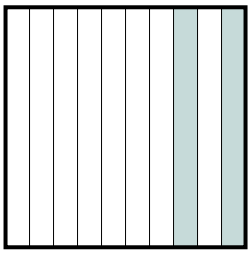

fraction $\frac{2}{10}$
decimal 0.2
percent 20

7)

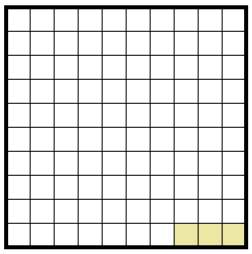

fraction $\frac{3}{100}$
decimal 0.03
percent 3

8)

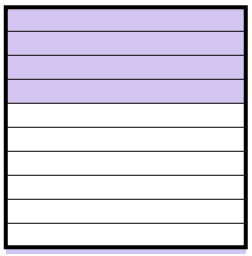

fraction $\frac{7}{10}$
decimal 0.7
percent 70

9)

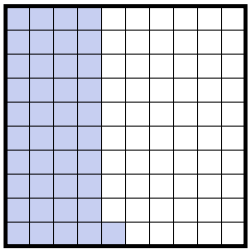

fraction $\frac{41}{100}$
decimal 0.41
percent 41

10)

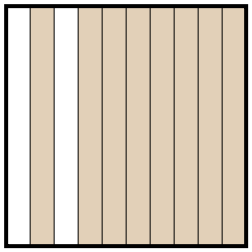

fraction $\frac{8}{10}$
decimal 0.8
percent 80

11)

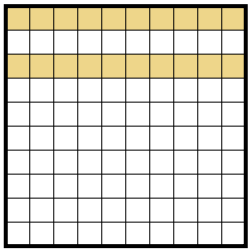

fraction $\frac{20}{100}$
decimal 0.20
percent 20

Answers

Ex.	$\frac{1}{10}$	0.1	10%
1.	$\frac{57}{100}$	0.57	57%
2.	$\frac{9}{10}$	0.9	90%
3.	$\frac{75}{100}$	0.75	75%
4.	$\frac{4}{10}$	0.4	40%
5.	$\frac{60}{100}$	0.60	60%
6.	$\frac{2}{10}$	0.2	20%
7.	$\frac{3}{100}$	0.03	3%
8.	$\frac{7}{10}$	0.7	70%
9.	$\frac{41}{100}$	0.41	41%
10.	$\frac{8}{10}$	0.8	80%
11.	$\frac{20}{100}$	0.20	20%

1-10	91	82	73	64	55	45	36	27	18	9
11	0									