Use the number line to solve the division problem.

1) 59÷7=

0 59

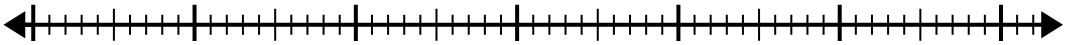

2) 42÷5=

0 42

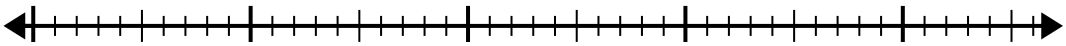

3) 21÷4=

0 21

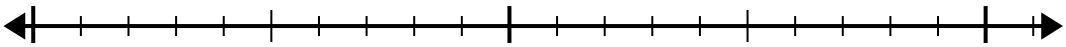

4) 44÷7=

0 44

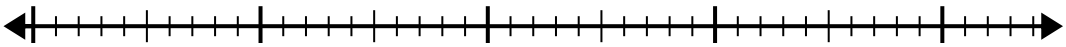

5) 60÷8=

0 60

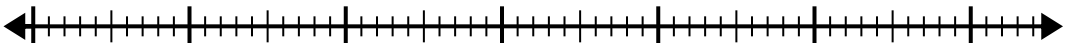

6) 22÷5=

0 22

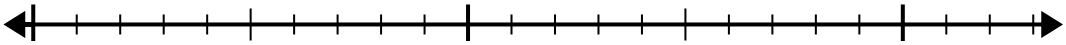

7) 26÷4=

0 26

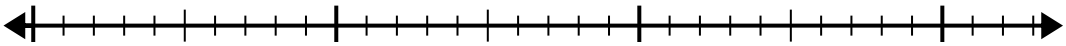

8) 54÷8=

0 54

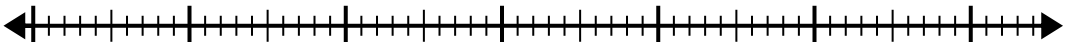

9) 14÷4=

0 14



10) 46÷6=

0 46

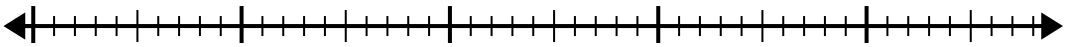

Answers

1. _____
2. _____
3. _____
4. _____
5. _____
6. _____
7. _____
8. _____
9. _____
10. _____

1-10	90	80	70	60	50	40	30	20	10	0

Use the number line to solve the division problem.

1) 59÷7=

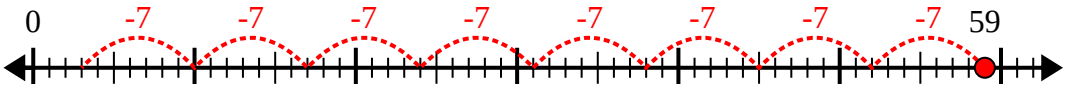

2) 42÷5=

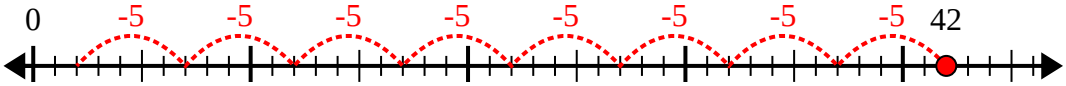

3) 21÷4=

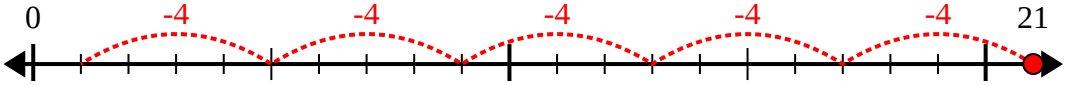

4) 44÷7=

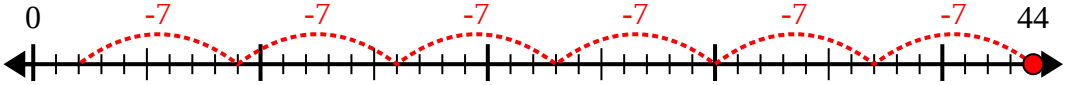

5) 60÷8=

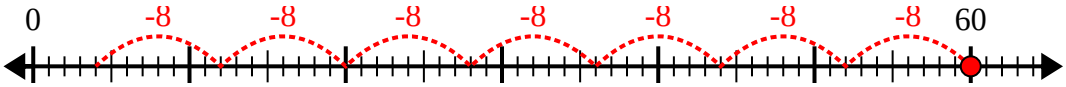

6) 22÷5=

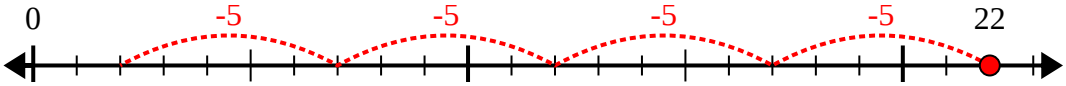

7) 26÷4=

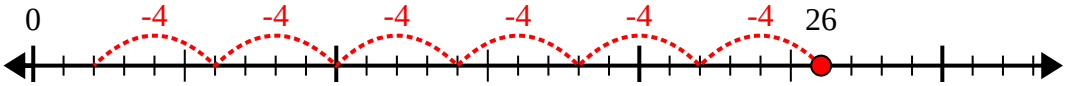

8) 54÷8=

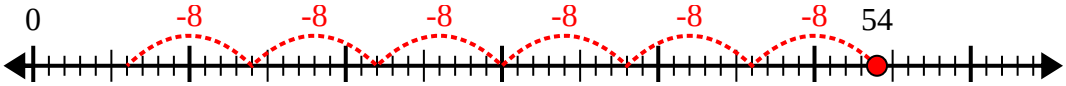

9) 14÷4=

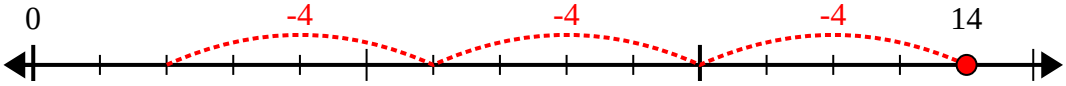

10) 46÷6=

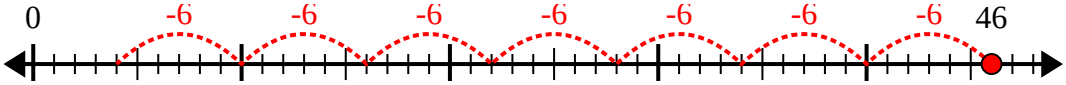

Answers

1. **8r3**
2. **8r2**
3. **5r1**
4. **6r2**
5. **7r4**
6. **4r2**
7. **6r2**
8. **6r6**
9. **3r2**
10. **7r4**

1-10	90	80	70	60	50	40	30	20	10	0