Dividing with a Numberline

Name:

Use the numberline to solve each problem.

1) 32÷8=

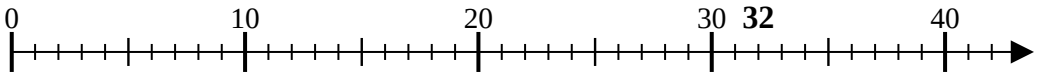

2) 12÷3=

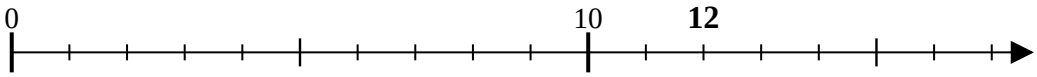

3) 18÷9=

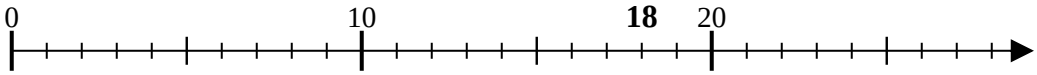

4) 25÷5=

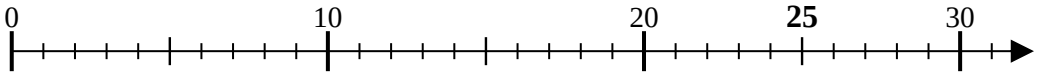

5) 40÷10=

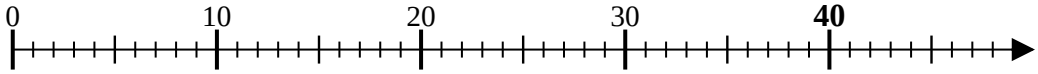

6) 20÷10=

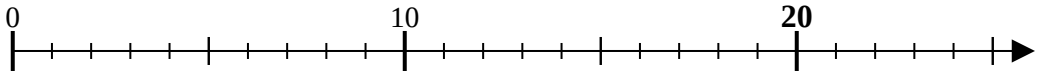

7) 4÷2=

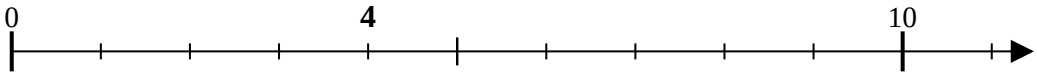

8) 15÷3=

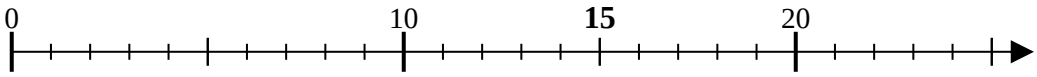

9) 24÷8=

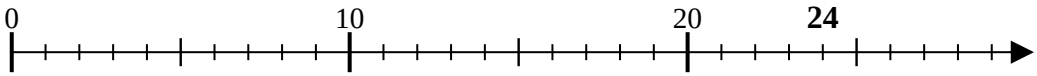

10) 35÷7=

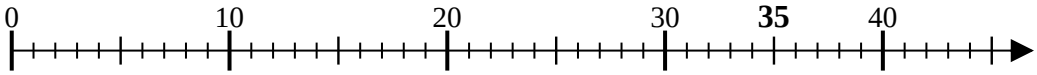

11) 40÷8=

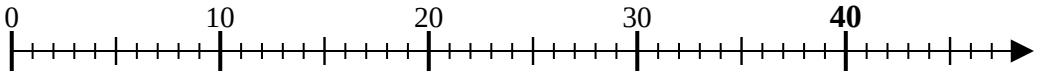

Answers

1. _____
2. _____
3. _____
4. _____
5. _____
6. _____
7. _____
8. _____
9. _____
10. _____
11. _____

1-10	91	82	73	64	55	45	36	27	18	9
11	0									

Dividing with a Numberline

Name: **Answer Key**

Use the numberline to solve each problem.

1) 32÷8=

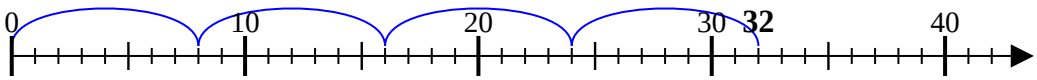

2) 12÷3=

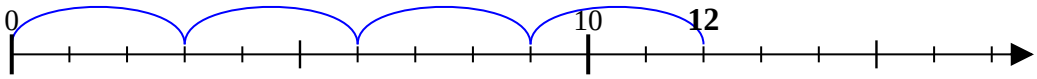

3) 18÷9=

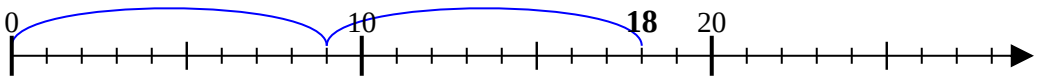

4) 25÷5=

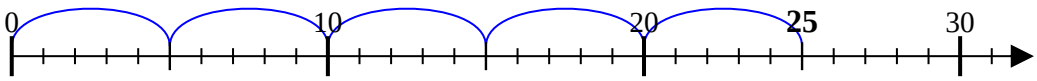

5) 40÷10=

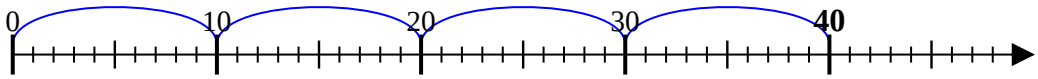

6) 20÷10=

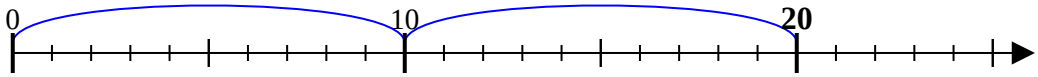

7) 4÷2=

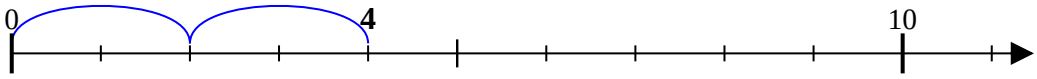

8) 15÷3=

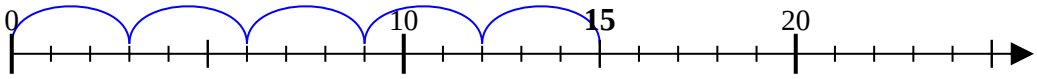

9) 24÷8=

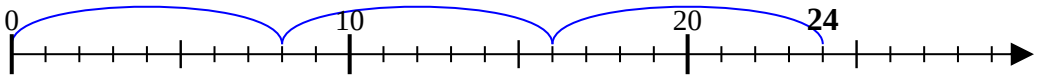

10) 35÷7=

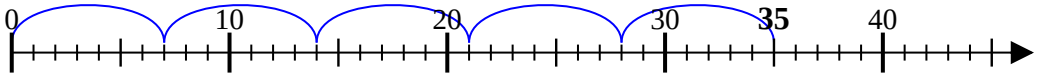

11) 40÷8=

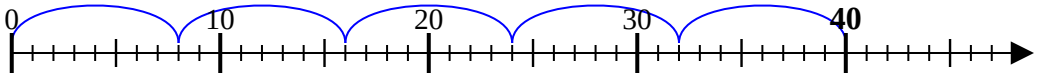

Answers

1. **4**
2. **4**
3. **2**
4. **5**
5. **4**
6. **2**
7. **2**
8. **5**
9. **3**
10. **5**
11. **5**

1-10	91	82	73	64	55	45	36	27	18	9
11	0									