Ordering Decimal Visually

Name:

Put the boxes in order from least to greatest based on the shaded amount.

Ex)

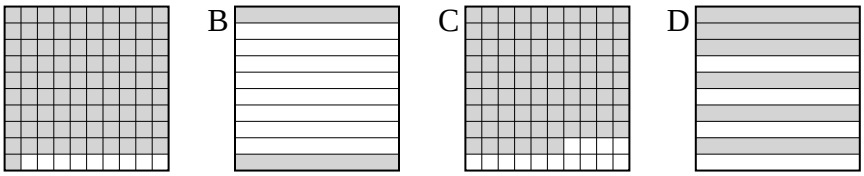

small 0.2 - B
0.6 - D
0.86 - C
large 0.91 - A

1)

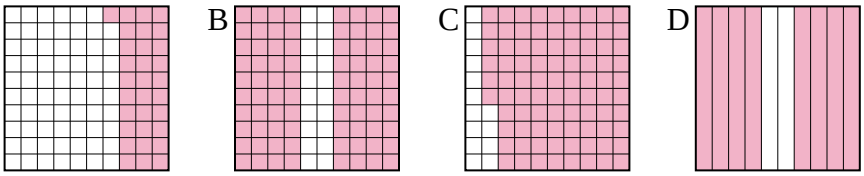

small _____
_____
_____
large _____

2)

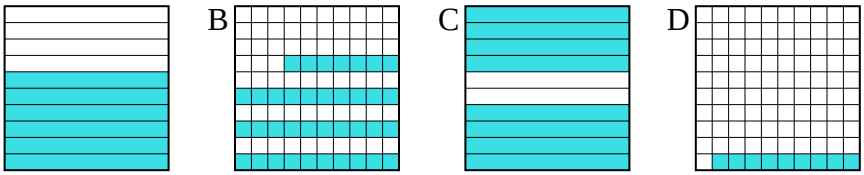

small _____
_____
_____
large _____

3)

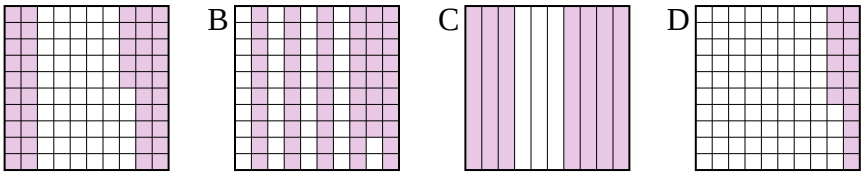

small _____
_____
_____
large _____

4)

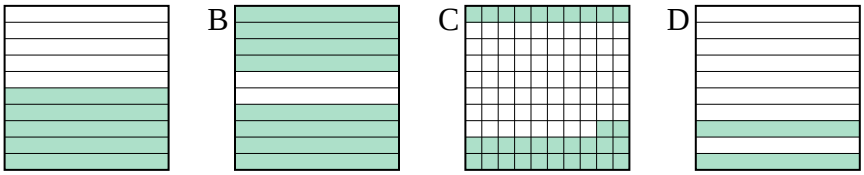

small _____
_____
_____
large _____

5)

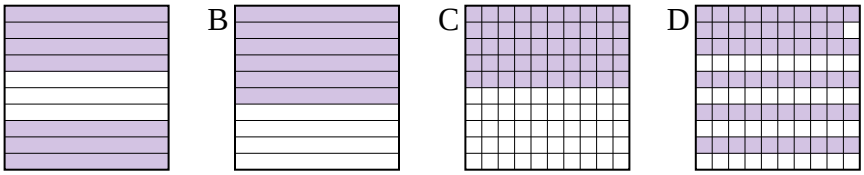

small _____
_____
_____
large _____

6)

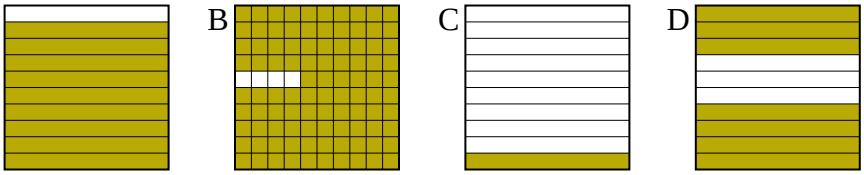

small _____
_____
_____
large _____

7)

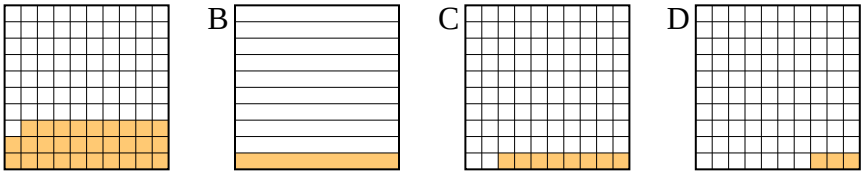

small _____
_____
_____
large _____

8)

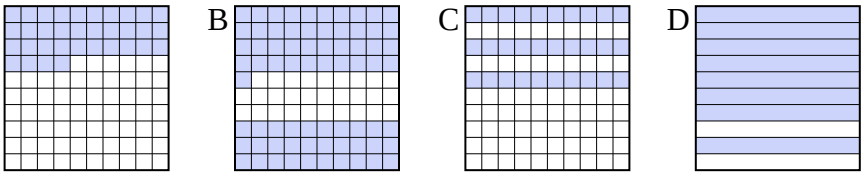

small _____
_____
_____
large _____

Answers

Ex. **B,D,C,A**

1. _____
2. _____
3. _____
4. _____
5. _____
6. _____
7. _____
8. _____

1-8	88	75	63	50	38	25	13	0

Ordering Decimal Visually

Name: **Answer Key**

Put the boxes in order from least to greatest based on the shaded amount.

Ex)

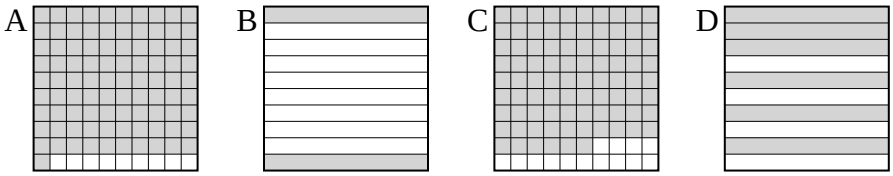

small 0.2 - B
0.6 - D
0.86 - C
large 0.91 - A

1)

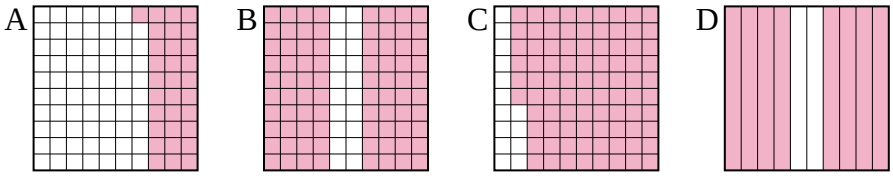

small 0.31 - A
0.8 - B
0.8 - B
large 0.86 - C

2)

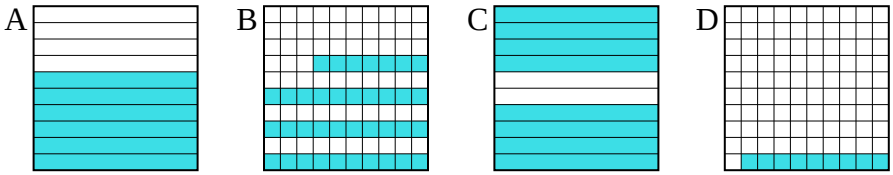

small 0.09 - D
0.37 - B
0.6 - A
large 0.8 - C

3)

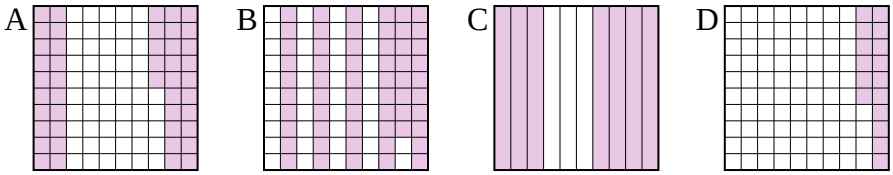

small 0.16 - D
0.45 - A
0.58 - B
large 0.7 - C

4)

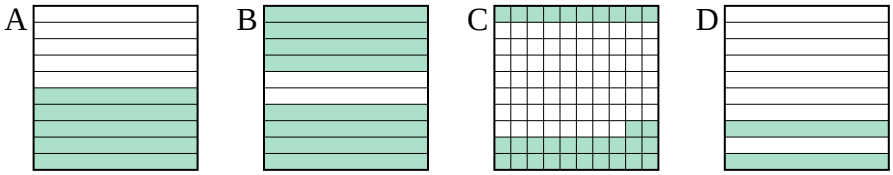

small 0.2 - D
0.32 - C
0.5 - A
large 0.8 - B

5)

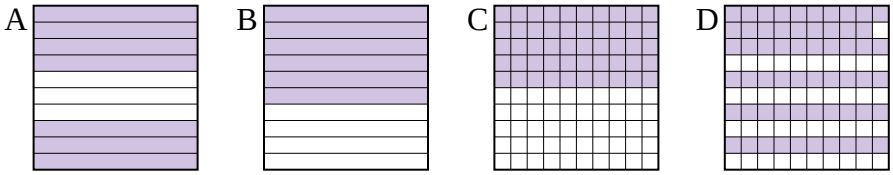

small 0.5 - C
0.59 - D
0.6 - B
large 0.7 - A

6)

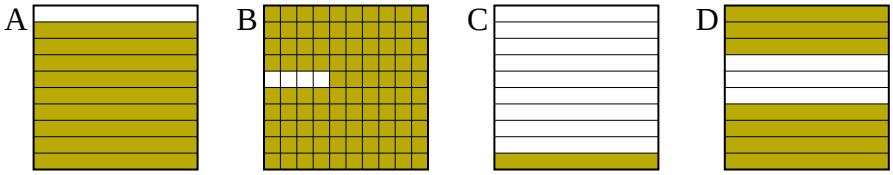

small 0.1 - C
0.7 - D
0.9 - A
large 0.96 - B

7)

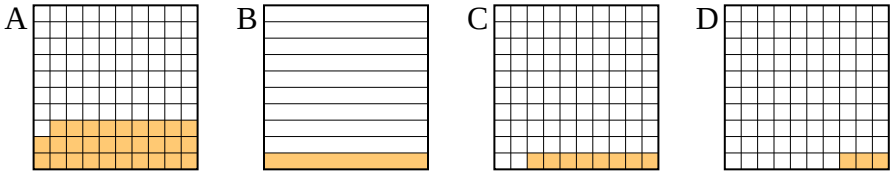

small 0.03 - D
0.08 - C
0.1 - B
large 0.29 - A

8)

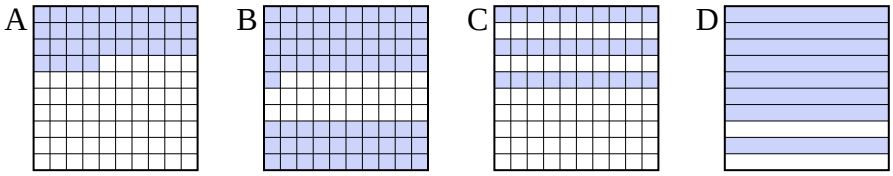

small 0.3 - C
0.34 - A
0.71 - B
large 0.8 - D

Answers

Ex. **B,D,C,A**

1. **A,B,B,C**
2. **D,B,A,C**
3. **D,A,B,C**
4. **D,C,A,B**
5. **C,D,B,A**
6. **C,D,A,B**
7. **D,C,B,A**
8. **C,A,B,D**

1-8	88	75	63	50	38	25	13	0