Counting Groups of Ten

Name:

Determine the quantity of groups of ten. Then find the total number of smaller blocks.

1)

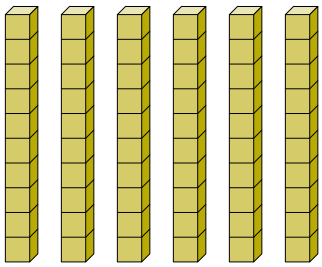

2)

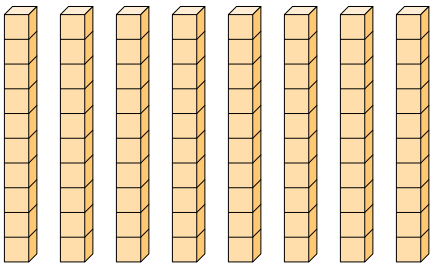

3)

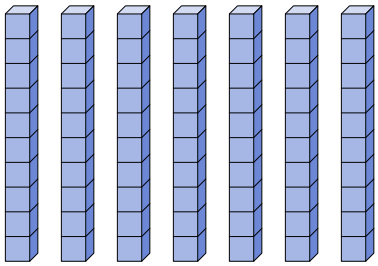

4)



5)

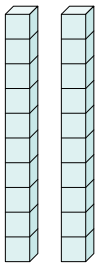

6)

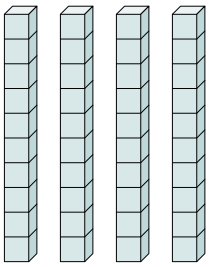

7)

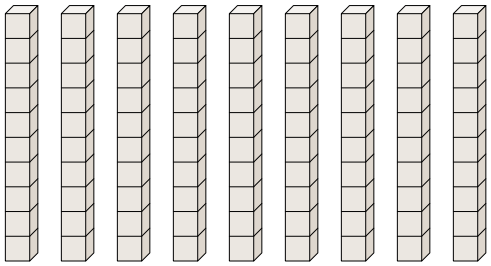

8)

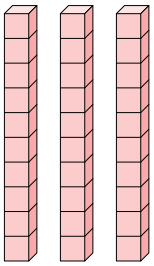

Answers

1. _____ _____
2. _____ _____
3. _____ _____
4. _____ _____
5. _____ _____
6. _____ _____
7. _____ _____
8. _____ _____

1-8	88	75	63	50	38	25	13	0

Counting Groups of Ten

Name: **Answer Key**

Determine the quantity of groups of ten. Then find the total number of smaller blocks.

1)

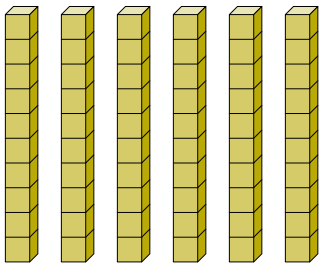

2)

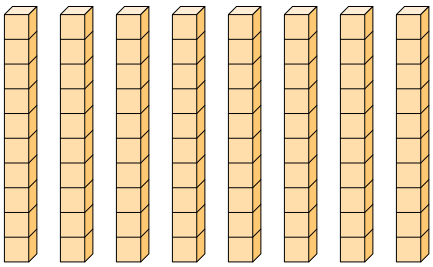

3)

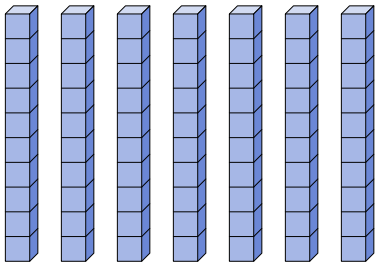

4)



5)

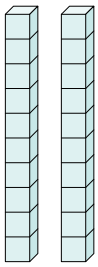

6)

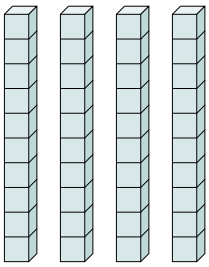

7)

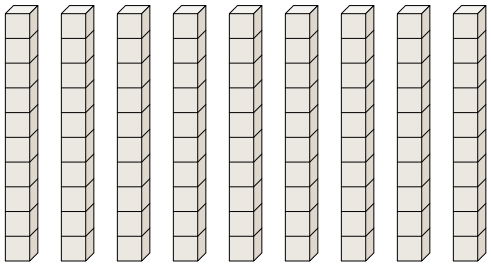

8)

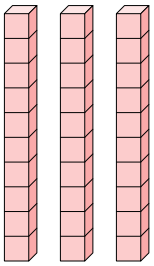

Answers

1.	6	60
2.	8	80
3.	7	70
4.	5	50
5.	2	20
6.	4	40
7.	9	90
8.	3	30

1-8	88	75	63	50	38	25	13	0