Finding Perimeter & Area Name:

Find the perimeter and area of each figure. Each figure is in centimeters (cm). Not to scale.

1) 

2)

3) 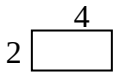

4) 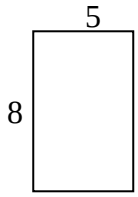

5) 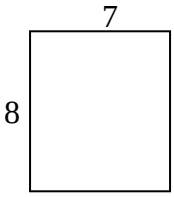

6) 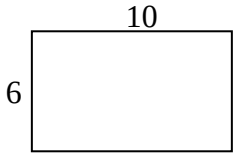

7) 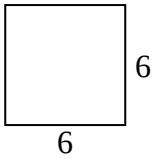

8) 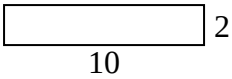

9) 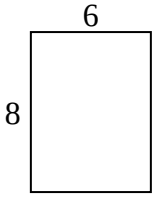

10)

11) 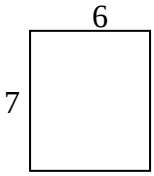

12) 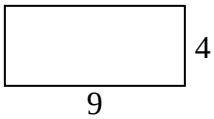

13) 

14) 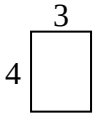

15) 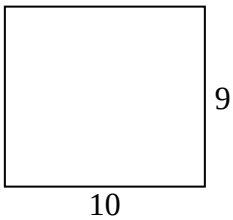

Answers

1. _____ _____
2. _____ _____
3. _____ _____
4. _____ _____
5. _____ _____
6. _____ _____
7. _____ _____
8. _____ _____
9. _____ _____
10. _____ _____
11. _____ _____
12. _____ _____
13. _____ _____
14. _____ _____
15. _____ _____

1-10	93	87	80	73	67	60	53	47	40	33
11-15	27	20	13	7	0					

Finding Perimeter & Area

Name: **Answer Key**

Find the perimeter and area of each figure. Each figure is in centimeters (cm). Not to scale.

1) 

2)

3) 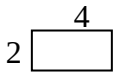

4) 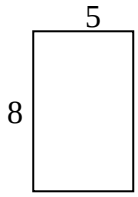

5) 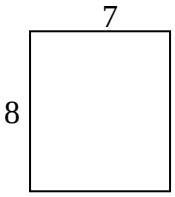

6) 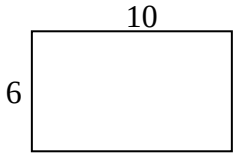

7) 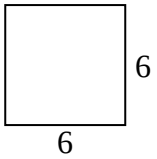

8) 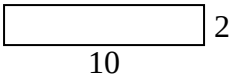

9) 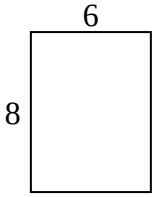

10)

11) 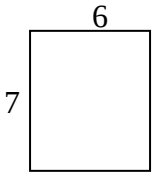

12) 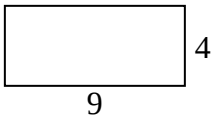

13) 

14) 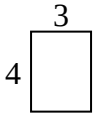

15) 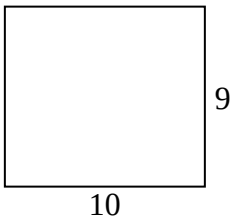

Answers

1.	26	30
2.	22	18
3.	12	8
4.	26	40
5.	30	56
6.	32	60
7.	24	36
8.	24	20
9.	28	48
10.	12	9
11.	26	42
12.	26	36
13.	20	16
14.	14	12
15.	38	90

1-10	93	87	80	73	67	60	53	47	40	33
11-15	27	20	13	7	0					