Finding Area by Tiling

Name:

Find the area (in u) by tiling the rectangles shown. The first is tiled for you.

1)

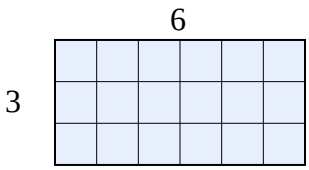

2)

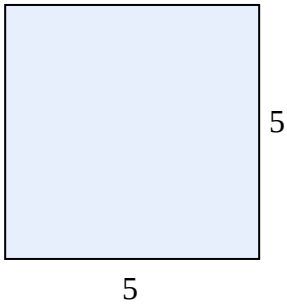

3)

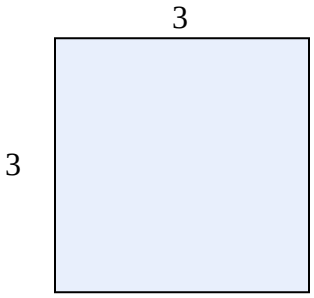

4)

5)

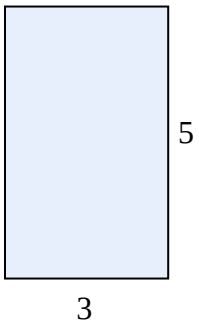

6)



7)



8)

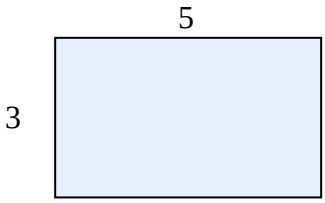

9)

10)

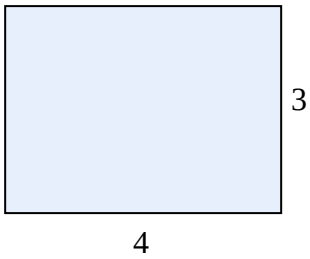

Answers

1. _____
2. _____
3. _____
4. _____
5. _____
6. _____
7. _____
8. _____
9. _____
10. _____

1-10	90	80	70	60	50	40	30	20	10	0

Finding Area by Tiling

Name: **Answer Key**

Find the area (in u) by tiling the rectangles shown. The first is tiled for you.

1)

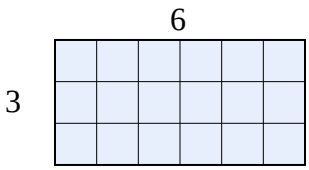

2)

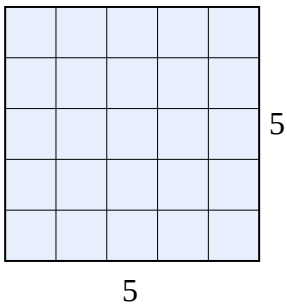

3)

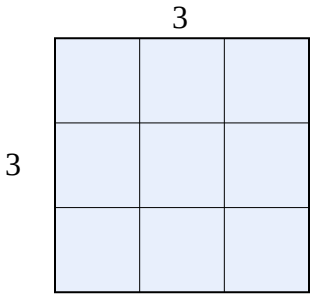

4)

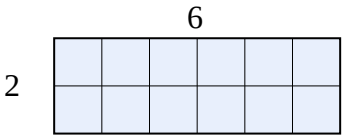

5)

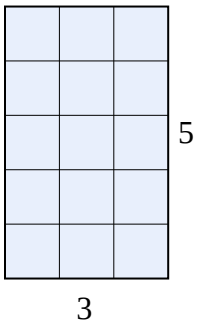

6)

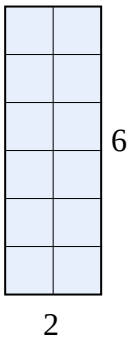

7)

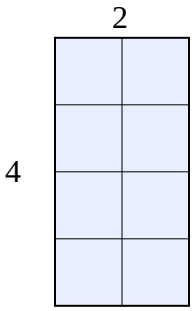

8)

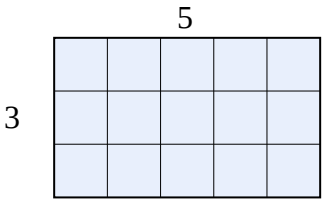

9)

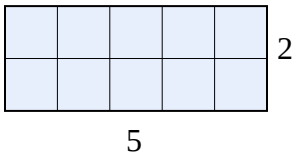

10)

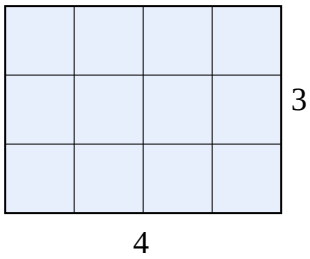

Answers

1. 18
2. 25
3. 9
4. 12
5. 15
6. 12
7. 8
8. 15
9. 10
10. 12

1-10	90	80	70	60	50	40	30	20	10	0