# Finding Area of Triangles

Name:

**Find the area of the triangle. Round your answer to the nearest 10th.**

**1)**

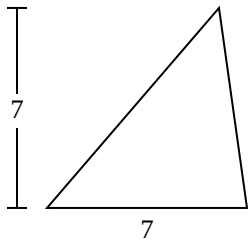


**2)**

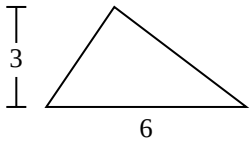


**3)**

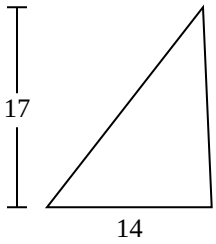


**4)**

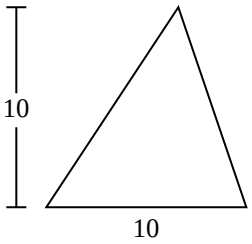


**5)**

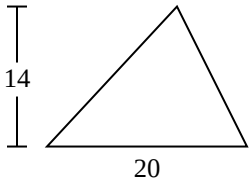


**6)**

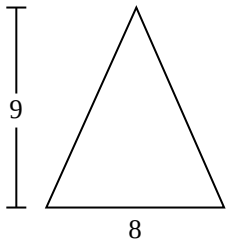


**7)**

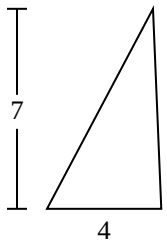


**8)**

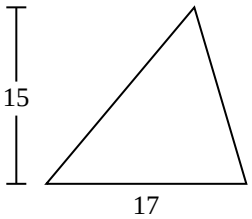


**9)**

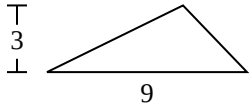


**10)**

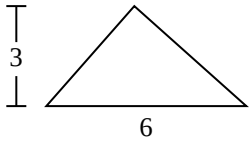


## Answers

1. _____
2. _____
3. _____
4. _____
5. _____
6. _____
7. _____
8. _____
9. _____
10. _____



| 1-10 | 90 | 80 | 70 | 60 | 50 | 40 | 30 | 20 | 10 | 0 |
|---|---|---|---|---|---|---|---|---|---|---|

Finding Area of Triangles

Name: **Answer Key**

**Find the area of the triangle. Round your answer to the nearest 10th.**

**1)**

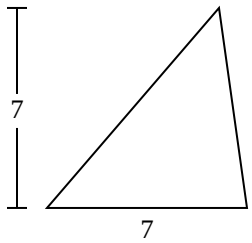


**2)**

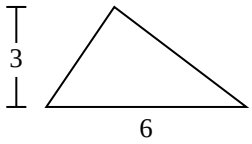


**3)**

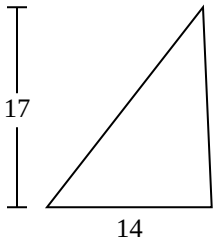


**4)**

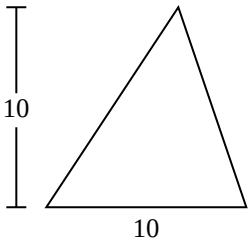


**5)**

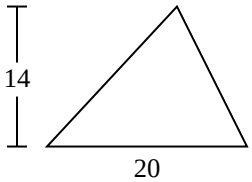


**6)**

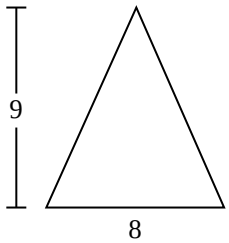


**7)**

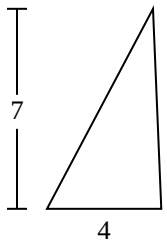


**8)**

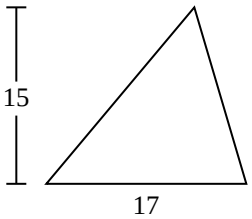


**9)**

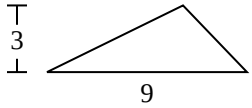


**10)**

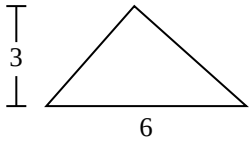


**Answers**

1. **24.5**
2. **9**
3. **119**
4. **50**
5. **140**
6. **36**
7. **14**
8. **127.5**
9. **13.5**
10. **9**



| 1-10 | 90 | 80 | 70 | 60 | 50 | 40 | 30 | 20 | 10 | 0 |
|---|---|---|---|---|---|---|---|---|---|---|

Finding Area of Triangles

Name:

**Find the area of the triangle. Round your answer to the nearest 10th.**

| | | | | |
|---|---|---|---|---|
| 127.5 | 13.5 | 119 | 140 | 14 |
| 24.5 | 9 | 36 | 50 | |

**1)**

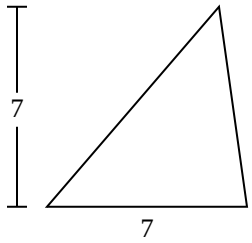


**2)**

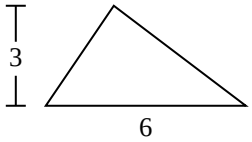


**3)**

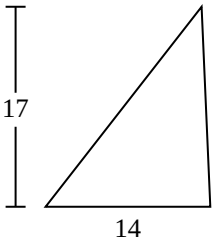


**4)**

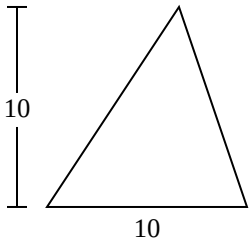


**5)**

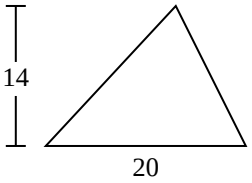


**6)**

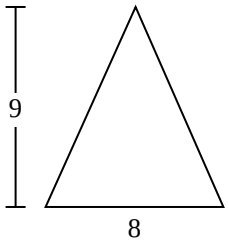


**7)**

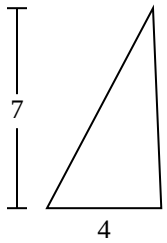


**8)**

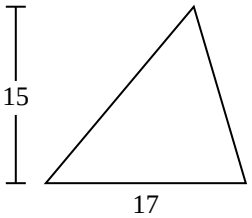


**9)**

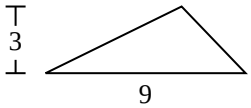


**Answers**

1. _____
2. _____
3. _____
4. _____
5. _____
6. _____
7. _____
8. _____
9. _____



| 1-9 | 89 | 78 | 67 | 56 | 44 | 33 | 22 | 11 | 0 |
|---|---|---|---|---|---|---|---|---|---|