Graduated Cylinders

Name:

Determine how much liquid is in each graduated cylinder.

1)

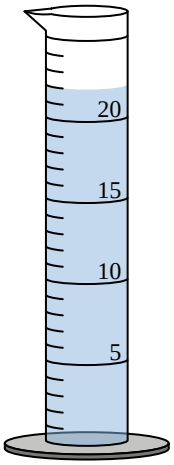

2)

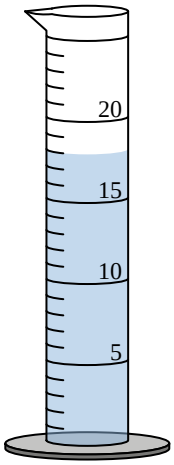

3)

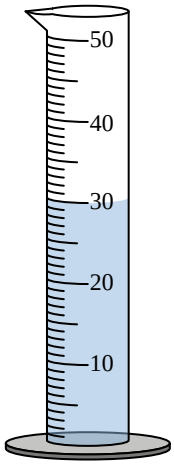

4)

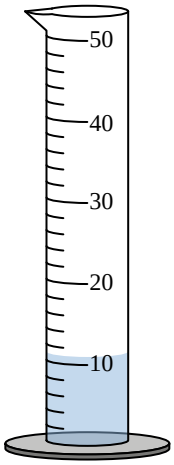

5)

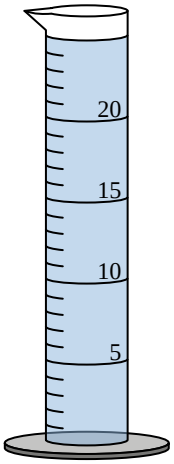

6)

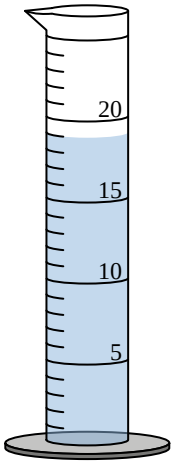

7)

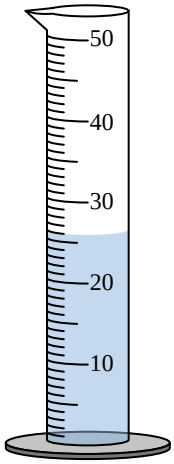

8)

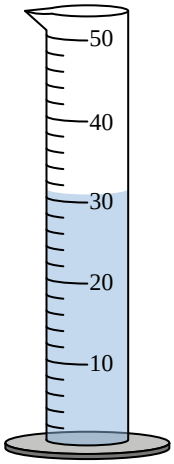

Four different objects were placed in a graduated cylinder 1 at a time:



Empty A B C D

9) Which object had the greatest volume?

10) Which object had the least volume?

Answers

1. _____
2. _____
3. _____
4. _____
5. _____
6. _____
7. _____
8. _____
9. _____
10. _____

1-10	90	80	70	60	50	40	30	20	10	0

Graduated Cylinders

Name: **Answer Key**

Determine how much liquid is in each graduated cylinder.

1)

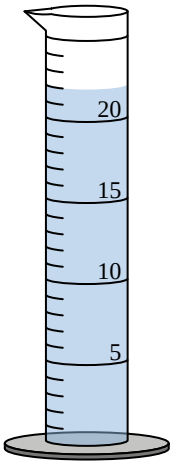

2)

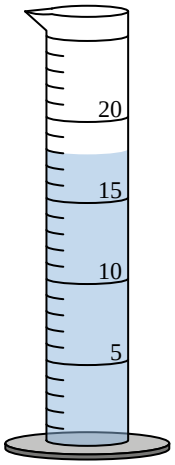

3)

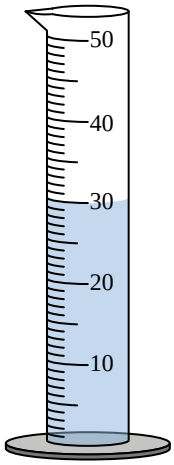

4)

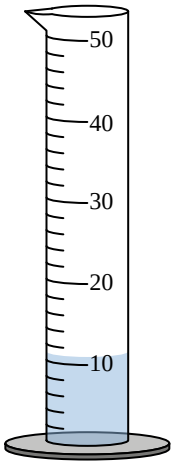

5)

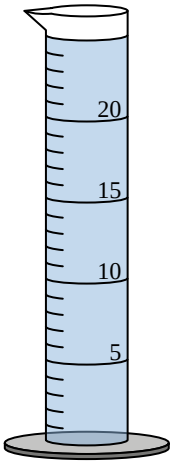

6)

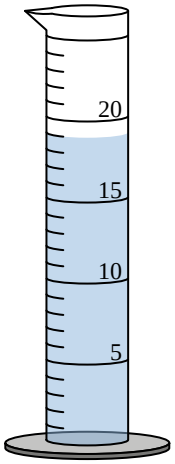

7)

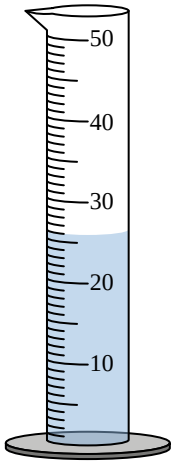

8)

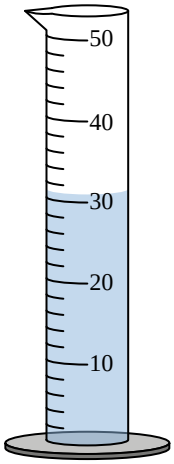

Four different objects were placed in a graduated cylinder 1 at a time:



Empty A B C D

9) Which object had the greatest volume?

10) Which object had the least volume?

Answers

1. 22
2. 18
3. 30
4. 11
5. 25
6. 19
7. 26
8. 31
9. B
10. C

1-10	90	80	70	60	50	40	30	20	10	0