Identifying Volume of a Box

Name:

Determine the volume of each box. Each block is 1 cubic unit (u^3).

1)

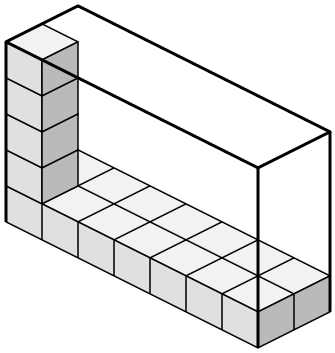

2)

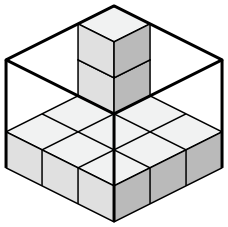

3)

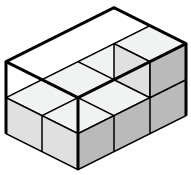

4)

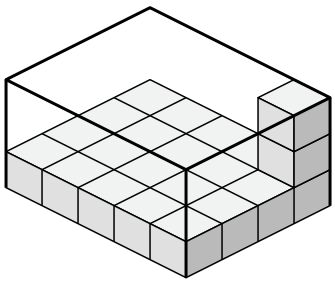

5)

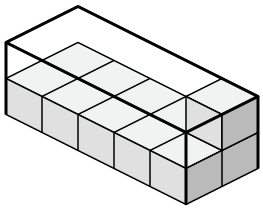

6)

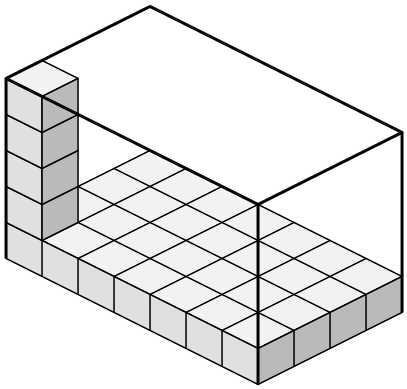

7)

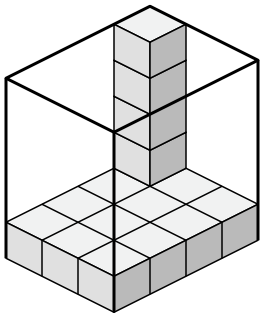

8)

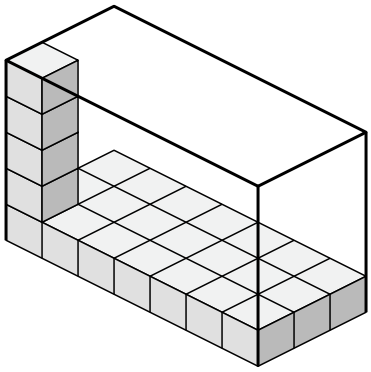

Answers

1. _____
2. _____
3. _____
4. _____
5. _____
6. _____
7. _____
8. _____

1-8	88	75	63	50	38	25	13	0

Identifying Volume of a Box

Name: **Answer Key**

Determine the volume of each box. Each block is 1 cubic unit (u^3).

1)

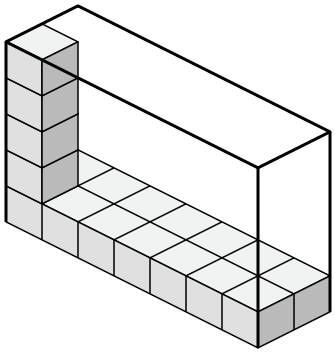

2)

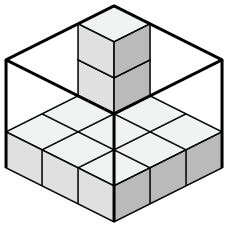

3)

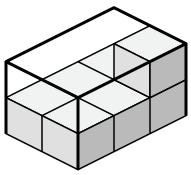

4)

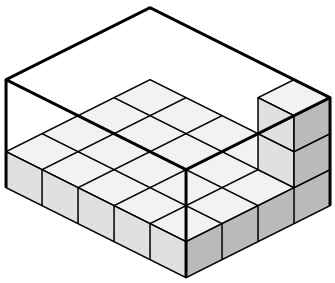

5)

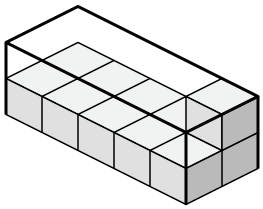

6)

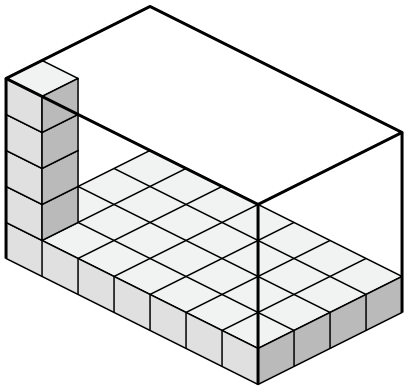

7)

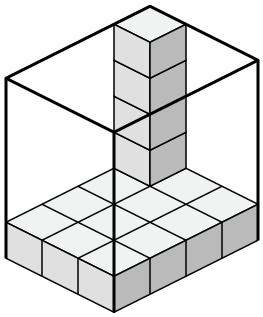

8)

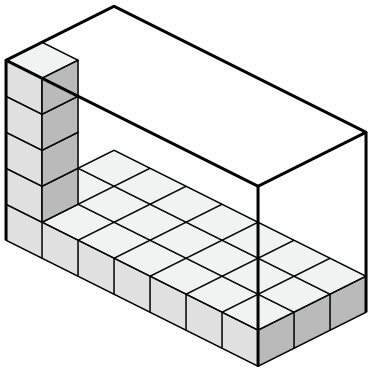

Answers

1. **70 u^3**
2. **27 u^3**
3. **12 u^3**
4. **60 u^3**
5. **20 u^3**
6. **140 u^3**
7. **60 u^3**
8. **105 u^3**

1-8	88	75	63	50	38	25	13	0