Finding Angle between Two Points

Name:

Calculate the angle of the circle relative to (0,0).

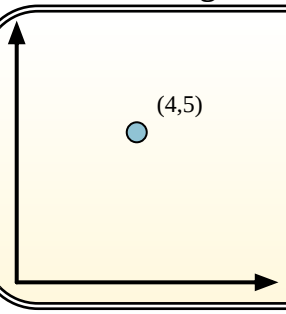

First find the slope.

$(y_2-y_1)\div(x_2-x_1) = m$

$(5-0)\div(4-0) =$ **1.25**

Then find the arc tangent (aka. inverse tangent) of the slope.

arctan(1.25) = **51.34°**

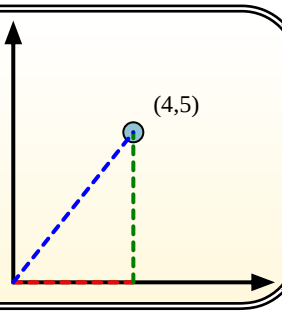

1)

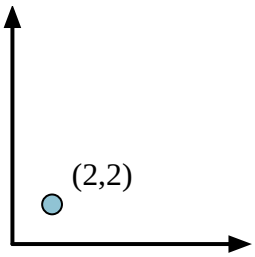

2)

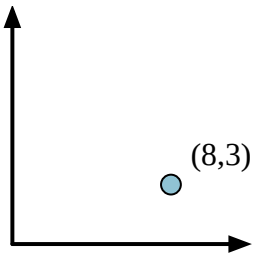

3)

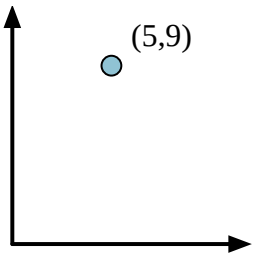

4)

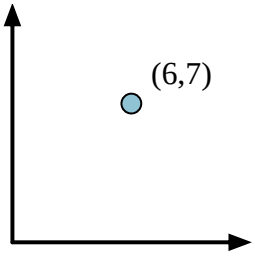

5)

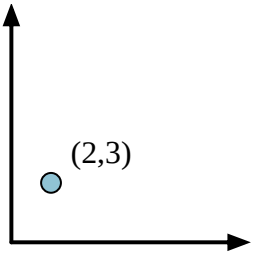

6)

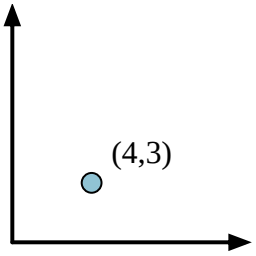

7)

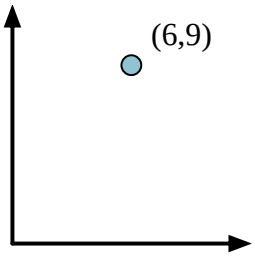

8)

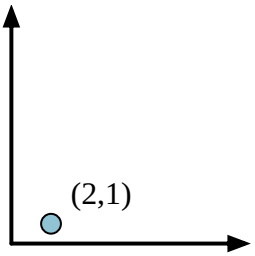

9)

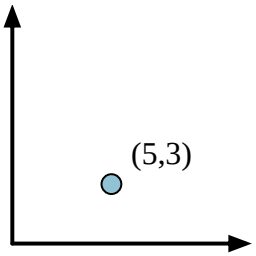

10)

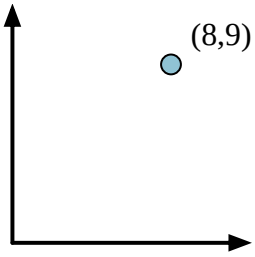

11)

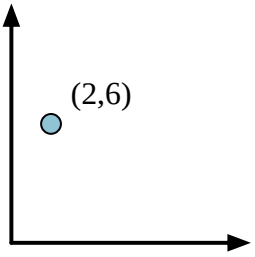

12)

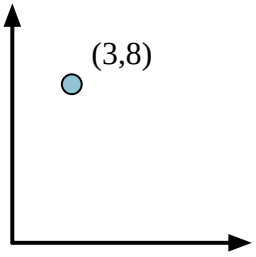

Answers

1. _____
2. _____
3. _____
4. _____
5. _____
6. _____
7. _____
8. _____
9. _____
10. _____
11. _____
12. _____

1-10	92	83	75	67	58	50	42	33	25	17
11-12	8	0								

Finding Angle between Two Points

Name: **Answer Key**

Calculate the angle of the circle relative to (0,0).

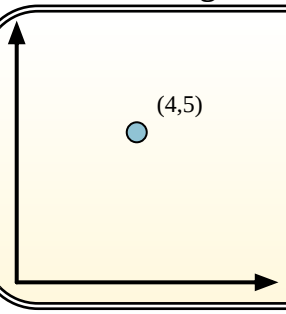

First find the slope.

$(y_2-y_1)\div(x_2-x_1) = m$

$(5-0)\div(4-0) =$ **1.25**

Then find the arc tangent (aka. inverse tangent) of the slope.

arctan(1.25) = **51.34°**

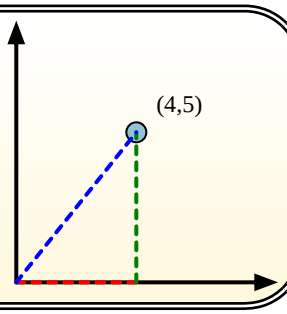

1)

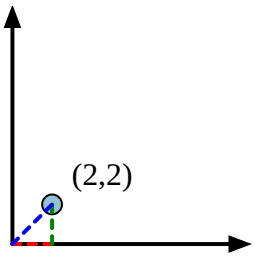

2)

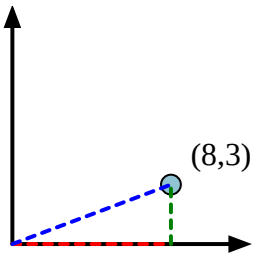

3)

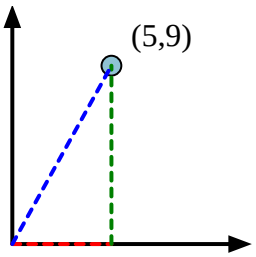

4)

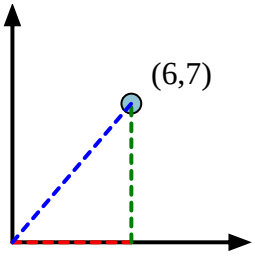

5)

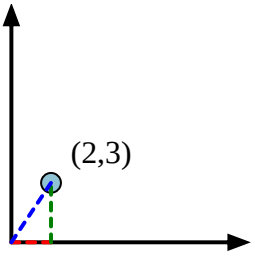

6)

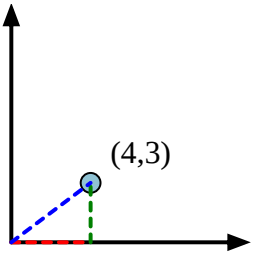

7)

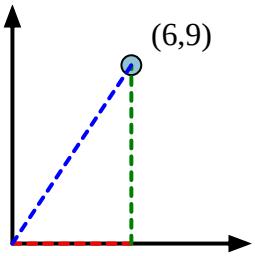

8)

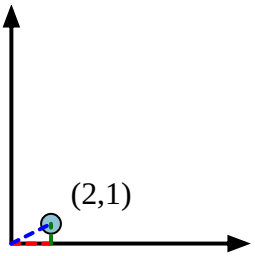

9)

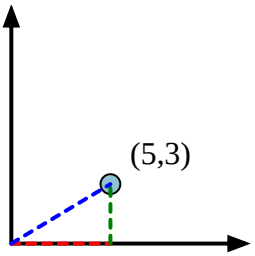

10)

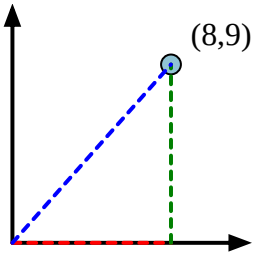

11)

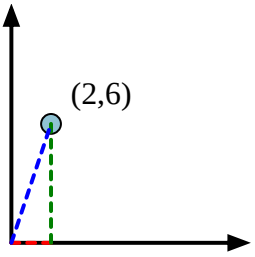

12)

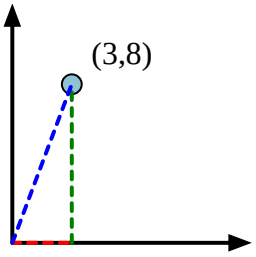

Answers

1. **45.00**
2. **20.56**
3. **60.95**
4. **49.40**
5. **56.31**
6. **36.87**
7. **56.31**
8. **26.57**
9. **30.96**
10. **48.37**
11. **71.57**
12. **69.44**

1-10	92	83	75	67	58	50	42	33	25	17
11-12	8	0								